JAMHURI YA MUUNGANO WA TANZANIA

OFISI YA RAIS

TAWALA ZA MIKOA NA SERIKALI ZA MITAA

HALMASHAURI YA WILAYA YA RUNGWE

MTIHANI WA UTAMILIFU WA WILAYA

DARASA LA VII - APRILI 2026

KISWAHILI

Mficho: 01

Muda: Saa 1:40 **APRILI, 2026**

NAMBA YA MTAHINIWA:_____

JINA LA SHULE:_____

WILAYA:_____**MKOA:**_____

MAELEKEZO KWA MTAHINIWA

1. Karatasi hii ina sehemu **A, B** na **C** zenye maswali **6 (sita)** yenye vipengele 35.
2. Jibu maswali yote kwa usahihi kwenye nafasi ulizopewa.
3. Sehemu A na B zina alama ishirini (20) kila kimoja na sehemu C ina alama kumi (10)
4. Kumbuka kuandika namba yako ya mtihani na jina la shule yako kwa usahihi.
5. Ukigundua kuwa herufi uliyoichagua siyo jibu sahihi, kata mara moja na uandike upya pembeni
6. Tumia biki ya wino wa bluu au nyeusi iliyochongoka katika kujibu maswali.
7. Simu ya mkononi, vikokotozi na vitu visivyoruhusiwa havitakiwi ndani ya chumba cha mtihani.

Karatasi hii ina kurasa 4 zenye maandishi

NAMBA YA MTAHINIWA: _____

1. SIKILIZA HABARI KUTOKA KWA MSIMAMIZI KISHA JIBU SWALI (i) - (v).

(i) Katika habari uliyoisikiliza neno **kando ya** unaweza kulitumiaje kwa lugha nyingine?
(A) Ndani ya (B) Pembeni na (C) Pembeni ya
(D) Ndani na (E) bila ya [ ]

(ii) Hadithi uliyosikiliza mazungumzo yalikuwa kati ya nani na nani?
(A) Bata na mamba (B) Mbuni na kuku (C) Mbuni, bata na mamba
(D) Mamba na mbuni (E) Mbuni na kenge [ ]

(iii) Nani alimsaidia mamba kukuna koo lake?
(A) Mamba (B) Mbuni (C) Mbuni na mamba
(D) Mamba na Mbuni (E) Mamba mwenyewe [ ]

(iv) Hadithi uliyoisikiliza ilihusu nini?
(A) Urafiki wa mamba na mbuni (B) Mbuni (C) Ilihusu kumsaidia mamba
(D) Koo langu (E) Sauti ya mamba [ ]

(v) Kwa nini sauti ya mamba ilikuwa imebadilika na kuanza kukwaruza?
(A) Koo lake ni pana (B) Koo lake ni hatari (C) alitaka kumla mbuni
(D) alikuwa na mdomo mrefu (E) koo lake lilikuwa na vipele [ ]

2. CHAGUA HERUFI YA JIBU SAHIHI

(i) Katika neno **<u>tunalima</u>** mzizi wa neno ni upi?
(A) -lima (B) -lim- (C) lim-
(D) alim- (E) -tuna [ ]

(ii) Shule yetu ina vijana wazuri sana sentensi hii ipo katika nafsi gani?
(A) I-wingi (B) II-wingi (C) III-uwingi
(D) III-wingi (E) I-umoja [ ]

(iii) Mwalimu alitufundisha ngeli ya majina. Je, ni ngeli ipi inahusika na **vitu** kati ya hizi?
(A) A-YA (B) A-WA (C) I-ZI
(D) KI-VI (E) LI-YA [ ]

(iv) Tulipokuwa tunatembea ghafla tukamuona simba kila mtu "**alienda kivyake**".
Nini maana ya maneno kwenda kivyake?
(A) Enda mbago (B) Enda masia (C) Enda mkoseni
(D) Enda pepe (E) Enda mavange [ ]

(v) Ni sehemu gani katika barua huonesha urejeaji wa barua zilizoandikwa?
(A) Anuani ya mwandishi (B) Tarehe (C) Kumbukumbu Namba
(D) Salamu za mwanzo (E) Mwisho wa barua [ ]

(vi) Mtu anayesoma kurani msikitini anajulikana kwa jina gani?
(A) Mpagazi (B) Kuli (C) Tajiwidi
(D) Kondakta (E) Ntingo [ ]

(vii) Katika alama za uandishi ni alama gani huonesha neno lina maelezo zaidi?
(A) Alama ya mstari (B) Ritifa (C) Kinyota
(D) Mabano mawili (E) King'ong'o [ ]

NAMBA YA MTAHINIWA: _____

(viii) Kikembe cha njiwa ni kipura na kikembe cha papa ni kipi kati ya vikembe hivi?
(A) jana (B) nyumba (C) kisui
(D) kidue (E) minengwe [ ]

(ix) Amina alikuwa anakunywa sharubati. Je kisawe cha neno sharubati ni_____?
(A) soda (B) maziwa (C) Togwa
(D) Juisi (E) chai [ ]

(x) "Penda upate upendo". Kitenzi hapo ni _____
(A) upendo (B) penda (C) kitendo
(D) limefumbata (E) utendalo [ ]

3. Oanisha Fungu A na kupata majibu Fungu B

	FUNGU A	**MAJIBU**	**FUNGU B**
(i)	Kaa eda		**A.** Idadi
(ii)	Miamba ya mitishamba		**B.** Rithi mke
(iii)	Badili kauli halisi ya neno NGAPI kuwa kauli taarifa		**C.** Maliza siku za kumlilia mumewe
(iv)	Enda upogo		**D.** Wakati
(v)	Tia kiraka		**E.** Toa siri
			F. Wajuzi wa dawa za kienyeji
			G. Ficha siri
			H. Rithi mume

4. Toa maana mbili kwa kila kisawe

(i) Paa (a) _____,

(b) _____.

(ii) Kaa (a) _____,

(b) _____.

(iii) Paka (a) _____,

(b) _____.

(iv) Panga (a) _____,

(b) _____.

(v) Kanga (a) _____,

(b) _____.

NAMBA YA MTAHINIWA: _____

5. Soma shairi lifuatalo kisha jibu maswali yafuatayo kwa umakini

Hapa kwetu Tanzania, Nyakati zimetumika,
Kuna nyakati za jua, kwa wengi hutamanika,
Nazo nyakati za mvua, kwa viumbe ni baraka,
Anga ni kama pazia, mengi limeyafunika.

Twalipenda sana jua, kuzika ushanafaka,
Afya hutuongezea, mwili kuimarika,
Likiwaka pindukia, ukame huongezeka,
Anga ni kama pazia, mengi limeyafunika.

MASWALI

(i) Unafikiri aliyetunga shairi hili anaitwa nani?
_____

(ii) Kama umejaza swali la kwanza nani amemfundisha mtunzi wa mashairi?
_____

(iii) Kwa nini kituo cha ubeti wa kwanza na wa pili kinafanana?
_____

(iv) Nitajie vina vya kati na mwisho vya ubeti wa pili.
_____

(v) Kila ubeti umeundwa kwa pande mbili. Je, pande hizo ni zipi? Taja kwa utaratibu.
(a) _____

(b) _____

SEHEMU C: UTUNGAJI (ALAMA 10)

6. Wewe ni Tumaini Amani wa S. L. P 20 Kyela, andika simu ya maandishi kwa baba yako Amani Kazamwendo wa S. L. P 30 Chunya kumtaarifu kuwa bibi yako anaumwa amelazwa Muhimbili. AMANI KAZAMWENDO SLP 30 CHUNYA

(i) _____

(ii) _____

(iii) _____

(iv) _____

(v) _____

THE UNITED REPUBLIC OF TANZANIA

PRESIDENT'S OFFICE

REGIONAL ADMINISTRATION AND LOCAL GOVERNMENT

RUNGWE DISTRICT COUNCIL

DISTRICT MOCK EXAMINATION

STANDARD VII - APRIL 2026

ENGLISH LANGUAGE

Code: 02

Time: 1:40 Hours **APRIL, 2026**

CANDIDATE'S NUMBER: _____

SCHOOL NAME:_____

DISTRICT:_____REGION:_____

INSTRUCTIONS

1. This paper consists of sections **A, B** and **C** with a total of **Seven(7) questions of (thity five) 35** items.
2. Answer **all** questions correctly.
3. Section A and B carry **twenty** (20) marks each and Section C carries **ten** (10) marks.
4. Write your examination number in the space provided on the top of each page.
5. If you want to change your answer, you must cut once the original answer then write the new one.
6. Use blue or black ink ball pointed pen to answer all questions.
7. Cellular phones and any unauthorized materials are **not** allowed in the examination room.

This paper consists of 4 printed pages

CANDIDATE'S NUMBER: _____

SECTION A: (20 Marks)

1. Listen carefully to the passage read by the invigilator and answer the questions (i) – (v) by writing the correct letter of the correct answer and write it in the bracket provided after each question number.

(i) Where did Amina go yesterday?
A. To school B. To the shop C. To the market
D. To the hospital E. To the farm [ ]

(ii) Which vegetables did she buy at the market?
A. Carrots, cucumber and onions B. Carrots, spinach and broccoli
C. Tomatoes, cubbages and onions D. Cucumber, cabbages and carrots
E. Pumpkins, carrots and cabbages [ ]

(iii) How far is the market from Amina's home?
A. 3 Centimetres B. 3 Metres C. 3 Milimetres
D. 3 kilometres E. 3 hours [ ]

(iv) At what time did she reach home from the market?
A. 7:30am B. 11:30am C. $^{1}/_{2}$:11am
D. 12:30am E. 5:30am [ ]

(v) Who sent Amina to the market?
A. Her brother B. Her teacher C. Her father
D. Her sister E. Her mother [ ]

2. For the items (i-v), choose the correct answer and write its letter in the box.

(i) If you really love your school, you will always_____ daily.
A. Attending B. Attends C. Attended
D. Be attended E. Attend [ ]

(ii) While I was teaching, my pupils_____.
A. Talked B. Were talking C. Will be talking
D. Have talked E. Are talked [ ]

(iii) The pupils of Kisondela Secondary School usually **water** their school garden before they go to class. Which word class of the underlined belongs to?
A. Verb B. Preposition C. Adjective
D. Nouns E. Pronouns [ ]

(iv) We took our bags to the kitchen, but later we could not remember___we had kept them.
A. Who B. Where C. Why
D. Whom E. Which [ ]

(v) We have an examination tomorrow,_____ we must study hard for it.
A. But B. Or C. For
D. Because E. So [ ]

CANDIDATE'S NUMBER: _____

3. Choose the correct word from the box, then complete the sentences below from (i-v)

Lifestyle,	Bloites,	Whose,	Release,	Did he,	Didn't he

(i) Big is to small as grab is to _____

(ii) David went to Musoma for a study tour. _____?

(iii) I am a word derivered from combination of more than one word _____

(iv) We are chickens which provide our meat to people, so we are called _____

(v) This is the girl_____ bag has been torn by John.

4. Match the expression in LIST A with their corresponding names in LIST B and write the letter of the correct answer in the space provided.

	LIST A	**ANSWER**	**LIST B**
(i)	A person who treats sick people		**A.** Truant
(ii)	A person who does not eat meat		**B.** Classmate
(iii)	A person who does evils to other		**C.** Master of ceremony
(iv)	A person who is in the same class as you		**D.** Orphan
(v)	A person who leads an event		**E.** Vegetarian
			F. Refugee
			G. Wicked
			H. Doctor
			I. Florist

SECTION B: 20 MARKS

5. Fill in the blanks spaces below with correct answer.

(i) The monitor_____the bell late in the afternoon yesterday. (ring)

(ii) Hassan is Neema's brother. Neema's daughter is Hassan's _____

(iii) If it_____we shall go to town by tax. (rain)

(iv) Joan and Megan were_____in the garden when the visitors arrived. (work)

(v) Children drink water. (Write the given sentence into passive voice)

_____

CANDIDATE'S NUMBER: _____

6. Read carefully the passage given below and then answer the questions

Jongo completed his primary education in 1996 at Mkongo Primary School. In 1997 he shifted from Mkongo to Utete town. He established maize selling project around the stand. Many customers came at his place to buy some maizes. His customers usually discuss several issues concerning with his capability of establishing such kind of profitable businesses while eating the maize. The more they argued the more maize they bought.

Questions:

(i) Where did Jongo establish his project?

_____

(ii) When did Jongo complete his primary school?

_____

(iii) Jongo deals with which kind of activities?

_____

(iv) Which kind of things were discussed by customers when they were buying some maizes?

_____

(v) The more they argued _____

SECTION C: 10 MARKS

7. Re-arrange the following jumbled sentences to make a meaningful paragraph by using letter A, B, C, D and E.

(i) He asked me to go to his office to collect our exercise books. [ ]

(ii) I cleaned our classroom as I was on duty. [ ]

(iii) Yesterday, I went to school early in the morning. [ ]

(iv) When I was taking rubbish to the dump, I saw an English language teacher heading towards his office. [ ]

(v) So, I went into his office and collected our exercise books. [ ]

JAMHURI YA MUUNGANO WA TANZANIA

OFISI YA RAIS

TAWALA ZA MIKOA NA SERIKALI ZA MITAA

HALMASHAURI YA WILAYA YA RUNGWE

MTIHANI WA UTAMILIFU WA WILAYA

DARASA LA VII - APRILI 2026

URAIA NA MAADILI

Mficho: 06

Muda: Saa 1:30 **APRILI, 2026**

NAMBA YA MTAHINIWA:_____

JINA LA SHULE:_____

WILAYA:_____**MKOA:**_____

MAELEKEZO KWA MTAHINIWA

1. Karatasi hii ina sehemu **A, B** na **C** zenye maswali **6 (sita)** yenye vipengele 35.
2. Jibu maswali yote kwa usahihi kwenye nafasi ulizopewa.
3. Sehemu A na B zina alama ishirini (20) kila kimoja na sehemu C ina alama kumi (10)
4. Kumbuka kuandika namba yako ya mtihani na jina la shule yako kwa usahihi.
5. Ukigundua kuwa herufi uliyoichagua siyo jibu sahihi, kata mara moja na uandike upya pembeni
6. Tumia biki ya wino wa bluu au nyeusi iliyochongoka katika kujibu maswali.
7. Simu ya mkononi, vikokotozi na vitu visivyoruhusiwa havitakiwi ndani ya chumba cha mtihani.

Karatasi hii ina kurasa 4 zenye maandishi

NAMBA YA MTAHINIWA: _____

SEHEMU "A" ALAMA 20

1. Chagua herufi ya jibu sahihi na andika kwenye mabano uliyopewa.

(i) Mr. Mapunda ni kiongozi wa serikali anayehusika na usajili wa vizazi, vifo na ndoa za kiserikali. Mr. Mapunda ni nani katika serikali ya wilaya?
(A) Katibu tarafa (B) Katibu tawala wa wilaya (C) Mkuu wa wilaya
(D) Mkurugenzi wa halmashauri (E) Afisa elimu wa wilaya [ ]

(ii) Picha ya mnyama anayetumika kama alama ya kificho katika fedha ya noti ya Tanzania huitwa_____
(A) Simba (B) Tembo (C) Twiga
(D) Chui (E) Pundamilia [ ]

(iii) Katiba ni sheria, kanuni na taratibu za nchi zinazotumika kuendesha shughuli za nchi. Katiba ya Jamuhuri ya Muungano wa Tanzania ina sura ngapi?
(A) 10 (B) 6 (C) 2
(D) 20 (E) 5 [ ]

(iv) Wahitaji ni watu waliopungukiwa na mahitaji muhimu kama vile chakula, malazi, fedha, mavazi au afya njema. Lipi kati ya makundi yafuatayo siyo kundi la wahitaji maalumu?
(A) Wazee (B) Watoto (C) Wezi
(D) Walemavu (E) Waathirika wa majanga mbali mbali [ ]

(v) Sheria ya usimamizi wa mazingira Tanzania ilitungwa mwaka gani?
(A) 1992 (B) 2002 (C) 2010
(D) 2015 (E) 2004 [ ]

(vi) Shule zote zina kamati za shule. Katibu katika kamati ya shule anaitwa nani?
(A) Mwalimu wa nidhamu (B) Mwenyekiti wa kamati ya shule [ ]
(C) Mwalimu mkuu (D) Mwalimu wa taaluma (E) Mwalimu wa darasa

(vii) Msaada anaopaswa kupewa mtoto yatima anayenyanyaswa na kuporwa mali za wazazi wake ni ____ (A) Chakula (B) Nguo [ ]
(C) Usafiri (D) Madawa (E) Msaada wa kisheria

(viii) Shule ya msingi Mwenge ilikumbwa na janga la moto. Je ni kifaa gani hakikutumika katika kuzima moto? (A) Gari la kuzima moto (B) Kuni
(C) Mtungi wa kuzima moto (D) Machela (E) Blanketi [ ]

(ix) Jamii inapaswa kuwa na rasilimali muhimu ili kumsaidia mwanafunzi kutekeleza majukumu mbalimbali. Ipi kati ya rasilimali zifuatazo sio muhimu kwa mwanafunzi?
(A) Muziki (B) Muda (C) Ardhi
(D) Fedha (E) Maji [ ]

(x) Kufanya kazi kwa vitendo humsaidia mwanafunzi kutumia milango gani ya fahamu?
(A) Pua na mdomo (B) Milango yote ya fahamu (C) Macho na ngozi
(D) Ulimi na pua (E) Macho na Ulimi [ ]

*NAMBA YA MTAHINIWA:*_____

2. Oanisha vifungu vifuatavyo kwa kuandika herufi za vifungu vya maneno au majibu katika jedwali

SEHEMU A

(i) Mitandao ya kijamii [ ]

(ii) Kosa la mtandao wa mawasiliano [ ]

(iii) Husaidia kazi ya ulinzi na usalama [ ]

(iv) Sheria ya mtandao [ ]

(v) Kuhakikisha usahihi wa taarifa kabla ya kutumia. [ ]

SEHEMU B

A. Elimu ya matumizi ya mitandao

B. Twitter, Instagram, WhatsApp, Youtube

C. Kutumia lugha isiyofaa mitandaoni

D. Matumizi sahihi ya mitandao ya mawasiliano

E. Njia ya kuepuka kufanya makosa ya mitandaoni

F. Kanuni na masharti ya kudhibiti matumizi ya mitandao ya mawasiliano.

3. Chagua jibu sahihi kwenye kisanduku na ujaze jibu sahihi.

PEMBE ZA NDOVU, SHOKA,	MKUKI PAMBA NA KARAFUU, BENDERA YA TAIFA,	JEMBE, MWENGE WA UHURU

(i) Alama katika nembo ya Taifa inayowakilisha wakulima _____

(ii) Alama inayowakilisha mazao ya biashara_____

(iii) Alama inayowakilisha mali ya asili _____

(iv) Alama inayowakilisha ulinzi _____

(v) Alama inayowakilisha wafanyakazi _____

SEHEMU "B" ALAMA 20

4. Panga hatua za utekelezaji wa mipango ili kufikia malengo kuanzia (i) hadi (v) kwa kuandika herufi "A" hadi "E".

(i) Kuchagua mbinu za utekelezaji. [ ]

(ii) Kufanya tathmini. [ ]

(iii) Kuainisha mahitaji. [ ]

(iv) Kuainisha shughuli muhimu za kufanya. [ ]

(v) Kuweka vipaumbele. [ ]

NAMBA YA MTAHINIWA: _____

5. Jibu maswali yafuatayo kwa kujaza nafasi zilizo wazi

(i) Kodi ni michango inayokusanywa na serikali ya Tanzania. Taja faida mbili za ulipaji kodi.
(a) _____
(b) _____

(ii) Taja hadhari mbili za kuchukuwa kabla ya kutokea kwa janga la moto.
(a) _____
(b) _____

(iii) Eleza maana ya maneno yafuatayo
(a) Jinsi _____
_____

(b) Jinsia _____
_____

(iv) Malengo ni dhamira au kusudi la kutekeleza jambo lililopangwa kwa kipindi au muda fulani. Taja aina mbili za malengo
(a) _____
(b) _____

(v) Utandawazi ni janga linaloikumba jamii. Taja njia mbili za kupambana na athari za utandawazi.
(a) _____
(b) _____

SEHEMU C ALAMA 10

6. Soma muundo wa mahakama Tanzania kisha jibu maswali (i) hadi (v)

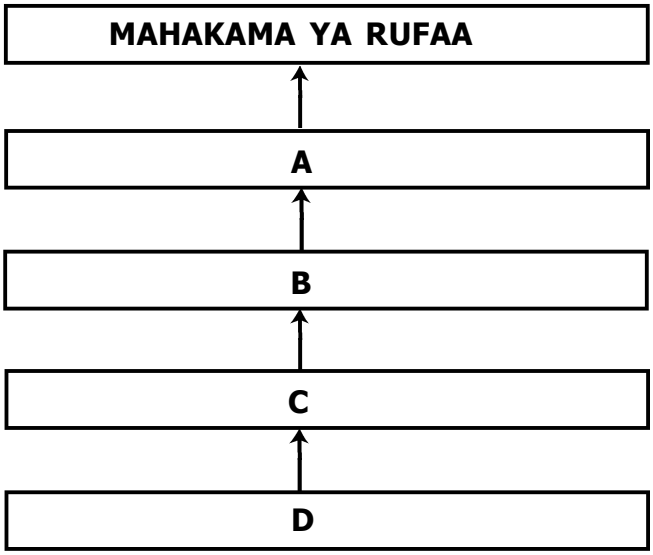

(i) Mahakama ya Rufaa inaongozwa na nani? _____

(ii) Mahakama ya mwanzo imeoneshwa na herufi gani? _____

(iii) Mahakama inayosikiliza kesi za jinai na mauaji imeoneshwa kwa herufi gani?
_____

(iv) Herufi "B" inawakilisha mahakama gani? _____

(v) Mahakama gani huoneshwa na herufi "C"? _____

JAMHURI YA MUUNGANO WA TANZANIA
OFISI YA RAIS
TAWALA ZA MIKOA NA SERIKALI ZA MITAA
HALMASHAURI YA WILAYA YA RUNGWE
MTIHANI WA UTAMILIFU WA WILAYA
DARASA LA VII - APRILI 2026
MAARIFA YA JAMII NA STADI ZA KAZI
Mficho: 03
Muda: Saa 1:30 **APRILI, 2026**

NAMBA YA MTAHINIWA:_____

JINA LA SHULE:_____

WILAYA:_____**MKOA:**_____

MAELEKEZO KWA MTAHINIWA

1. Karatasi hii ina sehemu **A, B** na **C** zenye maswali **7 (saba)** yenye vipengele 35.
2. Jibu maswali yote kwa usahihi kwenye nafasi ulizopewa.
3. Sehemu A na B zina alama ishirini (20) kila kimoja na sehemu C ina alama kumi (10)
4. Kumbuka kuandika namba yako ya mtihani na jina la shule yako kwa usahihi.
5. Ukigundua kuwa herufi uliyoichagua siyo jibu sahihi, kata mara moja na uandike upya pembeni
6. Tumia biki ya wino wa bluu au nyeusi iliyochongoka katika kujibu maswali.
7. Simu ya mkononi, vikokotozi na vitu visivyoruhusiwa havitakiwi ndani ya chumba cha mtihani.

Karatasi hii ina kurasa 4 zenye maandishi

NAMBA YA MTAHINIWA: _____

SEHEMU A (MAKSI 20) Jibu maswali yote

1. Kwa kila swali (i-x), Chagua herufi ya jibu sahihi kisha andika jibu sahihi kwenye kisanduku ulichopewa.

(i) Ongezeko la joto duniani limepelekea mabadiliko ya tabia ya nchi. Nini sababu kuu ya ongezeko la joto?
A. Utoaji wa gesi ya kaboni B. Kufa kwa viumbe hai C. Uharibifu wa nguvu kazi
D. Kuharibu afya E. Uchafuzi wa maji [ ]

(ii) Seti ya mambo yafuatayo husababisha kutokea kwa mlipuko wa volkano,
A. Mgandamizo, joto na lava B. Nguvu ya msukumo na mgandamizo wa hewa
C. Nguvu ya msukumo, lava na hewa
D. Nyufa, mgandamizo na magma E. Joto, lava na nyufa [ ]

(iii) Wanafunzi wa darasa la saba walipanga kutembelea sehemu yenye mabaki yenye fuvu la kale la binadamu, sehemu hiyo huitwa_____.
A. Isimila (Irangi) B. Olduvai Gorge (Arusha) C. Kaole (Pwani)
D. Kondoa Irangi (Dodoma) E. Engaruka (Arusha) [ ]

(iv) Wanafunzi wa darasa la tatu walijifunza vipengele vya hali ya hewa, na vifaa vinavyotumika kupimia. Kipi kati ya kifaa kifuatacho hutumika kupimia mvua.
A. Haigrometa B. Barometa C. Oktasi
D. Anemometa E. Kipima mvua [ ]

(v) Binadamu aligundua moto kwa kupekecha vijiti viwili vikavu vilivyoitwa_____
A. Mtiki na uwimbombo B. Ulindi na unazi C. Ulimbombo na ulindi
D. Mwanzi na Ulindi E. Mpera na Uwimbombo [ ]

(vi) Msomaji wa ramani lazima ajue alama zinazotumika katika ramani.Alama hii inamaanisha nini katika ramani?
A. Reli
B. Mto C. Daraja
D. Maporomoko ya maji E. Barabara [ ]

(vii) Mavazi yafuatayo ni mavazi ya kigeni, isipokuwa _____
A. Shati na suruali B. Kanzu na suruali C. Gauni na sketi
D. Suti na suti E. Lubega na Mgolole [ ]

(viii) Lau alitaka kuandaa chakula, ni aina gani ya chakula itaandaliwa na Lau kwa njia ya kuchemshwa na kukaangwa
A. Chipsi B. Uji C. Mkate
D. Mayai E. Keki [ ]

(ix) Amani aliulizwa na dada yake Amina kuhusu sayari kubwa kuliko zote katika mfumo wa jua. Je Amani alitaja jibu gani?
A. Sumbula B. Zohari C. Dunia
D. Zebaki E. Venasi

(x) Tanzania ina rasilimali nyingi zenye thamani ambazo huchangia ukuaji wa uchumi wake. Je ni madini gani hutumika kuongezea radha katika chakula?
A. Dhahabu B. Almasi C. shaba
D. Tanzanite E. Chumvi [ ]

NAMBA YA MTAHINIWA: _____

(xi) baada ya Mkutano wa Berlin, Mwingereza na Mjerumani walisaini mikataba miwili kugawana Afrika Mashariki. Ni jina gani la Mkataba uliosainiwa mwaka 1890 kati ya mataifa hayo ya kibepari?
A. Mkataba wa Moresya B. Mkataba wa Haratton C. Mkataba wa Frere
D. Mkataba wa Versailles E. Mkataba wa Helgoland [ ]

(xii) Babu yangu amezaliwa mwaka ambao Tanganyika imepata uhuru. Ni mwaka gani Tanganyika ilipata uhuru? A. 1985 B. 1964
C. 1962 D. 1999 E. 1961 [ ]

(xiii) Njema anaeanzisha na kuendeleza biashara ili kupata faida. Njema ni nani?
A. Mnunuzi B. Muuzaji C. Mjasiriamali
D. Mteja E. Mchumi [ ]

(xiv) Ni upi kati ya ufuatao ni mfumo wa kwanza wa unyonyaji ambao binadamu wa kwanza wa unyonyaji ambao binadamu wa kwanza alipitia?
A. Utumwa B. Nyarubanja C. Ubepari
D. Ujima E. Ukabaila [ ]

(xv) Ni Rais yupi kati ya wafuatao aliongoza akiwa na mawaziri wakuu wawili kwa nyakati tofauti?
A. Ali Hassan Mwinyi B. Jakaya Mrisho Kikwete C. Mwalimu J.K Nyerere
D. Benjamini Mkapa E. Dr. John Pombe Magufuli [ ]

2. Oanisha kipengele A na B kisha chagua herufi ya jibu sahihi na uandike kwenye kisanduku ulichopewa.

	TUKIO	**MAJIBU**		**MWAKA**
(i)	Vita vya Maji maji		**A.**	1995
(ii)	Mapinduzi ya Zanzibar		**B.**	1986
(iii)	Mfumo wa soko la huria		**C.**	1964
(iv)	Mfumo wa vyama vingi		**D.**	1995
(v)	Uchaguzi wa kwanza wa vyama vingi Tanzania		**E.**	1992
			F.	1961
			G.	1905-1907

SEHEMU B: (ALAMA 20)

3. JIBU MASWALI YOTE KATIKA SEHEMU HII

(i) Eleza shughuli mbili (2) za binadamu ambazo huchangia ongezeko la joto duniani
(a) _____
(b) _____

(ii) Eleza faida za ugunduzi wa moto mwishoni mwa zama za kati
(a) _____
(b) _____

(iii) Orodhesha kwa kifupi faida mbili za kufahamu kanda za tabia nchi ya Tanzania
(a) _____
(b) _____

NAMBA YA MTAHINIWA: _____

4(i) Songambele alimwambia rafiki yake majanga yanayosababishwa na nguvu za asili na vitendo vya mwanadamu. Ni majanga gani unafikiri yalitajwa na Songambele?
(a) _____
(b) _____

(ii) Wanafunzi wa darasa la saba wamejifunza mila na desturi mbalimbali, zisizofaa. Taja mila na desturi zisizofaa katika jamii yako.
(a) _____
(b) _____

(iii) Ni changamoto gani ambazo walipitia wapigania uhuru wa Afrika wakati wa kupigania uhuru wa nchi zao. (Taja mbili)
(a) _____
(b) _____

5(i) Orodhesha makubaliano mawili (2) ya mkutano wa Berlin
(a) _____
(b) _____

(ii) Taja matokea ya uhusiano katika ya jamii ya Tanzania na Ulaya
(a) _____
(b) _____

6(i) Kutokana na sera ya kuendeleza biashara ndogo na za kati Tanzania ya mwaka 2003, Ujasiliamali biashara umegawanyika katika makundi manne. Ni kigezo kipi kimetumika kugawa hayo mkaundi ya ujasiliamali biashara?
(a) _____
(b) _____

(ii) Taja matokea ya kupwa na kujaa kwa maji
(a) _____
(b) _____

SEHEMU C: (ALAMA 10)

7. Chunguza kwa makini jedwali lifuatalo kisha jibu swali (i) – (iii)

SIKU	JT	JN	JT	ALH	IJ	JM	JP
JOTORIDI(^{o}C)	30	22	20	18	15	20	15

MASWALI

(i) Tafuta wastani wa jotoridi _____

(ii) Hali ya hewa katika jedwali hapo juu hupimwa kwa kutumia kipimo kinachoitwa _____

(iii) Siku gani inajotoridi kubwa? _____

(iv) Umbali wa kwenye ramani kutoka sehemu A na B ni sentimita 60. Tafuta umbali halisi kama kipimo cha ramani kilichotumika ni 1:50,000

(v) Kama ni saa 6:08 asubuhi katika mji A uliopo katika longitude 15^{0} Magharibi. Itakuwa saa ngapi mji B uliopo longitudo 60 Mashariki

JAMHURI YA MUUNGANO WA TANZANIA

OFISI YA RAIS

TAWALA ZA MIKOA NA SERIKALI ZA MITAA



HALMASHAURI YA WILAYA YA RUNGWE



MTIHANI WA UTAMILIFU WA WILAYA

DARASA LA VII - APRILI 2026

SAYANSI NA TEKNOLOJIA

Mficho: 05

Muda: Saa 1:30 **APRILI, 2026**

NAMBA YA MTAHINIWA:_____

JINA LA SHULE:_____

WILAYA:_____**MKOA:**_____

MAELEKEZO KWA MTAHINIWA

1. Karatasi hii ina sehemu **A, B** na **C** zenye maswali **8 (nane)** yenye vipengele 35.
2. Jibu maswali yote kwa usahihi kwenye nafasi ulizopewa.
3. Sehemu A na B zina alama ishirini (20) kila kimoja na sehemu C ina alama kumi (10)
4. Kumbuka kuandika namba yako ya mtihani na jina la shule yako kwa usahihi.
5. Ukigundua kuwa herufi uliyoichagua siyo jibu sahihi, kata mara moja na uandike upya pembeni
6. Tumia biki ya wino wa bluu au nyeusi iliyochongoka katika kujibu maswali.
7. Simu ya mkononi, vikokotozi na vitu visivyoruhusiwa havitakiwi ndani ya chumba cha mtihani.

Karatasi hii ina kurasa 4 zenye maandishi

NAMBA YA MTAHINIWA: _____

SEHEMU A: (ALAMA 20)

1. Chagua herufi ya jibu sahihi kisha jaza kwenye kisanduku ulichopewa.

(i) Daktari alimshauri Msafiri kula vyakula vya vitamini kwa wingi. Je, ni jozi ipi inawakilisha vyakula hivyo___

(A) Maharage na samaki (B) Mchele na viazi (C) Siagi na korosho
(D) Miwa na ngano (E) Matunda na mboga za majani [ ]

(ii) Mwili wa mtu mwenye kisukari hushindwa kuzalisha insulini. Ni kiungo kipi cha mtu huyo huwa na tatizo _____ (A) Kongosho (B) Ubongo
(C) Figo (D) Mfuko wa nyongo (E) Ini [ ]

(iii) Bwana Manyama anataka kununua antenna yenye uwezo wa kupokea mawimbi ya sumaku ya redio na televisheni. Aina gani ya antenna utamshauri anunue?

(A) Kitanzi (B) Yagi-uda (C) Honi
(D) Kidoa (E) Waya [ ]

(iv) Wataalamu wa Afya huwahimiza wazazi wapeleke watoto wao kliniki kwa ajili ya kupatiwa chanjo. Je, ni ugonjwa gani kati ya magonjwa yafuatayo huweza kuzuiwa kwa chanjo?

(A) Kifaduro (B) Kisonono (C) Malaria
(D) Kipindupindu (E) Homa ya matumbo [ ]

(v) Kijana mwenye nguvu na afya alisukuma ukuta kwa muda wa dakika kumi na ukuta huo haukudondoka. Kwa nini kijana huyo anaonekana hajafanya kazi?

(A) Alisukuma ukuta ambao haukusogea umbali wowote.
(B) Alitumia nguvu kidogo katika kusukuma ukuta huo
(C) Hakufuata mbinu za kisayansi katika kusukuma ukuta huo
(D) Hakujua uzito wa ukuta aliokuwa anausukuma
(E) Alitumia muda kidogo sana katika kusukuma ukuta [ ]

(vi) Kijiji cha Mirwa kilikumbwa na balaa la njaa kutokana na uvamizi wa vipepeo. Je, kipepeo hao walikuwa katika hatua ipi ya ukuaji?

(A) Buu (B) Kipepeo (C) Yai
(D) Kiwavi (E) Tunutu [ ]

(vii) Umeambiwa ufunge program jedwali. Je, hatua zipi utafuata?

(A) Bofya menu ya start ⟶ Microsoft office ⟶ Program jedwali
(B) Bofya menu ya start ⟶ Program andishi ⟶ Program jedwali
(C) Bofya menu ya start ⟶ Program jedwali ⟶ Microsoft office
(D) Bofya menu ya start ⟶ Program jedwali ⟶ Microsoft word
(E) Bofya menu ya start ⟶ Microsoft office ⟶ Microsoft word[ ]

(viii) Mwalimu wa sayansi aliweka rula kwenye glasi ya maji kisha rula hiyo ikaonekana imepinda. Je, kitendo hiki kinaonesha tabia ipi ya mwanga?

(A) Kuakisiwa kwa mwanga (B) Kupinda kwa miale ya mwanga [ ]
(C) Kung'aa (D) Kutawanyika (E) Mnunuriko

(ix) Ni kwa nini mgonjwa mwenye virusi vya ukimwi hushambuliwa na magonjwa mengi kwa wakati mmoja? (A) Magonjwa mengi huja mara kwa mara
(B) Hakuna wataalamu wa kuponyesha wagonjwa
(C) Maana ya ukimwi ni magonjwa mengi
(D) Mgonjwa hana uwezo wa kwenda hospitali
(E) Kinga ya mwili hushindwa kupambana na magonjwa [ ]

(x) Ili kuzima moto katika kitu kinachowaka, inashauriwa kufunika kwa nguo nzito kama blanketi. Nini lengo la kufanya hivo?

(A) Kuondoa gesi ya oksejini (B) Kuondoa gesi ya kandayoksaidi

(C) Kuongeza ggesi ya kabonimonoksaidi (D) Kuondoa gesi ya naitrojeni

(E) Kupunguza nguvu ya moto [ ]

2. Oanisha maneno kutoka sehemu A na maelezo kutoka sehemu B kwa kuandika herufi ya jibu sahihi kwenye sehemu ya majibu.

	SEHEMU A	**MAJIBU**		**SEHEMU B**
(i)	Sepali		**A.**	Kutunza ovuli
(ii)	Petali		**B.**	Husaidi kunasa chavua
(iii)	Ovari		**C.**	Kulinda ua change kabla ya kuchanua
(iv)	Stigima		**D.**	Sehemu ya kiume ya ua
(v)	Stameni		**E.**	Jani la ua lenye rangi nzuri la kuvutia
			F.	Kupitisha chavua kutoka kwenye stigima kwenda kwenye ovari

3. Chagua jibu sahihi kutoka kwenye jedwali, kisha uandike kwenye nafasi iliyoachwa wazi

Virusi vya UKIMWI,	**ARV,**	**Kipindupindu,**	**Malaria,**	**Malale,**
Anemia selimundu,	**Hemofilia,**		**Kuhara**	

(i) Hali ya mwili kushindwa kugandisha damu baada ya kuumia huitwa _____

(ii) Ugonjwa unaoenezwa na mbung'o _____

(iii) Hali ambayo seli nyekundu za damu hubadilika umbile lake la kawaida na kuwa kama mundu _____

(iv) Dawa zinazotumiwa kupunguza makali ya virusi vya UKIMWI _____

(v) Kuharisha sana majimaji kama maji ya mchele _____

SEHEMU B. (Alama 20)

Jibu maswali yote katika sehemu hii

4(i) Gesi inayotumika kuhifadhi vinywaji kama vile soda na juisi huitwa _____

(ii) Mimea huwa inajitengenezea chakula chake, ni gesi ipi huzalishwa wakati wa kitendo cha usanishaji wa chakula kwa mmea? _____

(iii) Kwa nini nishati jadidifu huitwa nishati endelevu? _____

_____

NAMBA YA MTAHINIWA: _____

5(i) Nyongo ni dutu ya kemikali ambayo huwa na tabia kama vile kuteleza na ladha ya uchungu. Orodhesha vitu viwili kwenye nyongo.
(a) _____ (b) _____

(ii) Kuna aina mbalimbali za madaraja ya moto. Taja aina ya daraja la moto katika maswali yafuatayo.
(a) Moto ambao hutokana na vimiminika vinavyolipuka na kuwaka.
_____

(b) Moto ambao hutokana na mafuta ya kupikia.
_____

(iii) Elezea ni kwa nini haishauriwi kuzima moto unaosababishwa na vimiminika vinavyolipuka na kuwaka kwa kutumia maji?
_____

6. Antena ni kifaa ambacho hunasa na kusambaza mawimbi sumaku umeme kwenye vifaa vya mawasiliano. Taja aina ya antena katika swali kipengele (i) na (ii)

(i) Antena yenye uwezo wa kujikinga na kelele kwa ufanisi _____

(ii) Ufanisi wake hutegemea na idadi kubwa ya antena zilizounganishwa _____

(iii) Elezea ni kwa nini aluminiumu hutumika zaidi katika kutengeneza antena kuliko shaba?
_____

(iv) Ni aina gani ya kifaa inafaa kutengeneza antena kwa sababu ina uwezo wa kupitisha umeme kwa urahisi zaidi? _____

SEHEMU C: JIBU MASWALI YOTE (ALAMA 10)

7(i) Kusharabiwa kwa chakula hutokea eneo gani kwenye mfumo wa mmeng'enyo wa chakula? _____

(ii) Densite ya ubao ni 20kg/m^3. Ikiwa ujazo wa ubao huo ni 90m^3. Tafuta tungamo.
_____
_____
_____

(iii) Miongoni mwa malighafi za mmea kujitengenezea chakula ni mwanga wa jua na umbijani. Taja malighafi nyingine mbili
(a) _____ (b) _____

8. Soma sakiti rahisi ya umeme hapa chini kisha jibu maswali

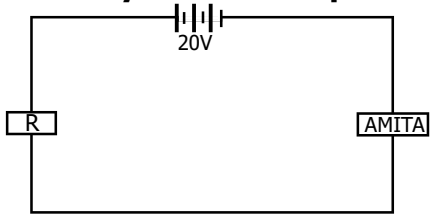

(i) Ikiwa mkondo wa umeme ni Ampia 5. Tafuta ukinzani
_____
_____

(ii) Nini kitatokea kwenye volteji iwapo umeme utaongezeka? _____
_____

THE UNITED REPUBLIC OF TANZANIA

PRESIDENT'S OFFICE

REGIONAL ADMINISTRATION AND LOCAL GOVERNMENT

RUNGWE DISTRICT COUNCIL

DISTRICT MOCK EXAMINATION

STANDARD VII - APRIL 2026

SOCIAL STUDIES AND VOCATIONAL STUDIES

Code: 03E

Time: 1:30 Hours **APRIL, 2026**

CANDIDATE'S NAME:_____

CANDIDATE'S NUMBER: _____

SCHOOL NAME:_____

DISTRICT:_____**REGION:**_____

INSTRUCTIONS

1. This paper consists of sections **A, B** and **C** with a total of **Seven(7) questions of (Thity five items) 35** questions.
2. Answer **all** questions.
3. Read all the instructions in the in every question you have given.
4. Write your **Examination Number** in the respective places.
5. Use a pen of blue or black ink to answer all questions.
6. Cellular phones and any unauthorized materials are **not** allowed in the examination room.

This paper consists of 4 printed pages

CANDIDATE'S NUMBER: _____

SECTION A (20 MARKS)

1. Answer item (i-v) by choosing the letter of the correct answer and write it in the box provided.

(i) Global warming is the rise in the average temperature of the earth's climatic systems. What is the main cause of global warming?
A. Too much emission gases such as carbon dioxide B. Loss of biodiversity
C. Destruction of man power D. Destroy people's health
E. Water pollution [ ]

(ii) The following are factors that cause the volcanic eruption:
A. Pressure, heat and lava B. Pressure, lava and air C. Air pressure, lava and air
D. Lava, cracks and fissures E. Heat, lava and fissures [ ]

(iii) Standard seven pupils have a plan to visit a place where the oldest human skill was discovered, that place is _____
A. Isimila B. Olduvai-Gorge (Arusha) C. Kaole (Pwani)
D. Kondoa-Irangi (Dodoma) E. Engaruka (Arusha) [ ]

(iv) The standard three pupils were taught that the elements of weather are measured by using special instruments. What instrument among the following is used to measure falling of rain water droplets from the atmosphere?
A. Hygrometer B. Barometer C. Oktas
D. Anemometer E. Rain gauge [ ]

(v) Early human discovered fire by skewering a dry piece of stick on a dry wood, the two tools were known as_____
A. Mitiki and uwimbombo B. Ulindi and bamboo tree C. Uwimbombo and ulindi
D. Bamboo tree and Mtiki E. Mpere and Uwimbombo [ ]

(vi) Map read should know the meanings of the symbols and sings included in the map. What does the symbol shown below represent on a map?
A. Railway B. River
C. Bridge D. Road E. Water falls [ ]

(vii) The following are foreign dressing in our country **EXCEPT**_____
A. Shirt and trouser B. Kanzu and trouser C. Dress and shirt
D. Suit and kanzu E. Lubega and Mgolole [ ]

(viii) Lau wants to prepare food. Which type of food can be prepared by Lau using both boiling and frying cooking method?
A. Chips B. Porridge C. Bread
D. Eggs E. Cake [ ]

(ix) Amani was asked by his young sister Amina about the biggest planet from the solar system. What answer was mentioned by Amina?
A. Jupiter B. Saturn C. Earth
D. Venus E. Mercury [ ]

(x) Tanzania has much valuable resource which contributes to the growth of its economy. Which national minerals used to add taste in a food among the following?
A. Gold B. Diamond C. Copper
D. Tanzanite E. Salt [ ]

(xi) After the Berlin Conference, the British and German signed other two treaties in order to divide East Africa. What was the name of the treaty that was signed in 1890 between these capitalist nations?
A. Moresby treaty B. Harmatton treaty C. Frere treaty
D. Versailles treaty E. Helgoland treaty [ ]

(xii) My grandfather was born in the year when Tanganyika gained in the independence. In which year he was born? A. 1985 B. 1964
C. 1962 D. 1961 E. 1999 [ ]

(xiii) Njema is the person who creates and develops a business in order to get profit.
Who is Njema? A. Buyer B. Seller [ ]
C. An entrepreneur D. Customer E. An economist

(xiv) What was the first exploitative mode of production experienced by human being?
A. Slavery B. Nyarubanja C. Capitalism
D. Communalism E. Feudalism [ ]

(xv) Which among the following presidents of Tanzania served with two prime ministers?
A. Ali Hassan Mwinyi B. Jakaya Mrisho Kikwete
C. Mwalimu Julius Kambarage Nyerere
D. Benjamin Mkapa E. Dr John Pombe Magufuli [ ]

2. Match the items in list A with correct response from list B by writing the letter of the correct answer on a space provided.

	EVENT	**ANSWER**		**YEAR**
(i)	The Majimaji war		**A.**	1995
(ii)	The Zanzibar revolution		**B.**	1986
(iii)	Free market economy		**C.**	1964
(iv)	Multiparty		**D.**	1995
(v)	The first election in Tanzania under multiparty system		**E.**	1992
			F.	1961
			G.	1905-1907

SECTION B: (20 MARKS)
ANSWER ALL QUESTIONS IN THIS SECTION

3(i) Explain two human activities that contribute to global warming
(a) _____
(b) _____

(ii) Explain the benefits of the discovery of fire at the end of the middle stone age
(a) _____
(b) _____

(iii) Briefly outline two benefits of understanding the climate zone in Tanzania
(a) _____
(b) _____

CANDIDATE'S NUMBER: _____

4(i) Songambele mentioned to his hazards that caused by both natural forces and human actions. Which hazard do you think were mentioned by Songambele.
(a) _____
(b) _____

(ii) Standard seven pupils learnt about cultural practiced in Tanzania. Mention two harmful tradition and customs that are still practiced in Tanzania.
(a) _____
(b) _____

(iii) What are challenges that African heroes encountered during the struggle for independence? Identify two challenges.
(a) _____
(b) _____

5(i) Outline two resolutions agreed upon at the Berlin conference
(a) _____
(b) _____

(ii) What were the effects of pre-colonialism interactions between Tanzania and Europe?
(a) _____
(b) _____

6(i) According to the small and medium enterprise development policy of 2003, entrepreneurs can be categorized into four. These four categories has been classified based on which criterions?
(a) _____
(b) _____

(ii) List two effects of the daily rise and fall of oceanic tides
(a) _____
(b) _____

SECTION C: (10 MARKS)

7. Observe carefully the table below, then answer the questions (i) – (iii)

DAYS	M	T	W	T	F	S	S
TEMP ^{o}C	30	22	20	18	15	20	15

(i) Calculate the daily mean temperature. _____
_____

(ii) The above element of weather measured by an instrument which is called_____
_____

(iii) Which day has the highest temperature? _____

(iv) The map distance from point a to Point B is 60cm. What will be the ground distance, if the map scale used is 1:50,000?_____

(v) If the time of city A which located at the longitude of 15^{0} W is 6:08am. What will the time of town B which is located at the longitude of 60^{0}E? _____
_____

THE UNITED REPUBLIC OF TANZANIA

PRESIDENT'S OFFICE

REGIONAL ADMINISTRATION AND LOCAL GOVERNMENT

RUNGWE DISTRICT COUNCIL

DISTRICT MOCK EXAMINATION

STANDARD VII - APRIL 2026

SCIENCE AND TECHNOLOGY

Code: 05E

Time: 1:30 Hours **APRIL, 2026**

CANDIDATE'S NUMBER: _____

SCHOOL NAME:_____

DISTRICT:_____REGION:_____

INSTRUCTIONS

1. This paper consists of sections **A, B** and **C** with a total of **Eight (8) questions of (thity five) 35** items.
2. Answer **all** questions correctly.
3. Section A and B carry **twenty** (20) marks each and section C carries **ten** (10) marks.
4. Remember to write your examination number and your school name correctly.
5. If you want to change your answer, you must cut once the original answer then write the new one.
6. Use blue or black ink ball pointed pen to answer all questions.
7. Cellular phones and any unauthorized materials are **not** allowed in the examination room.

This paper consists of 4 printed pages

CANDIDATE'S NUMBER: _____

SECTION A: (20 MARKS)

1. Choose the most correct answer then write its letter in the box provided.

(i) Doctor adviced Msafiri to eat sufficient food with vitamins. Which pair represents those foods?

(A) beans and fish (B) rice and potatoes (C) butter and cashew nuts
(D) Sugarcane and wheat (E) Fruits and vegetables [ ]

(ii) The body of a diabetic person fails to produce insulin. Which organ of that person has a problem?

(A) Pancreas (B) Brain (C) Kidney
(D) Gall bladder (E) Liver [ ]

(iii) Mr. Manyama wants to buy antenna that can receive electromagnetic waves of radio and television. What type of antenna will you advise him to buy?

(A) Loop (B) Yagi-Uda (C) Horn
(D) Microstrip (E) Wire [ ]

(iv) Health experts encourage parents to send their children clinic for vaccination. Which disease among the following can be prevented by vaccination?

(A) Whooping cough (B) Gonorrhea (C) Malaria
(D) Cholera (E) Stomach fever [ ]

(v) A strong and heathy boy pushed wall for ten minutes, but the wall did not fall. Why is it considered that he did not do any work?

(A) He pushed the wall which did not move any distance
(B) He used tittle effort to push the wall
(C) He did not follow scientific skills of pushing the wall [ ]
(D) He did not know the weight of the wall (E) He used short time to push the wall

(vi) Mirwa village was affected by famine due to invasion of butterflies. In which stage of growth were the butterflies?

(A) Nymph (B) Butterfy (C) Egg
(D) Catterpilar (E) Pupa [ ]

(vii) If you are asked to open spreadsheet program, which steps will you follow?

(A) Click start menu → Microsoft office → Excel.
(B) Click start menu → Microsoft word → Excel. [ ]
(C) Click start menu → Microsoft excel → Microsoft office
(D) Click start menu → Microsoft excel → Microsoft word
(E) Click start menu → Microsoft office → Microsoft words

(viii) A science teacher kept a ruler in a glass of water, then the ruler appeared to bend.Which property of light was demonstrated?

(A) Reflection (B) Bending of light (C) Shinning
(D) Spreading (E) Radiation [ ]

(ix) Why a HIV infected person is attacked by opportunistic diseases in a short time?

(A) Many diseases come always (B) There are no experts to cure diseases
(C) AIDS means many diseases (D) A victim cannot go hospital
(E) Body immunity fails to fight against those diseases [ ]

CANDIDATE'S NUMBER: _____

(x) In order to extinguish a burning material, it is advised to cover using a heavy cloth. What is the aim of doing so?

(A) To remove oxygen gas (B) To remove carbon dioxide gas
(C) To increase carbon monoxide gas (D) To remove nitrogen gas
(E) To minimize fire [ ]

2. Match the word in list A with the correct explanation in list B by writing the letter of the correct answer in the brackets provided

	LIST B	**ANSWERS**		**LIST B**
(i)	Sepals		**A.**	Stores ovules
(ii)	Petals		**B.**	Receives pollen from anther
(iii)	Ovary		**C.**	Protect young flowers before they become buds
(iv)	Stigma		**D.**	Male part of the flower
(v)	Stamen		**E.**	A flower leaf with bright colour
			F.	Transmits pollen from stigma to the ovary

3. Choose the correct answer from the box provided and write it in the blank spaces.

HIV,	**ARV,**	**Cholera,**	**Malaria,**	**Sleeping sickness,**
Sickle cell anemia,		**Hemophilia,**		**Diarrhea**

(i) A disorder in which blood does not clot when a person is injured is _____

(ii) Spread by a tsetse fly _____

(iii) A condition that causes the red blood cells to change their shape from biconcave into sickle shape is _____

(iv) Drugs used for people with HIV/AIDS to reduce the effect of the disease
_____

(v) Continuous diarrhea and passing stool which looks like rice water _____

SECTION B (20 MARKS)

4(i) The gas that is used to preserve drinks such as soda and juice_____
_____

(ii) Plants always make their own food, what is the gas that is produced during photosynthesis_____

(iii) Why renewable energy is called sustainable energy? _____
_____
_____

CANDIDATE'S NUMBER: _____

5(i) Base is a chemical substance that has slippery feel and bitter taste. List two items containing base.

(a) _____

(b) _____

(ii) There are different classes of fire. Name each type of class of fire in each of the following

(a) Fire caused by flammable liquids _____

(b) Fire caused by cooking oil _____

(iii) Explain why class B fire is not extinguished by using water

_____

6. Antenna is a device used to receive and transmit electromagnetic waves to different communication devices. Name antenna in each of the following sentences (i) and (ii)

(i) Antenna which is not much affected with environmental noises

_____

(ii) Its efficiency depends on the number of elements connected.

_____

(iii) Explain why is aluminum more suitable than copper in fabrication of antenna?

_____

_____

(iv) Which material is effective for antenna due to its ability to conduct electricity?

_____

SECTION C: Answer all questions: (10 marks)

7(i) In which part of digestive system is food absorbed? _____

(ii) The density of a wood is 20kg/m^3. If the volume of the wood is 90m^3, calculate it's mass.

_____

_____

(iii) Among the raw materials of a plant to manufacture its own food are sunlight and chlorophyll. Mention other raw materials

(a) _____ (b) _____

8. Study the simple electric circuit below then answer the questions that follow

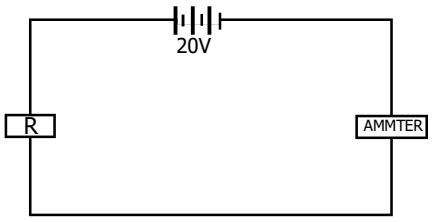

(i) If electric current is 5 amperes, calculate its resistance.

_____

_____

(ii) What will happen to the voltage if electric current increases?

_____

THE UNITED REPUBLIC OF TANZANIA

PRESIDENT'S OFFICE

REGIONAL ADMINISTRATION AND LOCAL GOVERNMENT

RUNGWE DISTRICT COUNCIL

DISTRICT MOCK EXAMINATION

STANDARD VII - APRIL 2026

CIVIC AND MORAL EDUCATION

Code: 06E

Time: 1:30 Hours **APRIL, 2026**

CANDIDATE'S NUMBER: _____

SCHOOL NAME:_____

DISTRICT:_____REGION:_____

INSTRUCTIONS

1. This paper consists of sections **A, B** and **C** with a total of **Six (6) questions of (thity five) 35** items.
2. Answer **all** questions correctly.
3. Section A and B carry **twenty** (20) marks each and section C carries **ten** (10) marks.
4. Remember to write your examination number and your school name correctly.
5. If you want to change your answer, you must cut once the original answer then write the new one.
6. Use blue or black ink ball pointed pen to answer all questions.
7. Cellular phones and any unauthorized materials are **not** allowed in the examination room.

This paper consists of 4 printed pages

CANDIDATE'S NUMBER: _____

SECTION "A" (20 MARKS)

1. Choose the correct answer and write its letter in the box provided.

(i) Mr. Mapunda is a government header who is responsible on registering birth, death and birth information at the district level. Who is Mr. Mapunda in a district?
(A) Division officer (B) District Administrative Secretary
(C) District Commissioner (D) District Executive Director
(E) District Education Officer [ ]

(ii) The picture of animal used as a watermark of Tanzania bank notes is called_____
(A) Lion (B) Elephant (C) Girrafe
(D) Tiger (E) Zebra [ ]

(iii) The constitution is a set of principles and laws that govern a nation. How many chapters in the constitution of United Republic of Tanzania?
(A) 10 (B) 6 (C) 2
(D) 20 (E) 5 [ ]

(iv) The needy are people who lack basic needs like food, shelter and clothes. Which among the following is not a needy group?
(A) Elders (B) Children (C) Thieves
(D) People with disabilities (E) Victims of Hazards [ ]

(v) Tanzania has Environmental management law. Tanzania Environmental management law was in enacted in which year?
(A) 1992 (B) 2002 (C) 2010
(D) 2015 (E) 2004 [ ]

(vi) All schools has committee. Who the secretary of the school committee?
(A) Discipline teacher (B) School Committee Chairperson [ ]
(C) Head teacher (D) Academic teacher (E) Class teacher

(vii) Which kind of support is needed to orphans who are humiliated and denied their rights to inherit their parents property?
(A) Food (B) Clothes (C) Transport facilities
(D) Medicine (E) Legal aid [ ]

(viii) Mwenge primary school succeded to manage and extinguishing fire hazards. Which among the following tools was not used in extinguisher fire?
(A) A fire engine (B) Firewood (C) A fire extinguisher
(D) Stretcher (E) A fire blanket [ ]

(ix) A society must have resources so that a pupil can fulfil his or her responsibilities. Which among the following resources is not important to pupils?
(A) Music (B) Time (C) Land
(D) Money (E) Water [ ]

(x) Which sense organs help a pupil to do practical work?
(A) The nose and the mouth (B) All the sense organs (C) The eyes and the skin
(D) the tongue and the nose (E) The eyes and the tongue [ ]

CANDIDATE'S NUMBER: _____

2. Match the items in LIST A with their correct responses in LIST B and write the letter of the correct answer in the brackets provided

LIST A

(i) Social media [ ]

(ii) Cyber crimes [ ]

(iii) Support defence and security [ ]

(iv) The cybercrimes Act, 2015 [ ]

(v) Verifying the authenticity of information before sharing it [ ]

LIST B

A. Education on proper use communication networks

B. Twitter, Instragram, WhatsApp, Youtube

C. Using abusive language on social media network

D. Proper use of communication network

E. A way of avoiding cybercrime

F. The rules and condition that guide users of communication network

3. Choose the answer in the box and then fill in the blanks.

ELEPHANT TASK, THE SPEAR, THE COTTON AND CLOVE, THE HOE, THE AXE, THE NATIONAL FLAG, UHURU TORCH

(i) The symbols which represent farmers in coart of arms _____

(ii) The symbols which represents cash crops in national emblem _____

(iii) The symbols which represent Wildlife resources in national emblem _____

(iv) The symbols which represent national defence in court of Arms _____

(v) The symbols which represent workers in coart of arms_____

SECTION B (20) MARKS

4. Re-arrange the following steps that must be followed to achieve objectives by writing A to E.

(i) Selecting methods of implementing your strategies. [ ]

(ii) Doing an evaluation. [ ]

(iii) Identifying basic requirements. [ ]

(iv) Identifying important activities to do. [ ]

(v) Setting priorities. [ ]

CANDIDATE'S NUMBER: _____

5. Answer the following question by writing the correct answer.

(i) A tax is a compulsory contribution collected for the benefits of our country. Mention two advantage of paying tax.

(a) _____

(b) _____

(ii) Briefly explain two precautions to take before a fire hazards.

(a) _____

(b) _____

(iii) Briefly explain the meaning of the following terms.

(a) Gender _____

(b) Sex _____

(iv) Goals are aims or intentions which are planned to be attained within a certain period of time. Mention two kinds of goals.

(a) _____

(b) _____

(v) Globalization has both negative and positive effects. Mention two ways of fighting negative effects of Globalization.

(a) _____

(b) _____

SECTION C 10 Marks

6. Read the following structure of judiciary system and answer the question from (i) to (v)

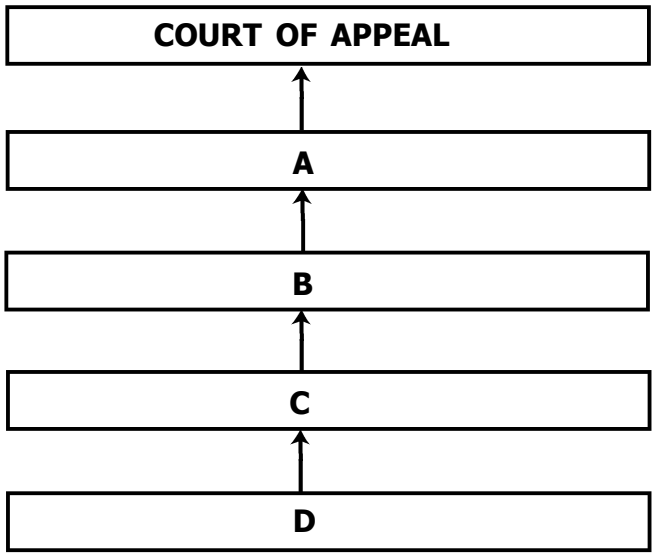

(i) The head of the court of Appeal is headed by _____

(ii) Which letter represent the Primary Court in judiciary system _____

(iii) The court which hears murder cases and civil cases is shown by which letter? _____

(iv) Which court shown by letter B? _____

(v) The court which shown by letter C is called _____

JAMHURI YA MUUNGANO WA TANZANIA

OFISI YA RAIS

TAWALA ZA MIKOA NA SERIKALI ZA MITAA

HALMASHAURI YA WILAYA YA RUNGWE

MTIHANI WA UTAMILIFU WA WILAYA

DARASA LA VII - APRILI 2026

HISABATI

Mficho: 04

Muda: Saa 2:00 **APRILI, 2026**

NAMBA YA MTAHINIWA:_____

JINA LA SHULE:_____

WILAYA:_____**MKOA:**_____

MAELEKEZO KWA MTAHINIWA

1. Karatasi hii ina sehemu **A, B** na **C** zenye maswali **8 (nane)** yenye vipengele 33.
2. Jibu maswali yote kwa usahihi kwenye nafasi ulizopewa.
3. Sehemu A na B zina alama ishirini (20) kila kimoja na sehemu C ina alama kumi (10)
4. Kumbuka kuandika namba yako ya mtihani na jina la shule yako kwa usahihi.
5. Ukigundua kuwa herufi uliyoichagua siyo jibu sahihi, kata mara moja na uandike upya pembeni
6. Tumia biki ya wino wa bluu au nyeusi iliyochongoka katika kujibu maswali.
7. Simu ya mkononi, vikokotozi na vitu visivyoruhusiwa havitakiwi ndani ya chumba cha mtihani.

Karatasi hii ina kurasa 4 zenye maandishi

NAMBA YA MTAHINIWA: _____

SEHEMU A: (ALAMA 10) Katika kila kipengele, jibu maswali yote katika sehemu hii Kokotoa maswali yafuatayo ukionesha wazi njia iliyotumika katika kupata jibu sahihi katika nafasi iliyotengwa.

NA	SWALI	KAZI NA JIBU
1(i)	723 + 5217 =	
ii.	8784 – 3878 =	
iii.	854 x 54 =	
iv.	11043 ÷ 27 =	
v.	2 - 1.999 =	
vi.	0.357 x 2.7 =	
vii.	$7^{7}/_{10} + {}^{4}/_{5}$ =	
viii.	$6^{4}/_{9} \div 2$ =	
ix.	$11 - (^{-}3)$ =	
x.	3 + 20 ÷ (9 – 4) =	
2. i.	**SEHEMU B: (ALAMA 30)** **Jibu maswali yafuatayo (Alama 6)** Kuna namba tasa ngapi zilizo kati ya 30 na 49	
ii.	Tafuta Kigawe Kidogo cha Shirika (KDS) cha 12, 18 na 20.	
iii.	Andika saa 0045 katika mtindo wa saa 12	
iv.	Andika nafasi ya thamani ya tarakimu iliyopigiwa mstari katika namba ifuatayo 782<u>4</u>52	
v.	Ni namba gani itakayofuata katika mfuatano wa namba huu 2, 5, 11, 20, 32, _____	

NAMBA YA MTAHINIWA: _____

NA	SWALI	KAZI NA JIBU
vi.	Vita vya kwanza vya dunia vilianza mwaka 1914 na kuisha baada ya miaka 4. Andika mwaka ambao vita iliisha kwa kirumi.	
3.i.	Kama Monica atauza redio yake kwa sh. 18,000/= atapata faida ya 20% ya bei aliyonunulia. Tafuta bei aliyonunulia redio.	
ii.	Kama watu watatu: Abdallah, Denis na Cosmas waligawiwa sh. 7500 kwa uwiano wa 3:2:1 Denis atapata kiasi gani cha fedha?	
iii.	Andika jumla ya namba tasa zilizopo kati ya 14 na 20	
4. a	Muda wa kuamka katika kijiji cha Kisa ni saa 1:45asubuhi. Badili muda huo katika mfumo wa saa ishirini na nne.	
b.	Simu iliuzwa kwa kiasi cha shilingi 96000 baada ya punguzo la 20%.Tafuta bei ya simu kabla ya punguzo.	
c.	Siku 3 ni sawa na masaa mangapi?	
5a.	Umbali kutoka Dinembo adi Mikinda ni meta 1500. Badili umbali huu kuwa kilometa	
b.	Gawanya lita 9 mililita 20 kwa 4	
c.	Gari ilitembea umbali wa kilometa 54. Kutoka mji A kwenda mji B kwa masaa 6. Tafuta mwendokasi wa gari.	
6a.	Tafuta thamani ya k katika mlinganyo ufuatao: $12k - 38 = 4k + 10$	
b.	Rahisisha: $x + 4w + 2w + 2w + x + 3x$	
c.	Jumla ya umri wa baba na mtoto ni miaka 40. Kama umri wa baba ni mara tatu ya umri wa mtoto. Tafuta umri wa mtoto.	

NAMBA YA MTAHINIWA: _____

NA	SWALI	KAZI NA JIBU
7.	**SEHEMU C: (ALAMA 10)** **Jibu maswali yote** Grafu kwa duara ifuatayo inaonesha idadi ya wanyama wanaofugwa katika kijiji cha Makonga. Jumla ya wanyama wote ni 640. 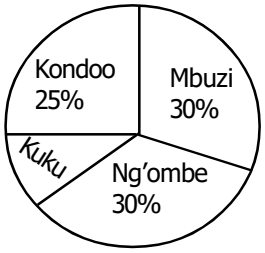 	
i.	Je, kuku ni wangapi kijijini hapo?	
ii.	Je, kondoo ni wangapi?	
8 i.	Fanya maswali yafuatayo Mzingo wa mstatili huu ni sm 216. Tafuta thamani ya "x" 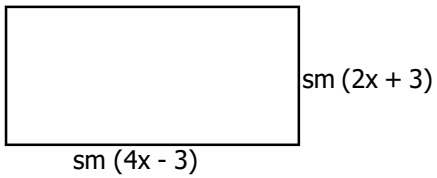 	
ii.	AOB ni mstari mnyoofu. Tafuta thamani ya herufi "a" 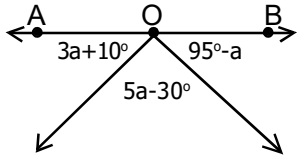 	
iii.	Mzingo wa mraba sm56 tafuta eneo la sehemu iliyotiwa kivuli. 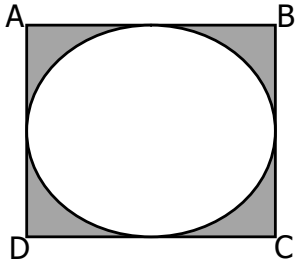 	

THE UNITED REPUBLIC OF TANZANIA

PRESIDENT'S OFFICE

REGIONAL ADMINISTRATION AND LOCAL GOVERNMENT

RUNGWE DISTRICT COUNCIL

DISTRICT MOCK EXAMINATION

STANDARD VII - APRIL 2026

MATHEMATICS

Code: 04E

Time: 2:00 Hours **APRIL,2026**

CANDIDATE'S NUMBER: _____

SCHOOL NAME:_____

DISTRICT:_____REGION:_____

INSTRUCTIONS

1. This paper consists of sections **A, B** and **C** with a total of **Eight (8) questions of (thity three) 33** items.
2. Answer **all** questions correctly.
3. Section A and B carry **twenty** (20) marks each and section C carries **ten** (10) marks.
4. Remember to write your examination number and your school name correctly.
5. If you want to change your answer, you must cut once the original answer then write the new one.
6. Use blue or black ink ball pointed pen to answer all questions.
7. Cellular phones and any unauthorized materials are **not** allowed in the examination room.

This paper consists of 4 printed pages

CANDIDATE'S NUMBER: _____

No	QUESTIONS	Working space and Answer
1. (i)	**SECTION "A" (10 MARKS)** **Answer the following questions** 723 + 5217 =	
ii.	8784 – 3878 =	
iii.	854 x 54 =	
iv.	11043 ÷ 27 =	
v.	2 - 1.999 =	
vi.	0.357 x 2.7 =	
vii.	$7^{7}/_{10} + {}^{4}/_{5}$ =	
viii.	$6^{4}/_{9} \div 2$ =	
ix.	11 – (-3) =	
x.	3 + 20 ÷ (9 – 4) =	
2. i.	**SECTION B: 30 MARKS** **Answer the following questions (6 Marks)** How many prime numbers found between 30 and 49	
ii.	Find the lowest common multiples (L C M) of 12, 18 and20.	
iii.	Write 0045 hours in 12 hours system	
iv.	Write the place value of underlined digit 782<u>4</u>52	
v.	Which number is next in this series? 2, 5, 11, 20, 32, _____	
vi.	The first world war began in 1914 and ended 4 years letter. Write in roman numerals the year in which the war ended.	

CANDIDATE'S NUMBER: _____

No.	QUESTION	Working space and Answer
3.	**Calculate the following questions (6 marks)**	
i.	If Monica will sell her radio for 18000/= shillings will get a profit of 20% from the buying price. Find the buying price	
ii.	If three people; Ally, Dennis and Cosmas share sh. 7500 in the ratio 3:2:1 respectively: how much will Dennis get?	
iii.	What is the sum of odd numbers between 14 and 20?	
4.	**Answer all question (6 Marks)**	
a.	If time of kissa village is 7: 45am. Write this time in twenty four hours format	
b.	The phone price is 96,000shillings after 20% discount. How much shilling was the phone sold before the discount?	
c.	3 days is equal to how many hours?	
5.	**Answer all questions (6 marks)**	
a.	The distance from Dinembo to mikinda is 1500metres. Change this distance into kilometer	
b.	Divide 9 liter 20milliliters by 4	
c.	A car travelled a distance of 54km between town A and town B for 6hours. Find the speed of the car	
6.	**Calculate all questions (6 Marks)**	
a	Find the value of k in the following equation: $12k - 38 = 4k + 10$	
b.	Simply the following algebraic expression: $x + 4w + 2w + 2w + x + 3x$	
c.	The sum of the ages of the father and his son is 40 years. If the age of the father is three times the age of the son. What is the age of the son?	

CANDIDATE'S NUMBER: _____

No	QUESTIONS	Working space and Answer
7.	**SECTION C: (10 MARKS)** **Answer all questions** The following pie- chart shows a number of animals kept at Makonga village. A total number of all animals is 640.  	
i.	How many hens are there at the village?	
ii.	How many sheeps are there at the village?	
8. i.	**Solve the following questions.** The perimeter of this rectangle is 216, Find the value of x 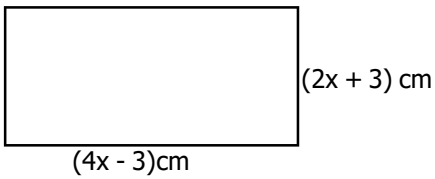 	
ii.	AOB is a stright line. Find the value of a 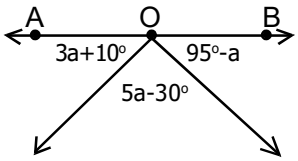 	
iii.	The perimeter of this square is 56cm. Find the area of shaded part 