Candidate's Name: _____

Name of School: _____

THE UNITED REPUBLIC OF TANZANIA

PRIME MINISTER'S OFFICE, REGIONAL ADMINISTRATION AND LOCAL GOVERNMENT

BAGAMOYO DISTRICT COUNCIL

MOCK STANDARD SEVEN

06E CIVIC AND MORAL EDUCATION

Time: 1 Hour 30 Minutes **April, 2026**

INSTRUCTIONS

1. This paper consists of sections **A**, **B and C** with a total of **Six (6)** questions.
2. Answer **all** questions in each section.
3. Write your answers in the space provided in each question.
4. All answers must be written in **blue** or **black** pen.
5. Cellular phones, and any unauthorized materials are not allowed in the assessment room.
6. Write your **Number and Name of your School** in the space provided.

FOR EXAMINERS' USE ONLY		
Question Number	**Score**	**Checker's Initials**
1		
2		
3		
4		
5		
6		
Total		

SECTION A: 20 MARKS

1. Choose the correct answer and write its letter in the box provided.

i. Which letter shows a group of people with special needs in the society?
A. Parents, leaders and elderlies B. Albinos, leaders and youths
C. Orphans, street children and the disabled D. Workers, refugees and parents
E. Women, men and youths [ ]

ii. Which of the following is the act of respect for the pupils of opposite sex at school? A. Boys and girls to sleep together B. Separating seats of boys and girls
C. Pupils to communicate in English language D. Boys to laugh at girls
E. Both pupils to study in the same classroom [ ]

iii. Which dressing style identifies immoral people in the community we are living?
A. Women to wear trousers B. Wearing sagging trousers
C. Wearing patched clothes D. Girls to wear long dresses
E. Men to wear kanzu [ ]

iv. The following are acts of volunteering among pupils at school **EXCEPT:**
A. Participating in self-reliance activities B. Joining different school clubs
C. Planting trees and flowers D. Helping young ones
E. Wearing proper uniforms [ ]

v. Why do some communities prefer to wear traditional clothes like Lubega?
A. They promote cultural values B. They reflect globalization
C. They generate incomes D. They promote cooperation
E. They increase social classes [ ]

vi. In which of the following occasions is our National Anthem sung?
A. When raising national flag B. During general elections
C. During national examinations D. During Uhuru torch race
E. During natural disasters [ ]

vii. The name Tanzania came into official use in the year 1964. How did that name happen? A. After the independence of Tanganyika B. After Zanzibar revolutions
C. After the union of Tanganyika and Zanzibar D. After the republic of Tanganyika
E. After British colonialism [ ]

viii. Ward tribunal is an important organ of the ward government. What does it fulfill in the ward?
A. To approve development budgets
B. To elect councilors
C. To elect chairperson of the development committee
D. To collect taxes
E. To solve minor conflicts [ ]

ix. Which way can the school management use to identify pupils who engage in love affairs and other forms of irresponsible sex secretly?
A. By establishing counselling unit B. By enacting strict school rules
C. By issuing corporal punishments D. By installing suggestion box
E. By reporting to parents [ ]

x. Which of the following acts implies conservation of environment?
A. Using biogas for cooking B. Using charcoal for cooking
C. Burning forests to hunt animals D. Cultivating on slopes
E. Improper waste disposal [ ]

2. Match the items in COLUMN A with their corresponding responses from COLUMN B.

	COLUMN A		COLUMN B
i.	Uhuru na Umoja	A.	Represents coastline and water bodies
ii.	Peak of Mount Kilimanjaro	B.	Represents mineral resources
iii.	Blue waves	C.	Represents our national motto
iv.	Clove and cotton	D.	Represents pride of Tanzania
v.	Red portion	E.	Shows that our country is independent
		F.	Represents cash crops
		G.	Represents fertile soil

Answers

COLUMN A	**i.**	**ii.**	**iii.**	**iv.**	**v.**
CLUMN B					

3. Fill in the blanks with correct words from the chart

Gender	Recycling	Goals
Environment	Patriotism	Sex

i. Things that we want to achieve in the future are called _____

ii. The total surroundings of a human being that include mountains, forests, building and other organisms are referred to as _____

iii. The act of loving your country and being ready to defend it against is known as _____

iv. The biological characteristics that help to differentiate a male from a female that include reproductive systems. _____

v. The act of turning waste products into commodities and reusing them is known as _____

SECTION B: 40 MARKS

4. Rearrange the following structure of school leadership from TOP to BOTTOM

ILLOGICAL STRUCTURE	LOGICAL STRUCTURE
Academic teacher	i.
Other teachers	ii.
Head teacher	iii.
School Committee	iv.
Assistant head teacher	v.

5. Answer the following questions correctly.

i. Write two responsibilities of the Class prefect
   a. _____
   b. _____

ii. Why are we supposed to standstill when singing our National Anthem? Briefly explain _____

iii. Where are the headquarters of the East African community located? Write the City and the country _____

iv. Responsibilities are the things that we must do. Write two responsibilities that a child should perform at home
   a. _____
   b. _____

v. What does Chapter IV of the Constitution of the United Republic of Tanzania explain about?
   a. _____
   b. _____

SECTION C: 10 MARKS

6. Write short answers for each of the following questions

i. National festivals help us to learn our national history. Mention two national festivals that are celebrated in Tanzania
   a. _____
   b. _____

ii. Suggest two ways that you can use to identify illegal immigrants in your society
   a. _____
   b. _____

iii. Why is land regarded as the mother resource? _____

iv. What ways can the school use to get funds for its development?
   a. _____
   b. _____

v. Name two acts that violate rights of children in Tanzania
   a. _____
   b. _____

Candidate's Name: _____

Name of School: _____

THE UNITED REPUBLIC OF TANZANIA

PRIME MINISTER'S OFFICE, REGIONAL ADMINISTRATION AND LOCAL GOVERNMENT

BAGAMOYO DISTRICT COUNCIL

MOCK STANDARD SEVEN

04E MATHEMATICS

Time: 2 Hours **April, 2026**

INSTRUCTIONS

1. This paper consists of sections **A**, **B and C** with a total of **Eight (8)** questions.
2. Answer **all** questions in each section.
3. Write your answers in the space provided in each question.
4. All answers must be written in **blue** or **black** pen.
5. Cellular phones, and any unauthorized materials are not allowed in the assessment room.
6. Write your **Number and Name of your School** in the space provided.

FOR EXAMINERS' USE ONLY		
Question Number	**Score**	**Checker's Initials**
1		
2		
3		
4		
5		
6		
7		
8		
Total		

NO.	QUESTION	SOLUTION AND ANSWER
1.	**SECTION A (10 MARKS)**	
	i. 66 + 21 =	
	ii. 5743 - 2776 =	
	iii. 53 X 13 =	
	iv. 504 ÷ 9 =	
	v. $\frac{4}{7}$ - $\frac{2}{7}$ =	
	vi. $\frac{6}{7}$ - $\frac{5}{8}$ =	
	vii $\frac{5}{6}$ x $\frac{7}{12}$ =	
	viii. 43. 36 + 25.38 =	
	ix. 86. 42 - 39.48 =	
	x. $^{+}$235 + (-200) =	
2.	**SECTION B (30 marks)**	
	i. Write 813 in words	
	ii. Write 47 in Roman numbers	
	iii. What is the place value of the underlined digit in 4**0**7362?	
	iv. Write the number corresponding to the following place values 8 tens, 6 thousands, 9 hundreds, 7 ones	
	v. Approximate 687189 to the nearest ten thousands	
	vi. Write the following number in short form 90000 + 5000 + 300+ 80 + 7	

NO.	QUESTION	SOLUTION AND ANSWER
3.	i. What is the least number which can be divided by 18, 86 and 27 without leaving a remainder?	
	ii. Identify the next number in the sequence below 1, 8, 27, 64, _____	
	iii. Write down all even numbers found between 60 and 80 that are also divisible by 3	
4.	i. Write down the time shown by the clock face below in words. 	
	ii. Hours Minutes 6 30 + 3 45 _____ _____	
	iii. A football match started at 1845 hours. At what time in 12 hours format did the game start?	
5	i. Joan weights 48kg 294g while Jesca weighs 39kg 729g. Find their total weight	
	ii. Change 0.075km into metres	
	iii. A farmer distributed 180kg 400g of maize among 4 families equally. What amount of maize did each family get?	
6.	i. Simplify 7(3 -2x) – (25- x)	

NO.	QUESTION	SOLUTION AND ANSWER
	ii. The age of John is twice the age of his son. If the sum of their ages is 78. Find the age of his son	
	iii. Find the value of x 6 – (3-2x) = 1	
7.	**SECTION C: (10 MARKS)** i. The average of 5 numbers is 54. If four members are 43, 50, 52, 56, Find the fifth number	
	ii. According to the census of 2022. Arumeru district had 900,000 people whose distribution is shown by the pie chart below 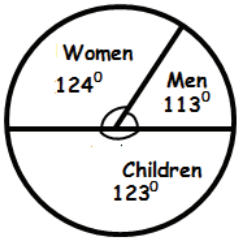 How many more women were there than children?	
8	i. Find the value of C 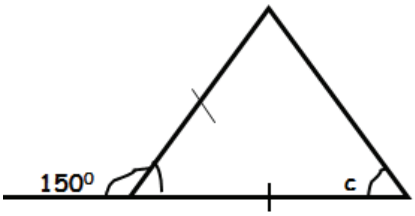	
	ii. Find the volume of the cylinder below 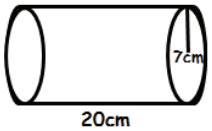	
	iii. If the area of trapezium ABCD is $160cm^2$ what is the length of BE? 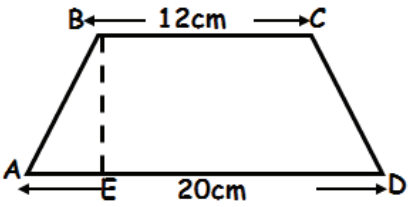	

Candidate's Name: _____

Name of School: _____

THE UNITED REPUBLIC OF TANZANIA

PRIME MINISTER'S OFFICE, REGIONAL ADMINISTRATION AND LOCAL GOVERNMENT

BAGAMOYO DISTRICT COUNCIL

MOCK STANDARD SEVEN

05E SCIENCE AND TECHNOLOGY

Time: 1 Hour 30 Minutes **April, 2026**

INSTRUCTIONS

1. This paper consists of sections **A and B** with a total of **Eight (8)** questions.
2. Answer **all** questions in each section.
3. Write your answers in the space provided in each question.
4. All answers must be written in **blue** or **black** pen.
5. Cellular phones, and any unauthorized materials are not allowed in the assessment room.
6. Write your **Number and Name of your School** in the space provided.

FOR EXAMINERS' USE ONLY		
Question Number	**Score**	**Checker's Initials**
1		
2		
3		
4		
5		
6		
7		
8		
Total		

SECTION A (20 MARKS)

1. Answer items (i) –(x) by choosing the correct answer and write the letter of the correct answer in the box provided.

i) How will you know that you are suffering from diabetes?
   a. High fever and frequent diarrhea
   b. Frequent urination and feeling thirst all the time
   c. Appearance of rashes in the body and high fever
   d. Stomach upset and vomiting
   e. Blood in urine and chest pain [ ]

ii) Why is it advisable for people living with HIV and AIDS to take food rich in vitamins?
   a. HIV stays for a long time
   b. Their life is short thus they need enough food
   c. They become hungry all the time
   d. They need to strengthen their body immunity
   e. To increase confidence [ ]

iii) Which among the following is not a harmful effect of diffusion?
   a. Spreading of harmful gases
   b. Spread of smell from wastes
   c. Absorption of mineral salts by roots from the soil
   d. Spreading of smoke causing pollution
   e. Spreading of harmful chemical in water causing death of aquatic animals [ ]

iv) Which of the following is not a computer network device?
   a. Battery b. Router c. Bridge d. Switch e. Wire [ ]

v) Which one of the following should be done to help a person with burns?
   a. To tighten the burnt part with clean moist cloth
   b. To break the blisters
   c. To apply lotion or oil on the burnt part
   d. Warm the burnt part with hot water
   e. Cool the burnt part with cool water [ ]

vi) Which sentence is correct about HIV and AIDS?
   a. The source of HIV is bacteria b. A person with HIV has no white blood cells
   c. It is easy to prevent AIDS than HIV d. Having HIV is the same as having AIDS
   e. Avoiding transmission of HIV will also avoid AIDS [ ]

vii) Uncle Mayala collects used boxes and papers and sell them to the industries for making new papers. Which type of waste management is that?
   a. Incineration b.Re-using c. Burying d. Recycling e. Burning [ ]

viii) Which among the following plants has a taproot system?
   a. Bean b. Maize c. Millet d. Coconut e. Rice [ ]

ix) Which term best describes a dark shape of an object that occurs when light is blocked by the opaque material?
   a. Media b. Echo c. Shadow d. Picture e. Reflection [ ]

(x) Which of the following shows that living things depend on each other?
   a. The use of cow dung manure on the maize farm
   b. The use of insecticides on plants
   c. Plants using sunlight and carbon dioxide to make their own food
   d. The use of inorganic fertilizers on a maize farm
   e. The use of paper to make charcoal [ ]

2. Match the causes of diseases in list A with the respective diseases in list B by writing the letter of the correct answer in the spaces provided.

LIST A		LIST B
i) A disease caused by protozoa	[ ]	A. Ebola
ii) A diseases caused by bacteria or amoeba	[ ]	B. Sickle cell anaemia
iii) A disease caused by virus	[ ]	C. Meningitis
iv) A disease caused by bacteria	[ ]	D. Trichomoniasis
v) A disease caused by bacteria or virus	[ ]	E. Dysentery
		F. Haemophilia
		G. Cholera

3. Use the words in the box to fill in the blanks below.

Cochlea , pinna, auditory nerve, meatus, ear ossicles, semi-circular canals, Eustachian tube

i) Transmit sound waves to the brain for interpretation _____

ii) Helps to balance the body (body equilibrium) _____

iii) Collect sound waves and direct them to the middle ear _____

iv) Receive vibrations from the ear drum and direct them to the inner ear _____

v) Contains microscopic hair fibres that receive the sound waves vibrations and transmit them to the auditory nerve _____

SECTION B (20 MARKS)

4. Answer the following questions according to the instructions.

i) What is the function of bacteria and fungi that live in the soil? _____

ii) Which type of soil limits the penetration of water and air hence causing water logging? _____

iii) For the last five years my father has been growing cereal crops and the soil is exhausted. Which type of crops will you advise him to grow for the soil to regain fertility? _____

5. Answer the following questions according to the instructions

i) Explain one advantage of doing scientific investigation _____

ii) An intelligent guess about the cause of the problem under investigation is called _____

iii) Explain why some plants wither during the dry season. _____

6. Rust is a reddish brown coat that occurs on the surfaces of iron materials.

i) Mention two other conditions for rusting to occur. _____

ii) Explain the effects of rusting in your environment _____

iii) Mention two examples of non-rusting substances _____

iv) Briefly explain how painting can prevent rusting _____

SECTION C (10 MARKS)

7. The figure below shows one of the type of telephone. Use it to answer the questions that follows.



i) What is the function of the part labelled by letter A? _____

ii) What is the name of the part shown by letter B? _____

iii) Which type of antenna is used in this device? _____

8. Answer the following questions according to the instructions.

i) A stone weighs 100 newtons in the air. If the stone is immersed in a fluid, it weighs 80 newtons. Find the upthrust force acting on the stone. _____

_____

ii) The density of a substance is 80 kilograms per cubic metres. If its mass is 240 kilograms, calculate its volume. _____

_____

Candidate's Name: _____

Name of School: _____

THE UNITED REPUBLIC OF TANZANIA

PRIME MINISTER'S OFFICE, REGIONAL ADMINISTRATION AND LOCAL GOVERNMENT

BAGAMOYO DISTRICT COUNCIL

MOCK STANDARD SEVEN

03E SOCIAL STUDIES AND VOCATIONAL SKILLS

Time: 1 Hour 30 Minutes **April, 2026**

INSTRUCTIONS

1. This paper consists of sections **A, B** and **C** with a total of **seven (7)** questions.
2. Answer **all** questions in each section.
3. Write your answers in the space provided in each question.
4. All answers must be written in **blue** or **black** pen.
5. Cellular phones, and any unauthorized materials are not **allowed** in the assessment room.
6. Write your **Number and Name of your School** in the space provided.

FOR EXAMINERS' USE ONLY		
Question Number	**Score**	**Checker's Initials**
1		
2		
3		
4		
5		
6		
7		
Total		

SECTION A: 20 MARKS

1. Choose the correct answer and write its letter in the box provided.

i. Some natural disasters damage human settlements and cause homelessness. Which of the following is **not** among those disasters?
A. Pandemic diseases B. Floods C. Volcanic eruptions
D. Landslides and mudflows E. Earthquakes [ ]

ii. Which characteristics have significantly contributed to pastoral activities in Dodoma, Manyara, Arusha and Mara regions?
A. Fertile soil and moderate rainfall B. Moderate temperature and heavy rainfall
C. Moderate rainfall and grassland vegetation D. High temperature and thick forest
E. Grassland vegetation and heavy rainfall [ ]

iii. Zanzibar and Egypt attained independence through revolutionary means. Why did patriots use that method?
A. They wanted to preserve colonial interests
B. They wanted to create puppets
C. They wanted to hand over power to majority
D. They wanted to be slaves
E. They wanted to get financial supports [ ]

iv. Which of the following practices degrades natural resources in the village?
A. To control cutting of trees B. Unmanageable waste disposal
C. Reserving natural forests D. Recycling solid wastes
E. Prohibiting poaching [ ]

v. Why do Sukuma women normally greet men by slightly bending their knees?
A. To show love to their husbands B. To respect their marriages
C. To attract visitors D. To show good manner
E. They want to be respected [ ]

vi. What contributions do national leaders have in promoting development of our nation?
A. Privatizing national resources to foreigners
B. Maintaining unity and peace
C. Conducting general elections
D. Overcoming patriotism
E. Strengthening corruption [ ]

vii. Why was production based on subsistence and not for sale during communal societies?
A. People lived in small societies B. Resources were scarce
C. Resources were distributed equally D. People worked together
E. People used crude technology [ ]

viii. Which digital devices can be used to take and record pupils' athletic competition at school?
A. Compact and flash discs B. Websites and webpages
C. Cameras and smartphones D. Library and notebooks
E. Computers and websites [ ]

ix. Selina lives in areas with hot weather condition. The following acts will protect her against effects of that weather **except:**
A. Wearing black clothes B. Wearing light clothes C. Taking cold drinks
D. Staying under the shade E. Taking bath regularly [ ]

x. How can you overcome dust when sweeping an earthed floor?
A. By covering the floor with a mat B. By planting grasses
C. By mopping with water D. By putting tiles
E. By sprinkling water [ ]

xi. Which materials would you use for make-ups during drama?
A. Coats and kikoi B. Earrings and necklaces C. Masks and walking stick
D. Chains and shorts E. Bracelets and shakers [ ]

xii. Water and flower pots are clay objects that are made by modelling. How are those objects hardened after modelling?
A. By coiling them B. By pinching them C. By firing them
D. By watering them E. By slabbing them [ ]

xiii. Malima was advised to eat body-building foods. Which foods should he eat?
A. Potatoes, cassava and yams B. Baobab, grapes and oranges
C. Flying termites, fish and green grams D. Rice, tamarind and beans
E. Ghee, maize and millet [ ]

xiv. Which waste materials should be disposed in dustbins at home environment?
A. Banana peels and food remains B. Animal dungs and torn clothes
C. Industrial chemicals and plastic bottles D. Used pads and manures
E. Grasses and shoes [ ]

xv. Why is it important to apply petroleum jelly on human skin after taking bath?
A. To avoid skin rashes B. To keep the skin dry C. To remove dust
D. To soften the skin E. To kill germs [ ]

2. Match the minerals in LIST A with their respective areas of extractions from LIST B.

LIST A		LIST B	
i.	Ruby	A.	Namtumbo, Ruvuma
ii.	Diamond	B.	Ulanga, Morogoro
iii.	Uranium	C.	Mererani, Manyara
iv.	Iron	D.	Kilosa, Morogoro
v.	Copper	E.	Mwadui, Shinyanga
		F.	Karagwe, Kagera
		G.	Mpanda, Katavi
		H.	Liganga, Njombe

Answers

LIST A	**i.**	**ii.**	**iii.**	**iv.**	**v.**
LIST B					

SECTION B: 20 MARKS

3. Fill in the gaps with correct answers.

i. Which ways can be used to honour and cherish the contributions of our former heroes?
a. _____
b. _____

ii. How did the ancient man discover fire during the Middle Stone Age?
_____

iii. Hadzabe and Sandawe are the societies that still practice Communal mode of production. What are the main activities performed by those societies?
a. _____
b. _____

4. Write short answers for each of the following questions.

i. What importance does thermosphere have on the earth's surface?

_____

ii. Explain two positive effects of water tides on lakes and oceans

a. _____

b. _____

iii. How can the map scale of 1:250 000 be expressed in words?

5. Fill in the blanks with correct answers.

i. Which external factors contributed to the increase of liberation struggles and attainment of independence in African countries?

a. _____

b. _____

ii. How would you arrange the following historical events starting from the earliest to the latest? Maji Maji War, Berlin Conference, Kagera War, Decolonization of Tanganyika

a. _____

b. _____

c. _____

d. _____

6. Fill in the gaps

i. What benefits does Tanzania get by cooperating with other countries?

a. _____

b. _____

ii. What were the reasons for the collapse of the former East African Community?

a. _____

b. _____

SECTION C: 10 MARKS

7. Study the following picture and answer the questions that follow

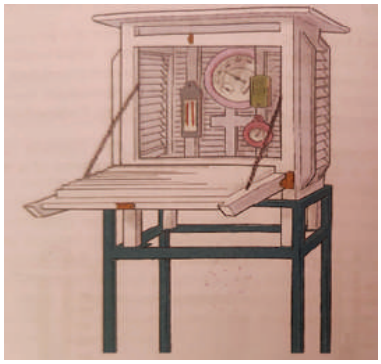

Questions

i. What is the main function of the device shown on the above picture? _____

_____

ii. Why is the above device painted white colour? _____

iii. Name two weather instruments that be kept in the above device

a. _____

b. _____

iv. What are the causes of global warming?

a. _____

b. _____

v. Explain why is it recommended to install a rain gauge 30Cm above the ground?

_____