JAMHURI YA MUUNGANO WA TANZANIA OFISI YA
WAZIRI MKUU TAWALA ZA MIKOA NA SERIKALI ZA MITAA

HALMASHAURI YA WILAYA YA CHAMWINO

MTIHANI WA UPIMAJI -DARASA LA SABA

KISWAHILI

Muda:Saa1:40 **APRIL, 2026**

MAELEKEZO

1. Mtihani huu una sehemu A,B na C zenye jumla ya maswali Sita(6)
2. Jibu maswali yote katika kila sehemu
3. Majibu yote yaandikwe katika karatasi hii
4. Tumia kalamu ya wino wa rangi ya bluu au mweusi
5. Simu za mikononi na vifaa vingine visivyohitajika haviruhusiwi katika chumba cha mtihani.
6. Andika kwa usahihi **Namba yako** na **Jina la Shule** kwenye sehemu ulizopewa.

KWAMATUMIZI YA MTAHINI TU		
Namba ya Swali	**Alama**	**Saini ya Mtahini**
1		
2		
3		
4		
5		
6		
Jumla		
SAHIHI YA MHAKIKI		

SEHEMUA.(Alama20)

1. Sikiliza kwa makini hadithi itakayosomwa na msimamizi, kisha jibu swali la kipengele cha (i – v) kwa kuandika herufi ya jibu lililo sahihi kwenye mabano.

(i) Kifungua mimba katika familia ya mzee Warioba ni _____
(a)Joshua (b) Asha (c) Amina
(d) Ashura (e) Amani [ ]
(ii) Kitinda mimba katika familia ya mzee Warioba ni _____
(a) Joshua (b) Asha (c) Amina
(d) Ashura (e) Amani [ ]
(iii) Ni mtoto yupi anaendesha ndege? _____
(a) Joshua (b) Asha (c) Amina
(d) Ashura (e) Amani [ ]
(iv) Ni mtoto yupi anafanya kazi hospitalini? _____
(a) Joshua (b) Asha (c) Amina
(d) Ashura (e) Amani [ ]
(v) Familia ya mzee Warioba ina jumla ya watoto wangapi?
(a) Tatu (b) Nne (c) Tano
(d) Mbili (e) Sita [ ]

2. Soma maswali yafuatayo kasha chagua jibu sahihi na kuweka herufi katika mabano.

i. Katikamaneno"kiboko,sungura,mamba,nyanguminapapa.Nenolipinitofautina mengine?
a)Kiboko b)Sungura c)Mamba
d)nyangumi e)papa [ ]

ii). Neno gani kati ya yafuatayo linafaa kuwa la mwisho katika upangaji wa maneno kwa kufuata mtiririko wa kamusi?
a)Teke b)zawadi c)pazia
d)kiza e)yatima [ ]

iii) "Mate ya shangazi yakikauka uwe umekwisha rudi".Neno lililopigiwa mstari ni aina gani ya neno?
a) kihusishi b) kihisishi c) kitenzi
d)kivumishi e)kinominishi [ ]

iv) Maana ya nahau"Paka shume"ni ipi kati ya zifuatazo?
a)Paka wa nyumbani b)mtu mwovu c)mtu mwema
d)chui e)paka mweusi [ ]

v) Bainisha kiambishi cha nafsi katika sentensi"mimi ninasoma Kiswahili"
a)ni- b)–ma c)soma
d)–na- e)–som- [ ]

vi) Wanafunzi wana soma hadithi ya kusisimua. Sentensi hii ipo katika wakati gani?
a)ujao b)uliopita c)mtimilifu
d)uliopo e)unaoendelea [ ]

vii) Kamilisha kitendawili hiki."Anajihami bila_____"
a)kinyonga b)silaha c)mkuki
d)panga e)jembe [ ]

viii) Methali"usitukane wakunga na uzazi ungalipo"ina maana sawa na methali ipi kati ya hizi zifuatazo?

a)Damu nzito kuliko maji b)Usiache mbachao kwa msala upitao

c)hakuna masika isiyo kuwa na mbu d)usitukane mamba kabla haujavuka mto

e)Haba na haba hujaza kibaba [ ]

ix) "Kaka na dada hawaimbiani wimbo". Katika sentensi hii, kiambishi cha ukanushi ni ___

a) ha- b)–wa- c) imb-

d)–ian- e) da [ ]

x) Neno lipi linajumisha maneno yafuatayo"zohali, zebaki,mihili,zuhura na dunia"

a)fedha b)sarafu c)sayari

d)samani e)samawati [ ]

3. Oanisha maneno ya sehemu A na maana zake katika sehemu B.

SEHEMU A	SEHEMU B
i. Adhimu ii. Katu iii. Laghai iv. Mninga v. Muujiza	A. Danganya B. Jambo lisilo la kawaida C. Enye ubora wa pekee D. Hata kidogo,kamwe E. Mti unaotoa mbao ngumu za kutengenezea samani F. kituko

MAJIBU

SEHEMU A	i	ii	iii	iv	v
SEHEMU B					

4. Umepewa sentensi tano(5)zilizochanganywa zipange kwa kuzipa herufi A,B,C,D na E ili zilete mtiririko mzuri wenye mantiki.

i. Waliahidi kutekeleza maelekezo yote aliyoyatoa. [ ]

ii. Mkuu wa Wilaya aliwaaga wanakijiji pamoja na viongozi wa kijiji na kuondoka. [ ]

iii. Baada ya hotuba, wanakijiji walipewa fursa ya kuuliza maswali [ ]

iv. Pia walimshukuru Mkuu wa Wilaya kwa kuwatembelea na kuwahamasisha Kushiriki shughuli za maendeleo ya kijiji chao. [ ]

v) Waliuliza maswali mbalimbali pamoja na kutoa hoja zao walizokuwanazo.[ ]

5. Soma kwa makini habari ifuatayo kisha jibu maswali yanayofuata.

Hapo zamani palikuwa na kijana mmoja aliyeitwa Bahati. Bahati alikuwa mtoto yatima.Wazazi wake walifariki akiwa mdogo. Baada ya wazazi wake kufariki, alienda kuishi kwa shangazi yake. Shangazi alikuwa na mtoto wa kike aitwaye Kabula. Mama yake Kabula hakumpenda Bahati. Alimpa kazi nyingi kila wakati. Kabula alipewa kazi nyepesi lakini kazi ngumu alipewa Bahati. Kabula aligundua hayo na aliumia sana. Kila wakati mama yake Kabula **alimkalia kitako** Bahati bila sababu yoyote. Bahati alijitahidi kuwa mtoto mwema lakini haikusaidia.

Maswali;

i. Bahati alifiwa na wazazi wake akiwa mdogo. Mtoto aliyefiwa na wazazi wake huitwaje?_____

ii. Eleza maana ya nahau kumkalia mtu kitako kama ilivyoelezwa kwenye habari._____

iii. Taja jina la mhusika mkuu katika hadithi hii_____

iv. Andika kisawe cha neno Bahati. _____

v. Kabula ni motto wa shangazi yake Bahati.Je,Bahati atamwitaje Kabula?_____

6. Jaza vipengele vya muundo wa barua kwa kuchagua maneno sahihi katika kisanduku.

S.L.P 88, Wako katika maendeleo, Husika na kichwa cha habari hapo juu, Ndugu, 13/04/2024, Madhumuni ya barua.

Shule ya Msingi Kibate,

i)_____

Kigoma.

ii)_____

Kumb.Na.MWZ/KBT/01.

M/kiti wa Kijiji cha Kibete,

S.L.P.2021KIGOMA.

iii)_____

YAH: MAOMBI YA KUWAHAMASISHA WANAKIJIJIKUSAFISHA BARABARA WANAYOPITA WANAFUNZI

iv)_____

Siku za hivi karibuni kumekuwa na matukio ya kusikitisha kwa wanafunzi wanaokuja shuleni, wanafunzi wamekuwa wakikabwa, kuibiwa vitu vyao na kujeruhiwa na wadudu wakali kama vile nyoka.Kutokana na hili uwa hamasishe wanakijiji kusafisha vyote njiani.

Nimatumaini yangu ombi langu litatekelezwa.

v)_____

JAMHURI YA MUUNGANO WA TANZANIA OFISI YA WAZIRI
MKUU TAWALA ZA MIKOA NASERIKALI ZA MITAA

HALMASHAURI YA WILAYA CHAMWINO

MTIHANI WA DARASA LA SABA

SAYANSI NA TEKNOLOJIA

Muda:Saa1:30 **APRIL, 2026**

MAELEKEZO

1. Mtihani huu unasehemu **A**,**B na C** zenye jumla ya maswali **Nane(8)**
2. Jibu maswali **yote** katika kila sehemu
3. Majibu yote ya andikwe katika karatasi hii
4. Tumia kalamu ya wino wa rangi ya **bluu** au **mweusi**
5. Simu za mikononi na vifaa vingine visivyohitajika **haviruhusiwi** katika chumba cha mtihani.
6. Andika kwa usahihi **Namba yako** na **Jinala Shule** kwenye sehemu ulizopewa.

KWAMATUMIZIYAMTAHINI TU		
NambayaSwali	**Alama**	**SainiyaMtahini**
1		
2		
3		
4		
5		
6		
7		
8		
Jumla		
SAHIHIYAMHAKIKI		

SEHEMU A

1. Chagua herufi ya jibu sahihi na uandike kwenye parandesi ulizopewa.

i) Mahindi, mtama, uwele na mchele ni mfano wa mazao yaliyo katika makundi ya mimea.
a)Daikotiledoni b)Monokotiledoni c)mbegu
d)mimea isiyo na maua e)mimea pandikizi [ ]

ii) Wanyama wanagawaniyika katika makundi makubwa mawili. Ni kundi gani la wanyama lina patikana zaidi katika mazingira tunayoishi?
a) Mamalia b)wasio na uti wa mgongo c) wenyeuti wa mgongi
d) ndege e) samaki [ ]

iii) Wakati Kataba alipokuwa akimpima kaka yake kiwango cha joti mwilini alitumia themometa na akakuta ananyuzi joto 4 za sentigredi, kokotoa nyuzi hizo katika Fahrenheit
a) 96^0F b)32^0F c)104^0F d) 40^0F e)39.2^0F [ ]

iv) Muunganiko wa maji, hewa ya kabonidayoksaidi,mwanaga wa jua na umbijani unapelekea tendo gani?
a)Mmea kufuata mwanga b)usanisi nuru c)upukutishaji wa mmea
d)difusheni e)osmosis [ ]

v) Ukiwa kama mtaalamu wa Tehama ukapewa dhamana ya kushauri utabiri wa hali ya hewa utashauri watumie aina gani ya antenna kutabiri mabadiliko ya hali ya hewa?
a) Yagi-uda b)Antena kitanzi c)dishi
d)Antena kidoa e)Antena kipenyo [ ]

vi) Maeneo ambayo huhitaji ulinzi wa macho ili macho ya siathirike huwekwa alama zipi?
a) Kulinda macho na sura b)Inadhuru c)kukinga macho d)hatari e) Inawasha [ ]

vii) Ipi kati ya zifuatazo inaeleza kanuni ya Archimedes?
a) Kanielezi=uzito wa kitu hewani – uzito wa kitu kwenye maji
b) Densiti=$\frac{tungamo}{ujazo}$
c) Uzito=tungamox mchapuko wa mvutano
d) Volteji=Mkondo wa umeme xukinzani [ ]
e) Kazi=kani x umbali

viii) Rangi ipi inatumika kuonesha maelekezo ya lazima?
a)Njano b)nyekundu c)bluu
d)kijani e)zambarau [ ]

ix) Mwalimu Sara alimkuta mwanafunzi wa darasa la sita ameketi pembeni ya moto ilikupata joto, je,ni kwa njia gani joto lilisafiri kumfikia kijana huyo?
a)Msafara b)mnururisho c)mpitisho
d)mionzi e)miale [ ]

x) Mlango wafahamu unaofanyakazi ya kuhisi baridi au jotoni
a)Jicho b)sikio c)ulimi
d)ngozi e) Pua [ ]

2. Oanisha sehemu A na sehemu B kwa kuandika majibu sahihi sehemu ulizopewa.

Na.	SEHEMU A	SEHEMU B
i) ii) iii) iv) v)	Uchafuzi wa maji Ugonjwaunaosababishwana kusinyaa kwa seli nyekundu za damu Kuandaa matokeo ya mitihani Mfano wa mashine tata Samaki, maziwa, maharage	A. Kichakatokikuu B. Kutiririsha maji taka kutokavyooni na kemikali kutoka viwandani C. Program jedwali D. AnemiaSelimundu E. Mafuta F. Protini G. Kompyuta H. Saratani I. Brenda na baiskeli

MAJIBU

SEHEMU A	i	ii	iii	iv	V
SEHEMU B					

3. Jaza nafasi zilizoachwa wazi kwa kuchagua jibu sahihi kwenye kisanduku cha maneno.

Ateri, Vena, Figo, Alveori, Kapilari

i). Mahali ambapo mbadilishano wa damu kati ya ateri na vena hutokea huitwa_____

ii) Mahali ambapo damu huchujwa na kuondolewa taka mwili huitwa_____

iii) Mshipa ambao husafirisha damu yenye kabonidayoksaidi huitwa_____

iv) Mshipa ambao husafirisha damu yenye oksijeni huitwa_____

v) Mahali ambapo kabonidayoksaidi huondolewa nje na kuruhusu hewa ya oksijeni huitwa

_____

SEHEMUB.

Andika majibu mafupi kulingana na maelezo ya kila swali.

4. i) Mwalimu wa sayansi katika shule ya msingi maweni alihitaji kupanga matokeo ya wanafunzi wake katika jaribio la mwezi kwa kutumia program jedwali. Andika sehemu ya tarakilishi ambayo ilitumika kama ubongo wa tarakilishi _____

i) Mkusanyiko wa programu zinazoiongoza tarakilishi kuipa muongozo na kuweza kufanya kazi huitwa _____

ii) Mwita alifungua akaunti katika benki ya NMB iliyoko Tarime, alipokwenda Mkoani Tanga katika benki ya NMB alikuta taarifa zake, kitu ambacho kilimshangaza sana Mwita, Je, huu ni aina gani ya mtandao ambao benki ya NMB inatumia? _____

5. i) Katika jaribio la kuzima moto wa nafunzi wa darasa la saba walifunika moto kwa blanketi zito na moto ukazimika. Unafikiri ni kwanini moto ulizimika baada ya kufunikiwa?

_____

ii) John ni mwanafunzi wa darasa la tano anapenda kudadisi vitu mbalimbali, siku moja alimuuliza kaka yake anayesoma darasa la saba kuwa kwanini katika ujenzi wa reli na madaraja huacha nafasi, Jibu gani unadhani kaka yake alimjibu John?_____

iii) Zipo hatua nyingi katika uchunguzi wa kisayansi, je, kuna jumla ya hatua ngapi?
_____

6. i) Suzana alipoenda sokoni alinunua vitu vifuatavyo;- Mihogo, mahindi, ulezi na mtama.
Je, uadhani ni aina gani ya kundi la vyakula alinunua?_____

ii). Nini kazi ya kundi la chakula kilichonunuliwa na Suzana katika swali la 6 (i) mwilini?_____

iii) Kwa kurejea swali la 6(i) mmeng'enyo wa chakula hicho unadhani unaanzia wapi?
_____

iv) Elezea kazi ya madini ya kalsiamu katika mwili wa binadamu _____

SEHEMU C
KUFAFANUANAKUKOKOTOA
Jibu maswali yafuatayo kwa usahihi

7.i) Eleza kanuni ya Archimedes _____

ii) Tafuta ujazo ikiwa Tungamo ni kg/m^3 40 na uzitoni kg 320_____

iii) Ili kitu kiweze kuelea au kuzama kina sababishwa na sababu mbali mbali ikiwemo tungamo la kitu chenyewe na
a) _____
b)_____

8. chunguza mchoro ufuatao kisha jibu maswali hapo chini.

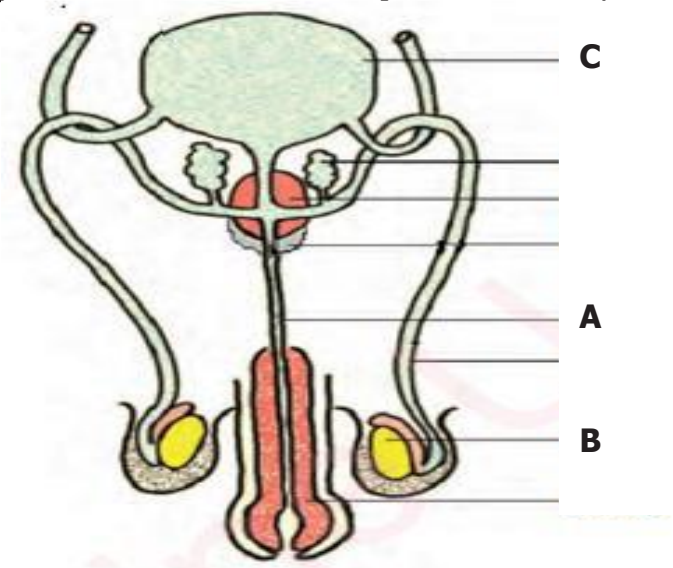

i) Sehemu A katika mchoro inawakilisha nini?_____

ii) Nini kazi mbili za sehemu iliyooneshwa kwa herufi B?
a) _____(b) _____

THE UNITED REPUBLIC OF TANZANIA
PRIME MINISTER'S OFFICE REGIONAL ADMINISTRATION AND LOCAL GOVERNMENT

CHAMWINO DISTRICT COUNCIL

ASSESSMENT EXAMINATION-STANDARD SEVEN

SCIENCE AND TECHNOLOGY

Time: 1: 30 Hours **APRIL,2026**

INSTRUCTIONS

1. This paper consists of sections **A**,**B and C** with a total of **Eight (8)** questions.
2. Answer **all** questions in each section.
3. Write your answers in the space provided in each question.
4. All answers must be written in **blue** or **black** pen.
5. Cellular phones, and any unauthorized materials are not allowed in the assessment room.
6. Write your **Number and Name of your School** in the space provided.

FOREXAMINERS' USE ONLY		
Question Number	**Score**	**Examiner's In itials**
1		
2		
3		
4		
5		
6		
7		
8		
Total		
CHECKER'SINITIALS		

SECTION A

1. Choose the correct answer and write its letter in the brackets given.

i). Maize, sorghum, wheat and rice are examples of plants that are classified as_____ plants

a)Dicotyledon b) monocotyledons c) seeds
d)non-flowering plants e) insemination [ ]

ii). Animals are divided into two major groups, which one is found mostly in the environment we are living?

a) Mammals b) invertebrates c) vertebrates
d) birds e) fish [ ]

iii). When Kataba was measuring the temperature of his brother, he used a thermometer and found his brother had 4^0C Temperature, if he converted into Fahrenheit, what was his answer?

a)96^0F b)32^0F c)104^0F
d)40^0F e)39.2^0F [ ]

iv) When water is combined with carbon dioxide in the presence of sunlight and chlorophyll can lead to the process called _____

a) Phototropism b)photosynthesis c)transpiration
d)osmosis e)diffusion [ ]

v) As an expert of information and technology, if you have been informed to advise the weather forecasting on the best antenna to be used for forecasting, which type of an antenna would you advise them to use?

a) Yagi-uda b) Loop antenna c)dish
d)microstrip e) aperture antenna [ ]

vi) Areas which require eyes protection in order to protect eyes from being affected are placed with signs that shows;

a) Protection of eyes and face b) it is harmful c)eye protection
d)danger e)skin rashes [ ]

vii) Which among the following demonstrate Archimedes principle?

a)Upthrust=weight in air- weight in fluid b)density=$\frac{mass}{volume}$

c) Weight=mass x acceleration d)V=IR
(e) Work done =Force x disistence [ ]

viii) Which colour is used for mandatory signs?

a) Yellow b) red c) blue
d) green e) purple [ ]

ix) Madam Sara found a standard six boy warming his body near the source of fire. Which method of heat transfer did the heat energy reach the body of that boy?

a) Convection b) radiation c) conduction
d) radiant e) rays [ ]

x) The sensory organ that is responsible for the sensing hotness and coldness is called_____

a) eye b) ear c) tongue
d) skin e) nose [ ]

2. Match the items in section A with their correspondings from section B by writing the correct answers in the answer grid.

SECTION A	SECTION B
i. Water pollution ii. A disease caused by shrinking of red blood cell iii. To prepare examination results iv. An example- of a complex machine v. Fish, milk and beans	A. Central processing unit B. Flowing of sewage from toilets and industrial chemicals C. Microsoft excell D. Sickle cell anemia E. Fats F. Proteins G. Computer H. Leukemia I. Blender and bicycle

Answer grid

SECTION A	i	ii	iii	iv	V
SECTION B					

2. Choose the most correct word from the box and then fill in the gaps below.

Artery, Vein, kidney, Alveoli, Capillary

a. The place where blood exchange between veins and arteries occurs is_____

b. The place where blood is filtered and removing wastes is called_____

c. Blood vessel that is used in transporting deoxygenated blood is called _____

d. Blood vessel that is used in transporting oxygenated blood is called _____

e. The place where carbondioxide is removed and oxygen is absorbed by the blood is called_____

SECTION"B"

Write short answer according to the instruction given in each question.

4 i) The science teacher at Maweni Primary school wanted to arrange the Pupils monthly test results by using Microsoft excel. Which part of a computer used as a brain? _____

ii) A collection of programs that instructs the computer to perform its task is called_____

iii) Mwita opened a bank account at Tarime when he visited Tanga NMB Bank he found all his details there, which type of network does the bank use?

_____

5 i) When standard seven pupils doing an experiment of extinguishing fire, they covered it with a blanket, and then extinguished. Why fire extinguished after being covered with the blanket?

_____

_____

ii) John is a standard five pupil who likes to study by inquiring, one day he asked his brother a who is in standard Seven, why there are gaps left during construction of railway and bridges, which answer was given to John by his brother?

_____

_____

iii) There are several steps of scientific investigations, as an upcoming scientist how many steps are there in scientific investigations?_____

6 i) when Suzan went to the market, she bought the following items; Cassava, Maize, Sorghum and millet, which group of food did she buy?_____

ii) What is the function of the food in the body bought by Suzan? in question 6(i),

_____

iii) Where does the digestion of the mentioned food in question 6 (i) starts?

_____

iv) Explain the function of the calcium minerals in the human body.

_____

_____

SECTION C
INTERPRETATION AND CALCULATION
Answer the following questions accordingly.

7 i) State the Archimedes principle _____
_____

ii)The density of an object is 40kg/m^3. If its mass is 320kg.Find its volume
_____
_____

iii) In order for an object to float or sink in water there are several reasons such as density of the object and
a) _____
b)_____

8. Study carefully the diagram drawn below and then answer the questions that

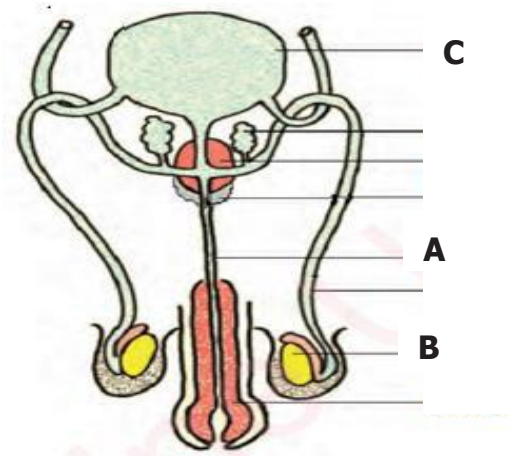

i) How do we call a part labeled by letter A in the diagram above?_____

ii) Mention two functions of the part labeled by letter B
A)_____

B)_____

THE UNITED REPUBLIC OF TANZANIA

PRIME MINISTE'S OFFICE REGIONAL ADMINISTRATION AND LOCAL GOVERNMENT

CHAMWINO DISTRICT COUNCIL

COUNCIL ASSESSMENT EXAMINATION: STANDARD SEVEVEN

SOCIAL STUDIES AND VOCATIONAL SKILLS

Time: 1: 30 Hours **APRIL, 2026**

INSTRUCTIONS

1. This paper consists of sections A,B and C with a total of Seven(7) questions.
2. Answer all questions in each section.
3. Write your answers in the space provided in each question.
4. All answers must be written in blue or black pen.
5. Cellular phones, and any unauthorized materials are not allowed in the assessment room.
6. Write your **Number and Name of your School** in the space provided.

FOR EXAMINERS'USEONLY		
Question Number	**Score**	**Examiner's Initials**
1		
2		
3		
4		
5		
6		
7		
Total		
CHECKER'SINITIALS		

SECTIONA: MULTIPLE CHOICES

1.Choose the most correct answer then write its letter in the brackets given along side.

i) The last British governor in Tanganyika was known as_____

A. Carl Peters B.Otto Von Bismarck C.Horace Byatt
D.Julius Von Soden E.Richard Turnbull [ ]

ii) In which region did Dr.Louis Leakey and his wife Mary Leakey discovered the skull of the oldest man?

A.Dodoma B.Arusha C.Kilimanjaro
D.Iringa E. Mbeya [ ]

iii) Wind is the air in motion. Which instrument is used to measure the direction of wind?

A.Anemometer B.Barometer C.Hygrometer
D.Windvane E.Rain gauge [ ]

iv) National Swahili Council (NSC) is responsible in promotining Kiswahili Language inTanzania.In which year was NSC established?

A.1984 B.1985 C.1967
D.1978 E.1996 [ ]

v) One of the strategies to struggle for independence during British colonial rule was establishment of workers' association. In which year was TAA established?

A.1922 B.1940 C.1929
D.1930 E.1925 [ ]

vi) On 26thApril, 1964 Tanganyika and Zanzibar united to form one country. Who as the first President of the United Republic of Tanzania?

A.Ally Hassan Mwinyi B.Benjamin William Mkapa C.Sheikh Abeid Karume
D.Samia Suluhu Hassan E.Julius Kambarage Nyerere [ ]

vii) Mwalimu Nyerere Hydro-electric dam is among the largest hydro-electric dams in Tanzania. In which region is this dam found?

A.Pwani B.Tanga C.Arusha
D.Dodoma E. Mtwara [ ]

viii) A standard six teacher was explaining about three types of map scales. Which type of map scale is used to represent large areas like country and continents?

A.Large map scale B.Small map scale C. Medium map scale
D.Sentence map scale E.Ratiomap scale [ ]

ix) Solar system consists of eight planets.Which is the largest planet in the solar system?

A.Earth B.Saturn C.Jupiter
D.Mercury E. Uranus [ ]

x) Teacher Juma taught standard six pupils about entrepreneurs. Which category of entrepreneur consists of four or five employees with the capital of five million shillings?

A.Small entrepreneur B.Micro entrepreneur C.Medium entrepreneur
D.Large entrepreneur E. Entrepreneurs [ ]

xi) Every society has its own traditional dances.Which is the traditional dance of the Haya?

A.Mdundiko B.Mdumange C.Akasimbo
D.Lizombe E. Mganda [ ]

xii) The Earth consists of two movements which are revolution and rotation. What is the result of the Earth's rotation?

A.Aphelion B.Seasons of the year C.Day and night

D.Lunar eclipse E.Solar eclipse [ ]

xiii) Environment is one of the important components to human being. Which among the following is the effect of environmental degradation?

A.Formation of rain B.Drying of water sources C.Growth of plants

D.Seasons of the year E. Soil fertility [ ]

xiv) Which historical site consists of the remains of early Stone Age tools?

A.Isimila B.Olduvai Gorge C. Bagamoyo

D.Amboni E. Engaruka [ ]

xv) A standard four teacher at Mtakuja Primary School was explaining about modes of production. Which is the first non-exploitative mode of production?

A.Capitalism B.Feudalism C.Communalism

D.Slavery E. Socialism [ ]

2.Match the items from column A to its corresponding response from column Band write its letter in the space provided (i - v) ***1 marks for each question***

COLUMN A	**ANSWER**	**COLUMN B**
i. Tanzania has been independent since		A) W.H.O
ii. practice which protects our Nation		B) 1992
iii. The organization for refugees		C) Bathoromeo Diaz
iv. The year in which the Multiparty system was reestablished		D) Vasco Da Gama
v. The first Portuguese to reach the coast of East Africa		E) 1961
		F) Protecting National boundaries
		G) UNHCR
		H) 1995

SECTIONB: SHORT ANSWERS

3. i) There are three mains sources of water. Mention any two sources of water

a)_____

b_____

ii) Mining is the process of extracting minerals from the earth's surface. Which minerals are mined in Manyoni Singida? _____

iii) Which historical event occurred in Tanzania between 1978 and 1979?

_____

4. i) The tropical climate of Tanzania is divided in to four main climatic zones. Mention two of them;

a) _____ b)_____

ii) In which layer of the atmosphere do human activities take place in the daily life?

_____

iii) The Berlin Conference took place from 1884 to 1885. Who held it?_____

5. i) Mention two importance of ironing clothes

(a) _____

(b) _____

ii) Doreen's mother wanted to prepare a birthday cake for her daughter.Which type of cooking method would she use?_____

6. i) The tool used to measure temperature is called a Themometer. What tool is used to measure air pressure?_____

ii) How many member states are in the Southern African Development Community (SADC)? _____

7. **Study the diagram below and then answer the questions that follow:**

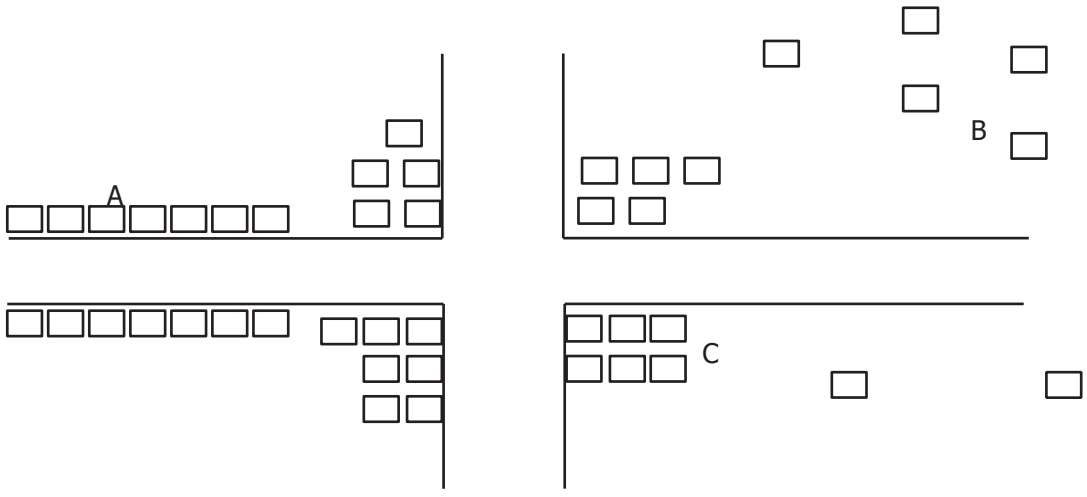

QUESTIONS

i) Identify the settlement pattern marked A. _____

ii) What is the type of settlement pattern marked B? _____

iii) List down two geographical factors which lead to the three types of settlement pattern.

a) _____

b) _____

iv) If it is 1:00 pm in town P which is located at longitude 60^0 E, what will be the time of town Q which is located at longitude 75^0 E?

_____

v) What are special clothes worn by the actors/actress on stage during performing their artistic work?_____

JAMHURIYAMUUNGANOWATANZANIA

OFISIYA WAZILI MKUU,TAWALA ZA MIKOA NA SERIKALI ZA MITAA

HALMASHAURIYA WILAYA CHAMWINO

MTIHANIWAUTAMILIFU-DARASALASABA

MAARIFA YA JAMII NA STADI ZA KAZI

Muda:SAA1:30 **APRIL, 2026**

MAELEKEZO

1. Mtihani huu una sehemu **A**,**B naC** zenye jumla ya maswali **Saba(7)**
2. Jibu maswali **yote** katika kila sehemu
3. Majibu yote yaandikwe katika karatasi hii
4. Tumia kalamu ya wino warangi ya **bluu** au **mweusi**
5. Simu za mikononi na vifaa vingine visivyo hitajika **haviruhusiwi** katika chumba cha mtihani.
6. Andika kwa usahihi **Namba yako** na **Jinala Shule** kwenye sehemu ulizopewa.

KWAMATUMIZIYAMTAHINI TU		
NambayaSwali	**Alama**	**SainiyaMtahini**
1		
2		
3		
4		
5		
6		
7		
Jumla		
SAHIHIYAMHAKIKI		

SEHEMUA:MASWALI YA KUCHAGUA

1. Chaguaherufi ya jibusahihi zaidi kishaiandike kwenye parandesi ulizopewa.

i) Gavana wa mwisho wa KiingerezaTanganyika aliitwa nani?
A.Karl Peters B.Otto Von Bismarck C.Horace Byatt
D. Julius Von Soden E. Richard Turnbull [ ]

ii) Katika mwaka 1959 Daktari Louis Leakey na mke wake Mary Leakey waligundua fuvu la mtu wa kale katika mkoa gani?
A.Dodoma B.Arusha C.KilimanjaroD.Iringa E. Mbeya []

iii)Upepo ni hewa inayosafiri. Nikifaa kipi kinatumika kupima uelekeo wa upepo?
A.Anemometa B.Barometa C.Haigrometa
D. Kipima upepo E. Kipima mvua [ ]

iv) Baraza la Kiswahili Tanzania linahusika na kukuza lugha ya Kiswahili. Je, ni mwaka gani Baraza hili lilianzishwa?
A.1984 B.1985 C.1967
D.1978 E.1996 [ ]

v) Moja kati ya mbinu za kupigania uhuru wakati wa utawala wa Waingereza ilikuwa ni kuanzisha vyama vya wafanyakazi. Ni mwaka gani chama cha TAA kilianzishwa?
A.1922 B.1940 C.1929
D.1930 E.1925 [ ]

vi) Tanganyika na Zanzibar ziliungana tarehe 26/04/1964 na kuwa nchi moja.Nani alikuwa Rais wa kwanza wa Jamhuri ya Muungano wa Tanzania?
A.Ally Hassan mwinyi B.Benjamin William Mkapa C.Sheikh Abeid Aman Karume
D. Samia Suluhu Hassan E. Julius Kambarage Nyerere[ ]

vii) Bwawa la Mwalimu Nyerere ni mojawapo ya mabwawa makubwa nchini Tanzania. Bwawa hilo linapatikana katika mkoa gani?
A.Pwani B.Tanga C.Arusha
D.Dodoma E. Mtwara [ ]

viii) Mwalimu wa darasa la sita aliwafundisha wanafunzi wake aina za vipimio vya ramani. Bainisha aina ya kipimio cha ramani ambacho hutumika kupima maeneo makubwa kama nchi na mabara?
A. Kikubwa B.Kidogo C.Cha kati
D.Sentensi E. Uwiano [ ]

ix) Mfumo wa jua umeundwa na sayari nane.Ni sayari ipi kubwa kuliko zote?
A.Dunia B.Saratein C.Sumbura
D.Zebaki E. Zohari [ ]

x) Mwalimu Juma aliwafundisha wanafunzi wa darasa la sita makundi ya ujasiriamali biashara.Je,ni kundi gani la ujasiria mali lina wafanyakazi wasiozidi wanne na mtajiwa shilingi milioni tano?
A.Ujasiriamali biashara mdogo B.Ujasiriamali biashara mdogomdogo
C.Ujasiriamali biashara wakati D.Ujasiriamali biashara mkubwa
E. Ujasiriamali [ ]

xi) Kila jamii inangoma zake za asili. Je, ngoma inayochezwa na kabila la Wahaya inaitwaje?
A. Mdundiko B.Mdumange C. Akasimbo
D.Lizombe E. Mganda [ ]

xii) Dunia inamizunguko miwili ambayo ni kulizunguka jua na kujizungusha kwenye mhimili wake. Je, dunia inapojizungusha kwenye mhimili wake matokeo yake ni yapi?
A.Afelioni B.Majira ya mwaka C.Usiku na mchana
D.Kupatwa kwa mwezi E.Kupatwa kwa jua [ ]

xiii) Mazingira ni muhimu katika maisha ya binadamu. Ni madhara yapi hutokea iwapo mazingira hayatunzwi?

A.Kupatikana kwa mvua B.Kukauka kwa vyanzo vya maji C.Kukua kwa mimea
D.Majira ya mwaka E.Udongo kuwa na rutuba [ ]

xiv) Ni eneo gani la kihistoria lenye masalia ya zana za mawe za mwanzo zilizotumika na wakazi wa eneo hilo?
A.Isimila B.Oldu vai Gorge C. Bagamoyo
D.Amboni E. Engaruka [ ]

xv) Mwalimu wa darasa la nne katika Shule ya Msingi Mtakuja aliwafundisha wanafunzi wake mifumo mbalimbali ya maisha ambayo binadamu aliipitia. Je, mfumo wa mwanzo ambao haukuwa wa kinyonyaji uliitwaje?
A.Ubeberu B.Ukabaila C.Ujima
D.Utumwa E. Ujamaa [ ]

2. Oanisha maneno katika fungu A na B kasha andika herufi ya jibu sahihi kwene nafasi uliyopewa*(alama 1 kila swali)*

FUNGU A	JIBU	FUNGU B
i. Tanzania imekua taifa huru tangu	[ ]	(a) WHO
ii. Vitendo vya kulinda nchi yetu	[ ]	(b) 1992
iii. Shirika la wakimbizi	[ ]	(c) Bathoromeo diaz
iv. Mfumo wa vyama vingi uliazishwa Tanzania kwa mara ya pili	[ ]	(d) Vasco dagama (e) 1961
v. Mreno wa kwanza kufika pwani ya afrika mashariki	[ ]	(f) Kulinda mipaka ya nchi (g) UNHCR (h) 1995

SEHEMUB:MAJIBU MAFUPI

3. i) Kuna aina kuu tatu za vyanzo vya maji.Taja aina mbili za vyanzo hivyo vya maji
a) _____ b) _____

ii) Madini ni mkusanyiko wa maliasili zinazopatikana ardhini.Je, ni madini yapi yanayopatikana Manyoni, Singida? _____

iii) Taja tukio lakihistoria lililotokeaTanzania kati ya mwaka 1978 na 1979 ni _____

4. i) Tabia nchi ya Tanzania imegawanyika katika kanda nne za tabia ya nchi.Taja kanda mbili tu.
a) _____ b)_____

ii)Shughuli za kila siku za binadamu hufanyika katika tabaka lipi la anga hewa?
_____

iii) Mkutano wa Berlin uliofanyika mwaka 1884 hadi 1885 uliitishwa na _____

5. i) Andika faida za kupiga nguo pasi
(a) _____(b) _____

ii) Mama Dorini anataka kutengeneza keki kwa ajili ya binti yake. Ni njia gani ya upishi ambayo atatumia kuandaa keki hiyo_____

6. i) Kifaa kinachotumika kupima jotoridi ni Themometa. Je Mgandamizo wa hewa hupimwa kwa kifaa gani?._____

ii) Jumuiya ya Kusini mwa Afrika (SADC) inajumla ya wanachama wangapi?_____

SEHEMU C

7. Chunguza mchoro ufuatao kisha jibu maswali yanayofuata

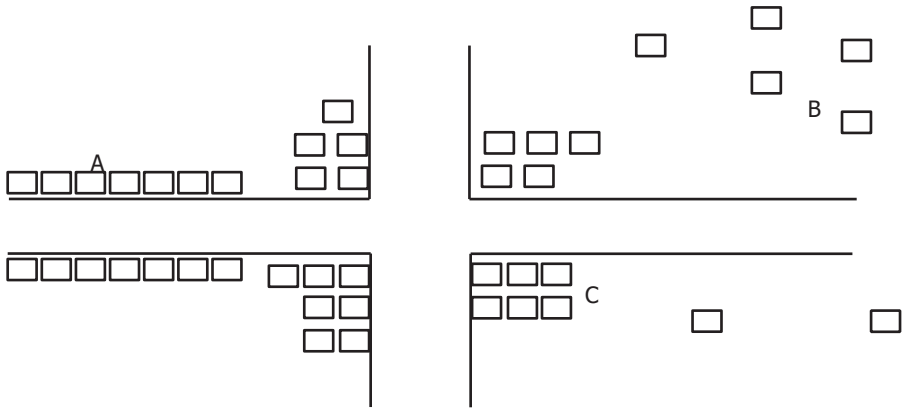

MASWALI

i) Ni aina gani ya makazi huoneshwa kwa herufi A? _____

ii) Ni aina gani ya makazi huoneshwa kwa herufi B? _____

iii) Taja sababu mbili za kijiografia zinazosababisha kutokea kwa aina tatu za makazi

a) _____ b) _____

iv) Ikiwa ni saa7:00 mchana katika mji P uliopo longitudo nyuzi 60^0 Mashariki. Je,itakuwani saa ngapi katika mji Q uliopo longitudo nyuzi 75^0 Mashariki._____

v) Mavazi maalum yavaliwayo na msanii au wasanii wanapofanya onyesho yanaitwaje?_____

LISTENING SKILLS
ENGLISH LANGUAGE
STANDARD VII – TRIAL LISTENING SKILLLS

Once a rabbit lived near a deep river. One day a hungry crocodile saw that Rabbit and wanted to eat it. The Crocodile said. "Come closer, little Rabbit you are my best friend." The Rabbit knew it was a trick. Rabbit thought fast and said "I will, but first, close your eyes and count to ten". The Crocodile closed its eyes while counting to ten. The Rabbit ran away quickly into the forest. When the Crocodile opened eyes, the Rabbit was already gone! The Crocodile felt foolish and the clever rabbit was safe.

STADI ZA KUSIKILIZA
KISWAHILI
DARASA LA VII
MTIHANI WA MAJARIBIO

Sikiliza kwa makini hadithi utakayosomewa na msimamizi kisha jibu swali la 1 hadi 5 kwa kuandika herufi ya jibu sahihi kwenye kisanduku.

Familia ya mzee Warioba ina watu sita. Watoto wawili wavulana, Joshua na Amani na wasichana wawili, Aisha na Ashura. Mtoto wa kwanza kuzaliwa ni Aisha na wa mwisho yaani kitinda mimba ni Amani. Ashura amezaliwa kati ya Joshua na Amani. Watoto wote wa mzee Warioba wamesoma hadi kidato cha sita. Kila mmoja ana kazi yake ya kuajiriwa. Amani ni rubani na Ashura ni muuguzi. Waliobaki ni walimu.

THE UNITED REPUBLIC OF TANZANIA
PRIME MINISTERS OFFICEREGIONAL ADMINISTRATION AND LOCAL GOVERNMENT
CHAMWINO DISTRICT COUNCIL

ASSESSMENT EXAMINATION-STANDARD SEVEN

ENGLISHLANGUAGE

Time:1Hour 40 Minutes **APRIL, 2026.**

INSTRUCTIONS

1. This paper consists of sections **A**,**B and C** with a totalof **Seven (7)** questions.
2. Answer **all** questions in each section.
3. Write your answers in the space provided in each question.
4. All answers must be written in **blue** or **black** pen.
5. Cellular phones and any unauthorized materials are not allowed in the assessment room.
6. Write your **Number and Name of your School** in the space provided.

FOREXAMINERS' USE ONLY		
Question Number	**Score**	**Examiner's Initials**
1		
2		
3		
4		
5		
6		
7		
Total		

CHECKER'S INITIALS		

SECTION A:COMPREHENDING ORAL INFORMATION, GRAMMAR AND VOCABULARY

2. Listen to the passage read by the invigilator and then answer the following questions.

(i) Where did the Rabbit live? _____

(a) In a cave (b) Near a deep river (c) on a mountain
(d) In a farm (e) In the desert [ ]

(ii) Why did the Crocodile wanted the Rabbit to come closer?

(a) Wanted to play (b) To help little Rabbit
(c) Wanted to eat it (d) To give it food
(e) To teach it swimming [ ]

(iii) What did Rabbit tell the Crocodile to do? _____

(a) Sleep (b) Count to ten (c) Jump in ariver
(d) Dance (e) Close ears [ ]

(iv) What did the Rabbit do while the Crocodile had his eyes closed?

(a) Slept (b) Jumped into the river (c) Ran away
(d) Climbed a tree (e) Hide in a tree [ ]

(v) How did the Crocodile feel at the end? _____

(a) happy (b) Proud (c) Excited
(d) Foolish (e) Angry [ ]

3. Complete the following sentences with the correct verb from the choices given.

i) We _____ our new class monitor next week.
(a) would elect (b) shall elect (c)have elected
(d)elect (e) elects [ ]

ii) In some African traditions, the young people are the ones who _ the elders
(a)great (b)greats (c) greet
(d)greets (e) greeting [ ]

iii) Mnali____ his friend Makanja when he was going to the party.
(a)was meeting (b)meeting (c) met
(d)is meeting (e) meets [ ]

iv) Azam sports club _____ the match last Sunday.
(a)win (b)has win (c) wining
(d)wins (e) won [ ]

v) Ali said, "I' m much better". The indirect speech of this sentence will be;
(a) Ali said he is much better (b)Ali said that he was much better
(c)Ali said that she was better (d)he was doing well
(e)Ali said that he is much better [ ]

4. Fill in the blank spaces with the correct answer (word) in the box below and complete the sentences.

most handsome, as, from, to, Didn't they, Did they, that, for, yet

i) He is _____ bright as his sister.

ii) I am so happy _____ I cannot stay without laughing.

iii) This is the _____boy in our class.

iv) A car is different _____ a bicycle because it has four wheels.

v) Dad and mom went to the market yesterday _____?

5. Match the following items List A with those in List B togive the correct meaning by using letter A-E.

LISTA		**LISTB**
i) Prefer.....to	[ ]	A. take care of
ii)		
iii) Beside	[ ]	B. in addition to
iv) Besides	[ ]	
v) Look after	[ ]	C. like most
Look for	[ ]	D. find
		E. nearby
		F. offset

SECTION B:

6. Fill in the blank with the correct answers

i) "That pencil belongs to me. It's _____", Said Awadhi.

ii) They are proud_____ taking advice.

iii) She is good _____ Mathematics.

iv) If he starts today, he will finish tomorrow. This statement is in which type of conditional?

_____

v) Complete the following proverb;"Bad news travel_____

7. Recite the poem below and answer the questions that follow.

Life is like the sun; it sets and rises
To mark the new beginning
We would wish you to stay
But the new beginning matter the most

As we bid you goodbye
A piece of advice seems important
Be a good example where very outré
That is the real value of **education**

Questions;

i) According to the writer life is like the sun because it_____ and _____

ii) Which piece of advice was given to the pupils?_____

iii) According to the first stanza _____ is compared to the sun.

iv) In which part of speech is the word **Education** _____

v) Mention one figure of speech used in a poem _____

SECTION C. COMPOSITION

7. Complete the following format of formal letter with correct parts of official letter.

(i)_____

Date.

Receivers' address

(ii)_____

(iii)_____

(iv)_____

The end of the letter

(v)_____

JAMHURI YA MUUNGANO WA TANZANIA OFISI YA WAZILI MKUU
TAWALA ZA MIKOA NA SERIKALI ZA MITAA

HALMASHAURI YA WILAYA YA CHAMWINO

MTIHANI WAUTAMILIFU-DARASA LA SABA

URAIA NA MAADILI

Muda: SAA1:30 **APRIL,2026**

MAELEKEZO

1. Mtihanihuuunasehemu**A**,**B na C** zenyejumlayamaswali**Sita(6)**
2. Jibumaswali**yote** katikakilasehemu
3. Majibu yote yaandikwekatika karatasihii
4. Tumia kalamuya wino warangiya**bluu**au **mweusi**
5. Simu za mikononinavifaavinginevisivyohitajika**haviruhusiwi**katikachumba cha mtihani.
6. Andika kwausahihi**Namba yako**na**Jinala Shule** kwenyesehemuulizopewa.

KWAMATUMIZIYAMTAHINI TU		
Namba yaSwali	**Alama**	**Saini ya Mtahini**
1		
2		
3		
4		
5		
6		

Jumla		
SAHIHI YA MHAKIKI		

SEHEMUA: MASWALI YA KUCHAGUA

1. Chaguajibusahihikwakuandikaherufiyajibukatikaparandesiulizopewa.

i) Vyombovyausafirikama vile melinandegehuwanaalamayabenderaya Taifa la Tanzania. Hii inamaanishanini?
A.Vinatoka Tanzania au nimaliya Tanzania B.Vinatumika Tanzania tu
C. Vimenunuliwa Tanzania D.Vimezalishwa Tanzania
E. Hutumiwanawatanzaniatuwanapokuwanjeya Tanzania [ ]

ii) Chimbuko la sheria zote Tanzania ninini?
A.Fedhaya Tanzania B.Bunge la JamhuriyaMuunganowa Tanzania
C.Vyamavyasiasa D.Benderaya Taifa
E.Tunu za Taifa [ ]

iii) Nisiku ganiambazoviongozihupatafursayakuelezeamafanikionachangamotozinazohitajikufanyiwa kazi?
A.Siku za kukimbiza mwenge wa uhurutu B.Sikukuuyamapinduzitu
C. Sikukuu za kitaifa D.Sikukuuya uhurutu
E.Maadhimishoyasabasabatu [ ]

iv) Mwenge wa uhuru nimojawapoyatunu za Taifa letu. Je, mwenge uliwashwakwa mara ya kwanza mwakagani?
A. 9/12/1962 B.9/12/1961 C. 26/4/1964 D.7/4/1972 E. 9/12/1963 [ ]

v)Shule nzurihutambuliwakwasifazipi?
A. Mazingiramazuriambayohuvutiawanafunzi
B. Matokeomazurikatikamitihaninanidhamuyawanafunzi
C. Kuwahikwendashuleni
D. Utoajiwahudumayachakulashuleni
E. Michezokwawingi [ ]

vi) Lipi katiyayafuatayosiolengosahihi la elimuyaafyayauzazi?
A. Kusaidiakuondoamilapotofuzinazoathiriafyayauzazi
B. Kupunguzaidadiyawatuwasionaajiraduniani
C. Kuepushamimba za utotoni
D. Kujengeavijanauwezowakukabilianamabadilikoyamwilikatikamakuzi
E. Kuwaandaavijanakuwawazazi bora wabaadae [ ]

vii) Tunawezajekuwasaidiawenzetukutohatarishausalamawao?
A. Kwakuwamfano bora kwavitendovyetu
B. Kwakuwaachawaendeleenauzembewao
C. Kwakuwasifia kwaubayawatabiayao
D. Kwakuwaingizakatikamatumiziyamadawayakulevya
E. Kwakuwafunguliamashtaka[ ]

viii)Namna bora yakushirikiananamajiranizakounapokuwanyumbani?
A. Kuwakimbiawanapokuwanashida
B. Kutowapokeamizigo

C. Kujumuikanaokatikamatukioyashidanaraha
D. Kuwakwepa pale wanapoombamsaada
E. Kwa kutowasaidiawahitaji [ ]

ix) Nini nimadharayavitendovyakikatilikatika familia;
A.Vifonakushirikiana B.Kuvunamazaomengi C.Kuwafundishanakuwapiga
D.Kusambaratikakwa familiaE.Upendo katika familia [ ]

x) Nivifaavipikatiyavifuatavyohavitumikikatikazoezi la uzimaji moto nauokoaji?
A.Machela B.Ndooyamchanga C. Jembe nashoka
D.Mtungiwakuzimia moto E.Gari la wagonjwa [ ]

2. Oanisha sentensi za sehemu A namanenokutokasehemu B kishauandikejibusahihi.

Na.	SEHEMU A	MAJIBU	SEHEMU B
i)	Mhimiliwauongoziunaohusika Na kutunga sheria	[ ]	A. Serikali
ii)	Anayeteuliwa na Rais na Kupitishwa na Bunge	[ ]	B. Mahakama
iii)	Kazi yakenikutafsiri sheria na Kutoahakisawakwaraia wote	[ ]	C. Wabunge
iv)	Wawakilishiwa wananchi	[ ]	D. Bunge
v)	Kutoaelimu, huduma za afya Pamoja na maji kwa wananchi	[ ]	E. Waziri Mkuu F. Demokrasia G. Jeshi la Polisi

3. Jibumaswalikwakuchaguajibusahihikutokakwenyekisandukukishaujaze nafasizilizowazi.

Baba na mama,Malawi,urejelezaji, familiapana,2007, JamhuriyaKidemokrasiayaKongo, utiiwa sheria zashule, 2005,anapendakusifiwa, Somalia

i) JeshilauokozinakupambananamajangayamotonchiniTanzanialiliundwa mwaka_____

ii) Kitendo cha kutumia taka kuzalishamalighafimpyahujulikanakama_____

iii) WaanzilishiwaJumuiyaya Afrika Masharikini Tanzania, Kenya na Uganda. Ni nchiipi imejiunganaumojahuuhivikaribuni? _____

iv) Johnnimwanafunzianayefikashulemapemakilasiku,kitendohikikinaitwaje?

_____

v) Mjomba,shangazi,bibinawazaziwanguwanaishikatikanyumbamoja.Je,hiiniainaganiya familia? _____

SEHEMU B

4. Jaza nafasizilizoachwawazikwakuandikajibusahihi.

i) Nitaasisigani Zanzibar inafanyakazisawasawanaTumehuruya Taifa yauchaguzi?_____

ii) Mtuanayeongozawenzakeilikufikialengoanajulikanakama_____

iii) Rais mteulewaJamhuriyaMuunganowa Tanzania anaapishwananani?_____

iv) Ni kiongoziganianayehusikanakusajilivifonavizazikatikangaziya Wilaya?_____

v) Eneo la kiutawalaambalonikubwakuliko kata nanidogokuliko wilaya huitwa_____

5. Panga upyaorodhaya siku kuuzinazoadhimishwakitaifanchini Tanzania kulingananatarehe, mwezikwamwakamzimakwakuzipaherufi A, B, C, D,E.

i) SikukuuyaWakulima Tanzania[]

ii) Uhuru wa Tanganyika []

iii) Kumbukumbuya siku yaMapinduziya Zanzibar[]

iv) Kumbukumbuyakifo cha Rais wa kwanza wa ZanzibarSheikh Abeid Amani Karume.[ ]

v) Kumbukumbuyakifo cha Rais wa kwanza wa TanzaniaMwalimu Julius Kambarage Nyerere []

SEHEMU C:

6. Angalia mchoroufuataokwamakinikishajibumaswaliyanayofuata.

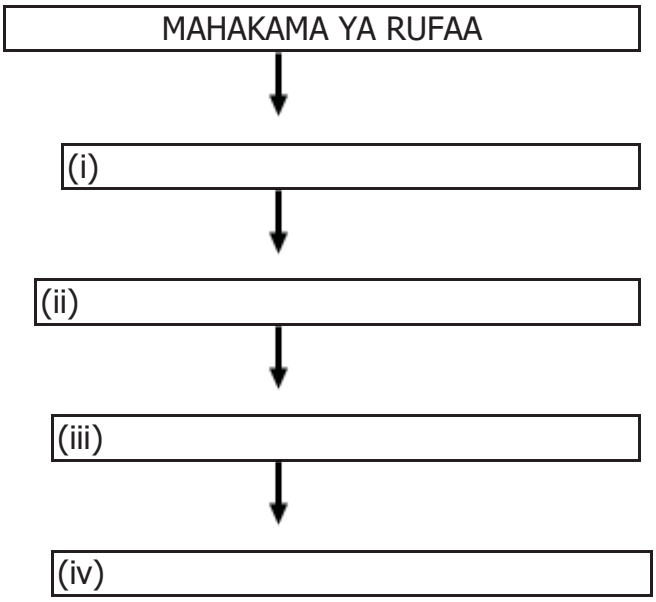

(v) Nimahakamaipikatikangazi za kimahakamahusikilizakesiza mauaji?_____

JAMHURI YA MUUNGANO WA TANZANIAOFISI YA RAIS TAWALA ZA MIKOA NA SERIKALI ZA MITAA

HALMASHAURI YA WILAYA YA CHAMWINO

MTIHANI WA UTAMILIFU -DARASA LA SABA

HISABATI

Muda:Masaa2 **APRIL,2026**

MAELEKEZO

1. Mtihanihuuunasehemu**A**,**Bna C** zenyejumlayamaswali**Nane(8)**
2. Jibumaswali**yote** katikakilasehemu
3. Majibu yote yaandikwekatikakaratasihii
4. Tumia kalamuya wino warangiya**bluu**au **mweusi**
5. Simu za mikononinavifaavinginevisivyohitajika**haviruhusiwi**katikachumba cha mtihani.
6. Andika kwausahihi**Namba yako**na**Jina la Shule** kwenyesehemuulizopewa.

KWAMATUMIZIYAMTAHINI TU		
NambayaSwali	**Alama**	**SainiyaMtahini**
1		
2		
3		
4		
5		
6		
7		
8		
Jumla		

SAHIHIYAMHAKIKI		

NA.	SWALI	KAZINAJIBU
1.	**SEHEMU A : MATENDO YA KIHISABATI**	
	i) 423 x 427 =	
	ii) 13425 – 7619 =	
	iii) 585 ÷ 15 =	
	iv) 12.5 x 86 =	
	v) 94632+ 967 =	
	vi) $3\frac{3}{5} + 1\frac{2}{3}$ =	
	vii) 2.4 ÷ 0.0008=	
	viii) $\frac{1}{3}$ x 72=	
	ix) 70.025 - 20.996 =	
	x) $9\frac{1}{4} \div 3\frac{1}{3}$ =	
2.	i) **SEHEMU B: MAFUMBO** Kadiria 396,534 katikamakumi Elfuyaliyokaribu	
	ii) Tafutanambainayofuatakatikamfuatanohuu 1, 4, 9, 16, 25, ____	
	iii) Andika thamaniya 6 katikanamba 436721.	
	iv) Kadirianambaifuatayokatikanafasimbili za desimali 1.4504.	
	v) Shule inawanafunzi 362. Andika nambahiyokwakirumi.	
	vi) Ipi ninambakubwakatiyahizi $1\frac{3}{4}$ na $1\frac{1}{2}$?	
3.	i) Badili0.125kwasehemurahisi.	
	ii) Watoto watatuwaliendamtonikuchotamaji, mtotowakanzaaliendakilabaadayadakika 10, wa pili kilabaadaya dk15, nawatatukilabaadaya dk 20, kamawalianzakuchotamajinakuondokamtonikwapamoja. Je, iliwachukuamudaganikukutanawotepamojamtoni?	
	iii) Ni nambaganikubwaambayoinagawanya 18,36 na 27 bilabaki?	

4.	i)	Ikiwa, a=-2nab=3.Tafutathamaniya $\frac{ab^2 - b+3}{ab + b}$	
	ii)	Wataliiwaliwasilikatikauwanjawa KIA saa 0100. Andika mudahuokwaMtindowamasaa 12.	
	iii)	Jumla yanamba tatu zinazofuatanani 57, tafutajumlayanambandogonanambakubwa.	
5.	i)	Kokotoa 4 x 5 +(14 + 8) - 36÷9 =	
	ii)	Asha aliwekafaidakiasi chaTsh 180,000/= katikaBenkiinatoaribaya 8% kwamwaka, Atapatafaidaya shilingi ngapi kwamiaka5?	
	iii)	Gari ilisafiriumbaliwa km 480kwasaa 8 Tafutamwendokasiwagarikwa km/ saa.	
6.	i)	Shuleinawanafunzi320,kama $\frac{3}{4}$ya Wanafunziwoteniwasichana.TafutaIdadiyawavulanakatikashulehiyo.	

NA.	SWALI	KAZINAJIBU
	ii) Pembe katikapembetatu zina uwianowa 9:10:11.Tafutaukubwawapembendogo zaidi.	
	iii) Tafutatofautikatiyakipeuocha pili cha81na 64	
7.	i) **SEHEMUC:TAKWIMUNAMAUMBO** Tafutamzingowa umbo hili. Sm (3x+2)  Sm 8 Sm (x+6)	

	ii) Katika kielelezo cha takwimukwaduara, jumlayamifugoya mzee Chongoloni 640. Tafutaidadiyambuzi wake. 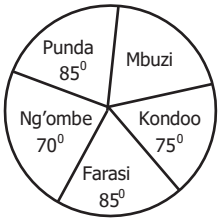 	
8.	i) Tafutaujazowamchemstatiliufuatao . 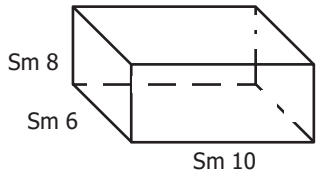 Lita 1 = Sm^3 1000	
	ii) Tafutamzingowa pembetatuifuatayo. 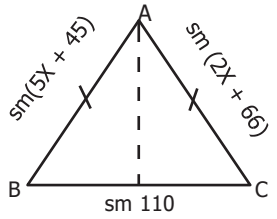 	
	iii) Juma alipewa umbo pentagon lenyepembetano. Tafutathamaniyaherufi"y" 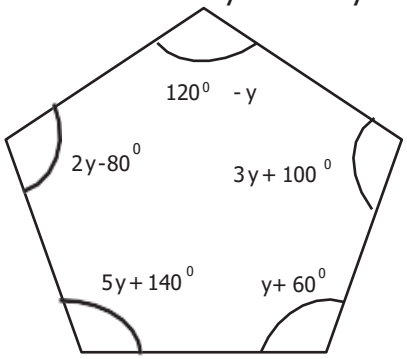 	

THE UNITED REPUBLIC OF TANZANIA

PRIME MINISTER'S OFFICE REGIONAL ADMINISTRATION AND LOCAL GOVERNMENT

CHAMWINO DISTRICT COUNCIL

ASSESSMENT EXAMINATION-STANDARD SEVEN

CIVIC AND MORAL EDUCATION

Time:1Hour30Minutes **APRIL,2026**

INSTRUCTIONS

1. This paper consists of sections **A**,**B and C** with a total of **Six(6)**questions.
2. Answer **all** questions in each section.
3. Write your answers in the space provided in each question.
4. All answers must be written in **blue** or **black** pen.
5. Cellular phones and any unauthorized materialsare not allowed in the assessment room.
6. Write your **Number and Name of your School** in the space provided.

FOREXAMINERS'USEONLY		
QuestionNumber	**Score**	**Examiner'sInitials**
1		
2		
3		
4		
5		
6		
Total		
CHECKER'SINITIALS		

SECTIONA:MULTIPLECHOICES

1. Choosethemostcorrectanswerfromthegivenalternativesthenwriteitsletterin the brackets given.

i) The national flag on Tanzanian transport vessels like ships andaeroplanes signify that _

A. They come fromTanzania and areowned byTanzania
B. They are used in Tanzania only
C. They are bought from Tanzania
D. They are manufactured from Tanzania
E. They are used byTanzanians only when they are out side [ ]

ii) What aresource of all laws in Tanzania? _

A.The Tanzanian currency B.The Parliament of the United Republic of Tanzania
C. The political parties D. National Flag
E. National values [ ]

iii) On which occasiondonational leaders get opportunities to talkaboutnational achievements and development challenges to be addressed?

A.Only during uhuru racetorch B.Zanzibar revolution only
C. National festivals D. Independence day
E. Sabasaba day only [ ]

iv)Uhuru torchis one among our national symbols.When was Uhuru torchlit for the first time?

A.9thDec1962 B.9thDec 1961 C.26thApril1964
D. 7thApril1972 E. 9thDec1963 []

v)Which featuresmark a good school?

A. A good environment that attract pupils
B. Good performance in national examinations and discipline
C. Punctuality
D. Provision of food at school
E. Availability of sports and games [ ]

vi) Which of the following statements is not one of the objectives of providing reproductive heath education?

A. Helping to eliminate wrong beliefs that effect reproductive health
B. Reducingthenumberofunemployedpeopleintheworld
C. Preventingearlypregnancies
D. Building the capacity of the youth to cope up with the changes that may occursto their bodies as they grow up
E. To prepare the youth to be good parentsin future [ ]

vii) How can we help our friend to stop endangering their lives?_____

A.Beingagoodexampletothem B.Leaving themtocontinue with their negligence
Praising their bad behavior D.Involving themindrug abuse
E.Sending them to the court [ ]

viii) A good way of cooperating with neighbors is _

A.Running away from their problems B.Not assisting them in carrying luggage

C. Participating in social events D.Not paying attention to request for help E.Not helpingthe needy [ ]

ix) What results from acts of cruelty in the family;
A.Death and cooperation B.Harvesting many crops C. Teaching and beating themD.Divorce E.Love with in the family [ ]

x) Which of the following tools are not used in fire and rescuer operation?
A.Stretcher B.Abucket of drysand C.Hoeand axe
D. Fire extinguisher E. An ambulance [ ]

2.Match the items in Column A with those in column B by writing correct answers.

No	COLUMN A	ANSWER	COLUMN B
i)	A branch of state which is responsible for enactinglaws	[ ]	A. The Government
ii)	Appointed by the President And approved by the Parliament	[ ]	B.The Judiciary C.Membersof the Parliament
iii)	Interprets lawsand provides equalrights to all citizens	[ ]	D. The Parliament E.The Prime Minister
iv)	Citizens'representatives	[ ]	F.Democracy
v)	Provides education, health Services and water to citizens	[ ]	G.The Police Force

3.Choose the correct answer from the given box thenfill the spaces provided.

Couple family, Malawi, Recycling,Extendedfamily, 2007,DRC, 2005, Obeyingschoolrules, liketobe praised, Somalia

i) Fire and rescue operations inTanzania was formed in the year

_____

ii) The action of using waste products to form new products is referredto as_____

iii) The founders of East African Community were Tanzania, Kenya and Uganda. Which country joined this community recently? _____

iv) John is apupil who arrivesat school very early every day.How is this actcalled?_____

v) Uncle, aunt, grandmother and my parents are all living in one house. What type of family is this? _____

SECTION B:

4.Fillin the blank spaces below by writing the correct answer.

i) Which organin Zanzibar plays the same role as Independent National Electoral Commission (INEC)? _____

ii) A person who leads others to achieve their goals is known as _____

iii) The newlyelected president of the United Republic of Tanzania swornby_____

iv) Which leader is responsible for registering birth and death information atadistrict level? _____

v) Anadministrative area which is bigger that the ward but smallerthan adistrictis known as _____

5.Rearrange the following National festivals in correct order by considering date and month when we commemorate by giving letter A, B, C, D and E.

i) Farmers'Day

ii) The Independence Day

iii) Zanzibar Revolution Day

iv) The Death of Sheikh Abeid Amani Karume

v) The death of the first President of Tanzania Mwalimu Nyerere

SECTION C

6.Study the diagrambelow then answer questions that follow.

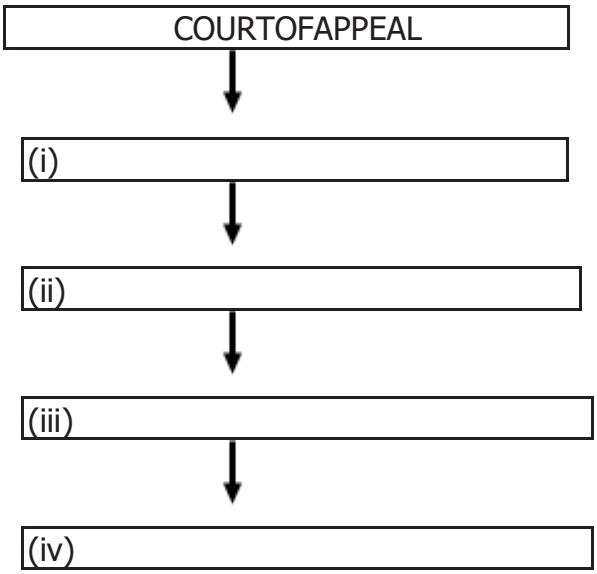

(v) At which level of court are murder cases heard? _____

THE UNITED REPUBLIC OF TANZANIA

PRIME MINISTER'S OFFICE REGIONAL ADMINISTRATION AND LOCAL GOVERNMENT

CHAMWINO DISTRICT COUNCIL

ASSESSMENT EXAMINATION-STANDARD SEVEN

MATHEMATICS

Time:2 Hours **APRIL, 2026**

INSTRUCTIONS

1. This paper consists of sections **A**,**B and C** with a total of **Eight (8)** questions.
2. Answer **all** questions in each section.
3. Write your answers in the space provided in each question.
4. All answers must be written in **blue** or **black** pen.
5. Cellular phones and any unauthorized materials are not allowed in the assessment room.
6. Write your **Number and Name of your School** in the space provided.

FOR EXAMINERS' USE ONLY		
Question Number	**Score**	**Examiner's Initials**
1		
2		
3		
4		
5		
6		
7		
8		
Total		

CHECKER'S INITIALS		

No.	QUESTION	WORKING SPACE AND ANSWER
1.	**SECTIONA: BASIC OPERATIONS**	
	i) 423 x 427 =	
	ii) 13425 – 7619 =	
	iii) 585 ÷ 15 =	
	iv) 12.5 x 86 =	
	v) 94632 + 967 =	
	vi) $3\frac{3}{5} + 1\frac{2}{3}$ =	
	vii) 2.4 ÷ 0.0008 =	
	viii) $\frac{1}{3}$ x 72 =	
	ix) 70.025 - 20.996 =	
	x) $9\frac{1}{4} \div 3\frac{1}{3}$ =	
2.	i) **SECTION B:WORD PROBLEMS** Approximate 396,534 to the nearest ten thousand.	
	ii) Find the next number in the following pattern 1, 4, 9, 16, 25, _____	
	iii) Write the total value of 6 in 436721.	
	iv) Approximate 1.4504 in to two decimal places.	
	v) A school has 362 pupils. Write the number of pupils in Roman numbers.	
	vi) Which is the largest number between $1\frac{3}{4}$ and $1\frac{1}{2}$?	
3.	i) Convert 0.125 into simple fraction.	
	ii) Three children went to the river to fetch water. The first child went after every10 minutes, second after every 15 minutes and third after every 20 minutes. If they started fetching water and left the river at the same time. At what time they would meet again at the river?	

	iii) Which largest number can be divided to 18,36 and 27 without remainder?	
4.	i) If a=-2 and b=3. Find the value of $\frac{ab^2-b+3}{ab+b}$	
	ii) Tourists arrived at the Kilimanjaro International Airport (KIA) at 0100 hours. Write this time in 12 hours system.	
	iii) The sum of three consecutive numbers is 57. Find the sum of the smallest and the largest number.	
5.	i) Work out: 4 x 5 +(14 + 8) - 36÷9	
	ii) Asha deposited 180,000/= in a bank which pays an interest rate of 8% per annum. What interest did she receive in 5 years?	
	iii) A car travelled a distance of 480 km in 8 hours. Find the speed of the car in km/hr.	
6.	i. A school has 320 pupils. If $\frac{3}{4}$ of all pupils are girls. Find the number of boys in that school.	

	ii) Theangles of a triangle are in the ratio of 9:10:11. Find the degree measure of the smallest angle.	
	iii) Find the difference between the Square root of 81 and 64	
7.	**SECTION C. STATISTICS AND GEOMETRY** i. Find the perimeter of rectangle. (3x+2)cm  8cm (x+6)cm	

	ii) The pie chart below shows the total of 640 animals of Mr. Chongolo. How many goats does he have? 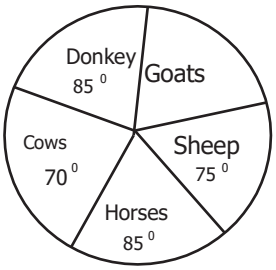 	
8.	i) Find the volume of the rectangular prism below. (1litre=1000 cm^3) 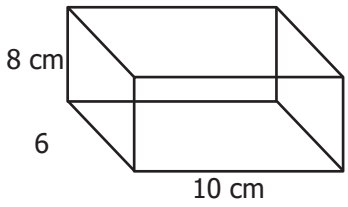 	
	ii) Find the perimeter of the following figure 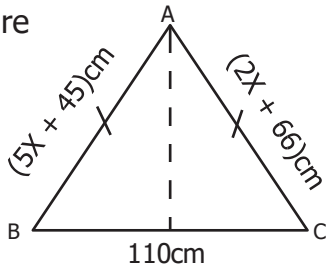 	
	iii) Juma was given apicture offive sidedpentagon as shown in the diagram below. 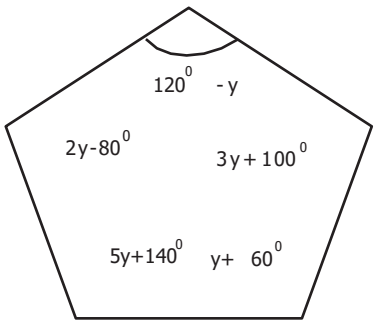 Find the value of y.	