Candidate's Name: _____

Name of School: _____

THE UNITED REPUBLIC OF TANZANIA

PRIME MINISTER'S OFFICE, REGIONAL ADMINISTRATION AND LOCAL GOVERNMENT

KIGAMBONI MUNICIPAL COUNCIL

MOCK STANDARD SEVEN

02 ENGLISH LANGUAGE

Time: 1 Hour 40 Minutes **March, 2026**

INSTRUCTIONS

1. This paper consists of sections **A, B and C** with a total of **Seven (7)** questions.
2. Answer **all** questions in each section.
3. Write your answers in the space provided in each question.
4. All answers must be written in **blue** or **black** pen.
5. Cellular phones, and any unauthorized materials are not allowed in the assessment room.
6. Write your **Number and Name of your School** in the space provided.

FOR EXAMINERS' USE ONLY		
Question Number	**Score**	**Checker's Initials**
1		
2		
3		
4		
5		
6		
7		
Total		

Scanned with CamScanner

SECTION A. (20MKS)

1. Listen attentively to the passage read to you by the invigilator then answer the questions (i)-(v)

i) What shows that people in Kimusi had suffered a lot due to lack of rains?
   a. The grazing fields were green.
   b. The grazing fields were grey.
   c. Kimusi village was blossoming with life.
   d. The only stream served both animals and humans with its water.
   e. People were planting their crops on their farms.

ii) Which one among the following signs shows no hope for rain? [ ]
   a. The sun is not as hot as usual today.
   b. The clouds are seen gathering in the sky.
   c. The clouds seem to be very dark.
   d. The sun is as hot as usual today.
   e. The drops of rain are falling. [ ]

iii) The villagers in Kimusi were advised by their elder:
   a. To move to higher grounds.
   b. To listen to him attentively.
   c. To be happy about dark clouds.
   d. To wait and see clouds portending destructive rainfall.
   e. To prepare their farms ready for farming. [ ]

iv) Mr. Chacha, the village elder can best be described as:
   a. Obedient b. Diligent c. Responsible
   d. Honest e. Greedy [ ]

v) You can advise your fellow villagers to control floods in the following ways EXCEPT:
   a. To plant more trees in order to absorb rainwater and reduce surface runoff.
   b. To dig drainage channels like ditches or trenches.
   c. Cutting down trees for charcoals and overgrazing.
   d. Harvest rainwater using tanks or barrels and also improve roads and bridges.
   e. To build small dams or embankments. [ ]

2. For each items (i)-(v), choose the correct answer and write its letter in the brackets provided.

i) He is the teacher _____ I told you about.
   a. who b. that c. whose
   d. which e. whom [ ]

ii) Had I attended the meeting, I _____ told him the truth.
   a. would have b. shall c. shall have
   d. will have e. would [ ]

iii) My children normally like eating rice and beans _____ folks.
   a. by b. in c. on
   d. at e. with [ ]

iv) Their boss' loyal dog has just cut _____ chain.
   a. it's b. it is c. its'
   d. its e. it [ ]

v) Her visit will extend _____ Monday to Friday.
   a. on b. for c. since
   d. in e. from [ ]

Scanned with CamScanner

3. For the items (i)-(v), complete the sentences by choosing the correct words given in the box.

made,	leaving,	swam,	fast,	swims,	attentively,	faster

i) He always _____ in Lake Victoria when he was young.

ii) They have _____ the worst mistake ever.

iii) I am _____ for Dodoma for a seminar this evening.

iv) The students are listening to their teacher _____

v) Julian is not a slow learner, she is a _____ learner, believe me you.

4. Match the questions in list A with their answers (vocabularies) in list B and write the letter of the correct answer in the space (ANS) provided.

	A	ANS	B
i)	A horse neighs, a goat bleats, a donkey	[ ]	A. Chevon
ii)	What do we call the young one of a sheep?	[ ]	B. kid
iii)	Pork is a pig's flesh, ... is a goat's flesh.	[ ]	C. Ewe
iv)	A lion lives in a den, a dog lives in a	[ ]	D. Brays
v)	Bitch is a female dog, ... is a female sheep.	[ ]	E. Lamb
			F. Sty
			G. Kennel

SECTION B (20 Marks)

5. Complete the following questions by writing the appropriate answers.

i) _____ he was tired, he finished his homework assignments.

ii) I was cooking potatoes _____ they were watching a match between Simba and Mtibwa Sugar on Tv.

iii) This question is too difficult _____ answer. I need a simpler one.

iv) You have to believe in _____ if you want to succeed in life.

v) That is the man _____ car was stolen by thieves.

Scanned with CamScanner

COMPREHENSION

6. Read the following letter then answer the questions that follow.

Tabata Primary School,
P. O. Box 97400,
Dar es salaam.

25th May, 2021

The Head Teacher,
Tabata Primary School,
P. O. Box 97400,
Dar es salaam.

Dear Sir,
RE: REQUEST FOR NEW FOOTBALLS
Refer to the above caption.

I am writing on behalf of class seven to kindly request new balls. The current balls are old, torn and worn out. We love playing football during break time, and it helps us keep fit.
We kindly ask for at least three new footballs to use during games and sports time. We promise to take good care of them.
Thank you for your support.
Yours faithfully,
J.K. Mwamba
Johnson Komba Mwamba
Class Monitor, Class 7

QUESTIONS

i) Who is the recipient of the above letter? _____
ii) What is the purpose of the letter? _____
iii) What title does the writer of the letter hold? _____
iv) Where is the sender's school located according to the letter? _____
v) There are two main types of letters, what type of a letter is this? _____

SECTION C: (10 Marks)

7. Arrange the following sentences in a logical flow using A-E.

i) She then sorted the clothes into whites and coloured ones to avoid mixing. [ ]
ii) Finally, she folded the dry clothes and placed them neatly in the wardrobe. [ ]
iii) Next, she washed all the clothes carefully using water, soap, and a scrubbing brush. [ ]
iv) Maria wanted to do the laundry in their house so, she collected all the dirty clothes from the bedrooms and the bathrooms. [ ]
v) When she got done with the washing, she hung the clean clothes on the line outside to dry under the sun and in the gentle breeze. [ ]

Scanned with CamScanner

Candidate's Name: _____

Name of School: _____

THE UNITED REPUBLIC OF TANZANIA

PRIME MINISTER'S OFFICE, REGIONAL ADMINISTRATION AND LOCAL GOVERNMENT

KIGAMBONI MUNICIPAL COUNCIL

MOCK STANDARD SEVEN

05E SCIENCE AND TECHNOLOGY

Time: 1 Hour 30 Minutes **March, 2026**

INSTRUCTIONS

1. This paper consists of sections **A and B** with a total of **Eight (8)** questions.
2. Answer **all** questions in each section.
3. Write your answers in the space provided in each question.
4. All answers must be written in **blue** or **black** pen.
5. Cellular phones, and any unauthorized materials are not allowed in the assessment room.
6. Write your **Number and Name of your School** in the space provided.

FOR EXAMINERS' USE ONLY		
Question Number	**Score**	**Checker's Initials**
1		
2		
3		
4		
5		
6		
7		
8		
Total		

Scanned with CamScanner

SECTION A (20MARKS)

1. From items (i)-(x) choose the letter of the correct answer and write it in the box provided.

(i) Heat from the source can travel in different matters in different ways. In which way can heat travel liquids like water?
a. By conduction b. By radiation c. By convection
d. By evaporation e. By conduction and radiation [ ]

(ii) Judith sowed maize seeds that germinated after four days. What made those seeds become seedlings?
a. Soil, water and oxygen b. Warmth, carbon dioxide and air
c. Oxygen, moisture and suitable temperature d. Water, high temperature and oxygen
e. Warmth, carbon dioxide and water [ ]

(iii) Wires that are used to fabricate antennas fitted in vehicles are made up of:
a. Aluminum b. Stainless steel c. Iron
d. Copper e. Tin [ ]

(iv) Alanus always fixes magnets on the opening edges of a refrigerator and the doors of some cabinets. What is the main reason of doing so?
a. To remove the iron nature b. To make the door stick properly
c. To provide coldness to the food staff d. To remove heat [ ]
e. To warm the outside part

(v) Sedentary workers should eat balanced diet containing high amount of fruits and fresh green vegetables since they spend most of the time seated while doing their duties. Why should they eat such foods in high amount?
a. Such foods replenish lost water
b. Such foods provide the body with energy to perform their duties
c. Such foods increase the rate of digestion process
d. Such foods increase warmth in the body
e. Such foods reduce, regulate and maintain the body weight [ ]

(vi) People living with HIV are required to use ARV effectively. Which among the following is not the importance of using the ARVs?
a. Helps to strengthens body immunity b. Helps to live normal life
c. Helps to kill the HIV d. Helps to prolong life
e. Prevents multiplication of HIV in the body [ ]

(vii) The grade four pupils conducted an experiment to confirm the requirements of seed germination. What was the fourth step of conducting the experiment?
a. Hypothesis formulation b. Conducting an experiment and collecting data
c. Preparation of materials for the experiment d.Data analysis
e. Interpretation of data

(viii) Which of the following substances contain base only?
a. Ash and soap b. Lemon and soda c. Orange and ash
d.Hydrochloric acid and ash e. Soap and lemon [ ]

(ix) Which of the following machines does not simplify work by increasing the speed and effort needed to complete work in the shortest time possible?
a. Grain milling machine b. Sewing machine c. Bicycle
d. Wheel barrow e. Blender [ ]

(x) Damian can see objects clearly although he cannot see near objects. Which type of lens can be used to correct his problem?
a. Concave mirror b. Convex mirror c. Diverging lens
d. Concave lens e. Converging lens [ ]

Scanned with CamScanner

2. Answer items (i)-(v) by matching the causes of the diseases in list A with the respective diseases in list B.

LIST A		LIST B
(i) Transport male gametes from the stigma to the ovary	[ ]	A. Pistil
(ii) Attracts insects for pollination	[ ]	B. Stigma
(iii) The female part of the flower	[ ]	C. Petal
(iv) Receive pollen grains	[ ]	D. Sepal
(v) Protect the young flower before blooming	[ ]	E. Pollen tube
		F. Receptacle
		G. Style

3. Answer items (i)-(v) by choosing the correct word from the box and fill in the blank spaces.

Mammals, reptiles, amphibians, birds, fish, invertebrates, vertebrates

(i) They have scales in their feet, warm blooded a constant body temperature of 40^0 C _____

(ii) They have dry skin, body covered with scales _____

(iii) Body covered with scale and breath using gills _____

(iv) Breastfeed their young ones with milk_____

(v) They have moist and soft skin used for gaseous exchange _____

SECTION B (20MARKS)

Answer all questions in this section

4. Mwaijengo installed an electric circuit in his house with several bulbs, unfortunately one bulb got burnt but the rest of the bulbs continued lighting.

(i) Which type of circuit did Mwaijengo install? _____

(ii) Which electrical device can be used to measure the current that flows through the circuit? _____

Scanned with CamScanner

(iii) Write the formula that can be used to calculate the value of electric current if the value of voltage and resistance are known. _____

_____

5. By considering a housefly growth stages.
   (i) What type of metamorphosis does it undergo? _____
   (ii) Name another insect which undergo a similar type of metamorphosis. _____
   (iii) What is the larva of a housefly? _____

6. Use the figure below to answer the following questions.



   (i) What is the name of the part shown by letter D? _____
   (ii) What is the function of the part shown by letter A? _____
   (iii) What is the name of the part represented by letter B? _____
   (iv) Which letter shows an output device? _____

SECTION C(10MARKS)

Answer all questions in this section

7. A figure below shows a unit for destroying wastes.

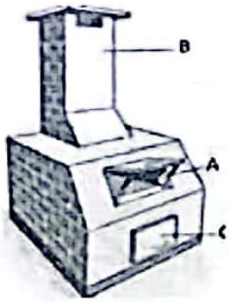

   (i) What is the name of this unit? _____
   (ii) What is the function of the part shown by latter B? _____
   (iii) The part shown by letter A is known as _____

8. (i) A source of electric current has 320volts. What amount of current will flow in a wire of resistance 40 ohms connected to this circuit? _____

   _____

   (ii) Calculate the velocity ratio of a pulley with 80% efficiency and mechanical advantage of 2. _____

   _____

   _____

Scanned with CamScanner

Jina la Mtahiniwa _____

Jina la shule: _____

JAMHURI YA MUUNGANO WA TANZANIA

OFISI YA WAZIRI MKUU, TAWALA ZA MIKOA NA SERIKALI ZA MITAA

HALMASHAURI YA MANISPAA YA KIGAMBONI

MTIHANI WA UTAMILIFU DARASA LA SABA

01 KISWAHILI

Muda: Saa 1:40 **Machi, 2026**

MAELEKEZO

1. Karatasi hii ina sehemu A, B na C zenye jumla ya maswali Sita (6)
2. Jibu maswali **yote** katika nafasi uliyopewa.
3. Majibu yote yaandikwe katika karatasi hii.
4. Majibu yote yaandikwe kwa kalamu yenye wino wa buluu au mweusi.
5. Simu za mikononi na vifaa vingine visivyohitajika haviruhusiwi katika chumba cha mtihani.
6. Andika kwa usahihi **Namba yako ya Mtihani na Jina la Shule** kwenye sehemu ulizopewa.

KWA MATUMIZI YA MTAHINI TU		
Namba ya Swali	**Alama**	**Saini ya Mhakiki**
1		
2		
3		
4		
5		
6		
Jumla		

Scanned with CamScanner

SEHEMU A UFAHAMU

1. Sikiliza habari kwa umakini kisha jibu swali la kwanza kwa usahihi kwa kuchagua herufi ya jawabu sahihi na kuandika kwenye kisanduku baada ya swali

i. Msimuliajie alitoa mbwa wa rangi gani wakimkimbiza?
(a) Weusi (b) Weupe (c) Wenye meno makubwa
(d) Rangi ya kutisha (e) Wenye kuchandefu [ ]

ii. Alihisi nini alipojaribu kukimbia?
(a) mbwa wakimkaribia (b) Miguu yake mizito (c) Kushtuka
(d) Kukasirika (e) Kuhema kwa nguvu [ ]

iii. Kitu gani kilichomfanya msimuliaji ashtuke kutoka usingizani?
(a) Mbwa wakipiga kelele (b) Honi ya basi la shule (c) Kelele za watoto
(d) Sauti ya mama yake ikimuita (e) Ndoto kukatika [ ]

iv. Baada ya kushtuka usingizini msimuliaji alikuwa katika hali gani? [ ]
(a) Alilia na kuhema sana (b) Alitweta na kutoa jasho (c) Alimuita mama yake
(d) Alikimbilia nje (e) Hali ya kutetemeka [ ]

v. Pendekeza kichwa cha habari hii
(a) Mbwa wakubwa (b) Mama na mtoto (c) Kucha ndefu
(d) Sitasahau (e) Ndoto ya ajabu [ ]

2. SARUFI, MISAMIATI NA FASIHI
JIBU MASWALI KWA KUANDIKA HERUFI YA JIBU SAHIHI KWENYE KISANDUKU

i. Kitendawili kipi kinateguliwa na picha ifuatayo



(a) Athumani kafupi ana maguu mmoja
(b) Mtoto wangu ana mguu mmoja
(c) Hana adabu wala staha kwa watu
(d) Wafu wanakokotana
(e) Mvua hema jua hema [ ]

ii. Wananchi wake hufanya kazi bega kwa bega. Nini maana ya nahau bega kwa bega?
(a) unga mkono (b) Kutegeana (c) Kushirikiana
(d) Kupendana (e) Kuoneana [ ]

iii. Jamila **amepewa** adhabu na mwalimu. Andika ukanushi wa neno liliopigiwa mstari
(a) Hapewi (b) Hakupewa (c) Huwa hapewi
(d) Hapewagi (e) Hajepewa [ ]

iv. Mimi na yeye tunafyeka nyasi uwanjani. Sentensi hii ipo katika nafasi ya ngapi?
(a) Ya pili wingi (b) Ya tau umoja (c) Ya kwanza wingi
(d) Ya tatu wingi (e) Ya kwanza umoja [ ]

v. Baba na mtoto walikuwa wanazumgumza kuhusu matokeo ya mtihani. Je, mazungumzo hayo huitwaje?
(a) Ngonjera (b) Shairi (c) Dayolojia
(d) Msamiati (e) Maelewano [ ]

Scanned with CamScanner

vi. Kiranja alituamuru tuingie darasani. Hii ni kauli gani?

(a) Halisi (b) Taarifa (c) Tata

(d) Kanushi (e) Endelevu [ ]

vii. Jambazi akamatwa na polisi. Tungo hii ipo katika hali gani?

(a) Timilifu (b) Mazoea (c) Endelevu

(d) Isiyodhihirika (e) Uliopo [ ]

viii. Sokomoko ni mwanambee wa mzee Jongo. Kipi ni kisawe cha neno mwanambee?

(a) Kifungua mimba (b) Kitindamimba (c) Chudere

(d) Wa kwanza kuzaliwa (e) Wa mwisho kuzaliwa [ ]

ix. Aina ipi ya neno inayosimama baada ya nomino?

(a) T (b) W (c) E

(d) H (e) Hs [ ]

x. Saa yangu imepoteza majira. Andika wingi wa neno saa

(a) Masaa (b) Visaa (c) Tusaa

(d) Misaa (e) saa [ ]

3. Oanisha maneno ya kifugu A na visawe vyake katika kifungu B kwa kuandika herufi ya jibu sahihi.

SEHEMU A		JIBU	SEHEMU B	
i.	Ghulamu	[ ]	A.	Furaha
ii.	Banati	[ ]	B.	Huzuni
iii.	Ngwena	[ ]	C.	Msichana
iv.	Bashasha	[ ]	D.	Chanda
v.	Tamalaki	[ ]	E.	Mvulana
			F.	Tengeneza
			G.	Mamba
			H.	Tawala

SEHEMU B UTUNGAJI

4. Andika vinyume vya maneno yafuatayo

i. Kale _____

ii. Mwenyeji _____

iii. Paa _____

iv. Ezua _____

v. Jengua _____

Scanned with CamScanner

5. **Eleza maana ya istilahi zifuatazo za kishairi (ALAMA 10)**

i. Mizani _____

ii. Vina _____

iii. Arudhi _____

iv. Ukwapi _____

v. Mshororo _____

6. **SEHEMU C: UTUNGAJI (ALAMA 10)**

Soma

Shule ya msingi Lwanga inatarajia kufanya mahafali ya darasa la saba tarehe 10/10/2026 siku ya Jumamosi katika ukumbi wa Tupendane kuaniza saa sita mchana hadi saa 12 jioni. Familia ya Bw na Bi Masanja wana binti yao aitwaje Leaha Mbunda ambaye ni miongoni mwa wahitmu. Ikiwa wewe ni mwanfamilia andika kadi ya mwaliko kwa Mch. Frank Nduguru kumwalika mchungaji huyo kuhudhuria sherehe hiyo. Mawasiliano yakoni ni +255888666

Zingati vipengele

- **kichwa cha mwaliko**
- **Jina la mwalika**
- **Jina la mwalikwa**
- **Lengo la mwaliko**
- **Tarehe/siku**
- **Mahali**
- **Muda**
- **Mawasiliano**

Scanned with CamScanner

Candidate's Name: _____

Name of School: _____

THE UNITED REPUBLIC OF TANZANIA

PRIME MINISTER'S OFFICE, REGIONAL ADMINISTRATION AND LOCAL GOVERNMENT

KIGAMBONI MUNICIPAL COUNCIL

MOCK STANDARD SEVEN
06E CIVIC AND MORAL EDUCATION

Time: 1 Hour 30 Minutes **March, 2026**

INSTRUCTIONS

1. This paper consists of sections **A, B and C** with a total of **Six (6)** questions.
2. Answer **all** questions in each section.
3. Write your answers in the space provided in each question.
4. All answers must be written in **blue** or **black** pen.
5. Cellular phones, and any unauthorized materials are not allowed in the assessment room.
6. Write your **Number and Name of your School** in the space provided.

FOR EXAMINERS' USE ONLY		
Question Number	**Score**	**Checker's Initials**
1		
2		
3		
4		
5		
6		
Total		

Scanned with CamScanner

SECTION A: 20 MARKS

I. Choose the correct answer and write its letter in the box provided.

i. Why should pupils sing national anthem while standing still?
A. To decree national mourning B. To show respect C. To pass national examinations
D. To celebrate festivals E. To listen to announcements [ ]

ii. What effects are likely to face a pupil who is quarrelsome and does not attend lessons?
A. Poor performance and punishments B. Getting disease and pregnancy
C. Early marriage and expulsion from school D. Truancy and dropouts
E. Dropout and diseases [ ]

iii. Embezzlements, signing fraudulent treaties and briberies decline national development. Why do some government leaders entertain those acts?
A. They are paid low salaries B. They want to be riches C. Due to scarcity of resources
D. They have big family sizes E. They lack moral values [ ]

iv. Matata is a villager who usually damages water taps and causes leakage of water. What advice should be given to him in order to stop that habit?
A. To respect village leaders B. To harvest rainwaters
C. To follow principles of patriotism D. To install water tanks at home
E. To use bottled water [ ]

v. Which of the following does not imply the act of caring about one-self for a child?
A. Doing physical exercises B. Abstaining from risky acts C. Helping young siblings
D. Eating balanced diets E. Wearing clean clothes [ ]

vi. What advantages do we get by using communication networks?
A. Getting friends of opposite sex only B. Doing online financial transactions
C. Sharing authentic data D. Posting decent images
E. Respecting human rights [ ]

vii. How can the government prohibit cutting down of trees caused by the demand of firewood and charcoal fuels in the community?
A. By reducing the price of charcoal B. By planting trees
C. By promoting good farming methods D. By supplying renewable energies
E. By avoiding poaching [ ]

viii. To whom should pupils seek guidance and finding solutions to academic challenges they face while at school?
A. Chairperson of the School Committee B.The school headteacher
C. School counsellor D. Academic teachers
E. Parents and guardians [ ]

ix. Parents are the heads of the family. What responsibility should they perform in the family?
A. Performing all house chores B. Bringing basic needs C. Employing their children
D. Bearing many children E. Paying salaries to children [ ]

x. How can youths destroy indigenous culture through globalization?
A. By learning new technologies B. By studying abroad
C. By having friendships with foreigners D. By imitating indecent dressings
E. By importing foreign goods [ ]

Scanned with CamScanner

2. **Match items in LIST A with their correct answers from LIST B**

LIST A	LIST B
i. Map of Tanzania	A. Used with a national flag to indicate that vehicles are owned by the government of Tanzania
ii. Coat of Arms	B. Used in decreeing the national mourning
iii. National Festivals	C. Shows a clear separation of powers between State organs
iv. National Constitution	D. Symbolizes powers and strength of our nation
v. National Animal	E. Shows seal of the nation and powers of the President
	F. Used to teach us about our national history
	G. Shows boundaries of our country
	H. Used to brighten our country across borders

Answers

LIST A	i.	ii.	iii.	iv.	v.
LIST B					

3. **Fill in the blanks with the correct words from the box**

Wedding,	Marriage,	Citizen,	Terrorist,	Child,	Orphan

i. A person with all legal rights that recognize him or her in a particular nation is referred to as. _____

ii. A person who uses violent methods to threaten peace and security in the society. _____

iii. A word used to refer a person below 18 years of age. _____

iv. A person who has lost all parents. _____

v. A recognized legal union of a man and a woman as a husband and a wife respectively is referred to as _____

Scanned with CamScanner

SECTION B: 20 MARKS

4. Fill in the chart below by writing the correct words from the box that show ways of educating youths about Reproductive Health according to the explanation given

Fliers, Social Media, Performing arts, Seminar, Classroom teaching, Mass media

	EXPLANATION	METHOD
i.	Use of programs or documentaries that are aired through radio and television stations	
ii.	Use of dramas that help to entertain the audience and reduce shyness of the performers	
iii.	Imparting knowledge through topics available in different subjects	
iv.	Displays pictures and messages aiming to warn youths on effects of early pregnancies	
v.	A health expert teaches an organized audience based on age or sex on the methods of family planning	

5. Fill in the blanks with correct answers

i. Water is an important requirement for school development. How is that requirement used to promote school development?
   a. _____
   b. _____

ii. Explain two acts showing that a citizen obeys laws of the land
   a. _____
   b. _____

iii. Which ways should a pupil use to conserve his or her school environment?
   a. _____
   b. _____

iv. What are the qualifications to contest for presidential seat in Tanzania?
   a. _____
   b. _____

v. What are the dangers of not paying taxes in a country?
   a. _____
   b. _____

SECTION C: 10 MARKS

6. Write the meaning for each of the following words

i. Ambassador _____
ii. Globalization _____
iii. Election _____
iv. Peace _____
v. Commonwealth _____

Scanned with CamScanner

Candidate's Name: _____

Name of School: _____

THE UNITED REPUBLIC OF TANZANIA

PRIME MINISTER'S OFFICE, REGIONAL ADMINISTRATION AND LOCAL GOVERNMENT

KIGAMBONI MUNICIPAL COUNCIL

MOCK STANDARD SEVEN

03E SOCIAL STUDIES AND VOCATIONAL SKILLS

Time: 1 Hour 30 Minutes **March, 2026**

INSTRUCTIONS

1. This paper consists of sections **A, B** and **C** with a total of **seven (7)** questions.
2. Answer **all** questions in each section.
3. Write your answers in the space provided in each question.
4. All answers must be written in **blue** or **black** pen.
5. Cellular phones, and any unauthorized materials are not **allowed** in the assessment room.
6. Write your **Number and Name of your School** in the space provided.

FOR EXAMINERS' USE ONLY		
Question Number	**Score**	**Checker's Initials**
1		
2		
3		
4		
5		
6		
7		
Total		

Scanned with CamScanner

SECTION A: 20 MARKS

1. Choose the correct answer and write its letter in the box provided

i. The chairperson warned the villagers on carrying out activities that degrade natural environment. Which activity did he **not** mention?
A. Using suitable pesticides B. Charcoal making C. Uncontrolled animal keeping
D. Cultivating in hilly areas E. Disposing waste in open spaces [ ]

ii. Why do livestock and human being die during drought conditions?
A. They lack enough rainfall B. They lack soil fertility
C. They are attacked by diseases D. They lack enough food
E. They lack manures [ ]

iii. What importance does a pupil get by listening to radio and watching television programmes?
A. Imitating foreign dressing styles B. Learning past historical events
C. Being known by journalists D. Getting many friends
E. Impressing his or her parents [ ]

iv. How did the monsoon winds facilitate the interactions between Tanzania and Asia during the 9th and 10th centuries?
A. They enhanced coastal accessibility
B. They blew commodities
C. They navigated dhows in the Indian Ocean
D. They connected sea routes
E. They carried traders [ ]

v. The following were the objectives of Missionaries in paving ways for colonialism in Africa, **except:**
A. Exploring the availability of commodities
B. Spreading European Culture
C. Establishing cultivation of cash crops
D. Spreading Christianity
E. Introducing western education [ ]

vi. Which type of natural vegetation is found in areas with low rainfall in Tanzania?
A. Thick and tall trees B. Dense forests C. Thick trees with scattered grass
D. Shrubs and grass E. Montane forests [ ]

vii. How can water be used for economic purposes?
A. For domestic cooking and drinking B. For washing clothes
C. For mopping the floor D. For watering home flowers
E. For generating electricity [ ]

viii. Sisal provides fibers used for making sacks. Where is that crop grown in Tanzania?
A. Iringa, Mbeya and Tanga B. Dodoma, Singida and Pwani
C. Tanga, Morogoro and Kilimanjaro D. Njombe, Tanga and Rukwa
E. Pwani, Lindi and Mara [ ]

ix. Which letter does not show the correct match of the country with the political party that fought for independence?
A. Zambia-ZANU B. Kenya-KANU C. Tanganyika-TANU
D. Mozambique-FRELIMO E. Uganda-UPC [ ]

x. Which of the following is one of the barriers to utilizing land resources in Tanzania?
A. Availability of large portion of land B. Increased human population
C. Implementation of land-use policies D. Presence of funds
E. Availability of trained staff [ ]

Scanned with CamScanner

xi. Which entrepreneurial opportunity is available in areas of national parks?
A. Hunting wild animals B. Lumbering activity C. Livestock keeping
D. Selling cultural items E. Selling heavy clothes [ ]

xii. How can we remove wrinkles and shrinks on clothes?
A. By folding clothes after washing B. By using detergents C. By ironing clothes
D. By using lemon juice E. By using fresh milk and salt [ ]

xiii. Why are we advised to wear cotton socks?
A. They reduce heat from feet B. They absorb sweat from feet
C. To look smart and attractive D. To walk better
E. To avoid slipping over [ ]

xiv. Which wind musical instruments originate in Tanzania?
A. Baragumu and Lipenenga B. Trumpet and bugle C. Lipenenga and trumpet
D. Baragumu and saxophone E. Saxophone and lilandi [ ]

xv. Which list shows examples of costumes used in acting?
A. Hoes, necklaces and lipsticks B Chain, hoe and bungles
C. Mascara, aprons and animal skins D. Chains, masks and neckties
E. Rings, chains and lip shiner [ ]

2. Match the items in COLUMN A with their corresponding answers from COLUMN B

COLUMN A		ANSWER	COLUMN B	
i.	Salt	[ ]	A.	Manufacturing of earth wires
ii.	Natural gas	[ ]	B.	Manufacturing of cement
iii.	Limestone	[ ]	C.	Production of nuclear energy
iv.	Diamond	[ ]	D.	Production of domestic fuels
v.	Tin	[ ]	E.	Manufacturing of car engines
			F.	Preservation of foodstuffs
			G.	Production of roofing materials
			H.	Cutting hard objects

SECTION B: 20 MARKS

3. Fill in the blanks with correct answers

i. Which ways can be used to protect against heavy rains in our environment?
a. _____
b. _____

ii. Floods cause deaths to living organisms and damaging infrastructure. How can we overcome that disaster? Explain using two points
a. _____
b. _____

iii. What does the word 'weather forecasting' mean? Briefly explain _____
_____

Scanned with CamScanner

4. Answer the following questions correctly

i. Which artistic works can be performed on stage?

a. _____

b. _____

ii. Why does the government of the United Republic of Tanzania prohibit female circumcisions?

a. _____

b. _____

iii. Which ways should Tanzania use to promote and maintain her cultural values?

a. _____

b. _____

5. Write short answers for each of the following questions

i. What are the characteristics of Communal mode of production?

a. _____

b. _____

ii. Julia is a sister to Ambokile. Who is Julia's son to Ambokile? _____

_____

6. Fill in the blanks with correct answers

i. Mention two properties of longitudinal lines?

a. _____

b. _____

ii. If the local time at town P located 35^0 W is 9:00 in the morning, at what longitude will the local time be 2:40 in the afternoon?

SECTION C: 10 MARKS

7. Write short answers for each of the following question

i. What are the effects of the Earth to revolve around the Sun?

b. _____

c. _____

ii. Why do planets not collide each other when revolving around the Sun?

_____

iii. Why does Mercury take shorter days to revolve around the Sun than the Earth?

_____

iv. How is key an important essential element of the map? _____

_____

v. A cartographer converted 20 Km of the ground distance into 8Cm on the map. Which Map scale did he use?_____

Scanned with CamScanner

Candidate's Name: _____

Name of School: _____

THE UNITED REPUBLIC OF TANZANIA

PRIME MINISTER'S OFFICE, REGIONAL ADMINISTRATION AND LOCAL GOVERNMENT

KIGAMBONI MUNICIPAL COUNCIL

MOCK STANDARD SEVEN

04E MATHEMATICS

Time: 2 Hours **March, 2026**

INSTRUCTIONS

1. This paper consists of sections **A, B and C** with a total of **Eight (8)** questions.
2. Answer **all** questions in each section.
3. Write your answers in the space provided in each question.
4. All answers must be written in **blue** or **black** pen.
5. Cellular phones, and any unauthorized materials are not allowed in the assessment room.
6. Write your **Number and Name of your School** in the space provided.

FOR EXAMINERS' USE ONLY		
Question Number	**Score**	**Checker's Initials**
1		
2		
3		
4		
5		
6		
7		
8		
Total		

Scanned with CamScanner

NO.	QUESTION	SOLUTION AND ANSWER
1.	**SECTION A (10 MARKS)**	
	i. 9857 + 998 =	
	ii. 8086 - 909 =	
	iii. 98 X 67 =	
	iv. 9.2 - 4.98 =	
	v. 10000 ÷ 20 =	
	vi. $3\frac{5}{6} - 10\frac{3}{4} =$	
	vii -18 X -12 =	
	viii. – 323 ÷ (+17) =	
	ix. $4 \div \frac{1}{5} =$	
	x. $3\frac{7}{10} - 2\frac{3}{4} =$	
2.	**SECTION B (30 marks)** i. Round off 423769 to the nearest thousands	
	ii. Write the Roman number CMLVII in Arabic numerals	
	iii. What is the place value of 9 in 158692	
	iv. Which number was expanded to get 50000 + 3000+ 200 + 0 + 6	
	v. Write the possible smallest number that can be formed by 8, 2, 6, 0, and 3	
	vi. What is the total value of 8 in 0.784?	

Scanned with CamScanner

NO	QUESTION	SOLUTION AND ANSWER
3.	i. How many prime numbers are there between 58 and 68?	
	ii. The sequence below represents the number of questions that were attempted by five pupils in a certain order 11, 17, 23, 29, _____, How many questions were attempted by the fifth pupil?	
	iii. Amani scored 56% in a mathematics test. Convert his score into simple fraction	
4	i. Change a quarter to midnight into 24 hours format	
	ii. A car travelled a distance of 54km at a speed of 9km/hr calculate the time taken to cover that distance	
	iii. How many minutes are there between 8:30 a.m and 11:15am?	
5.	i. Multiply 3km and 250m by 4	
	ii. A bottle with volume 1000ml contains 750ml of milk. How much more milk should be added into the bottle to fill it?	
	iii. Change 71 litres 250ml into millilitres	
6.	i. The age of Amosi is 4 years more than the age of Aphonica. Find the age of Amos if the sum of their ages is 28 years	
	ii. The sum of three consecutive odd numbers is 45. Find the sum of the smallest and the largest number	
	iii. Simplify $\frac{8ab^2 + 24a^2b}{8ab}$	

Scanned with CamScanner

NO.	QUESTION	SOLUTION AND ANSWER
7	**SECTION C: (10 MARKS)** i. The average of the numbers 3, 2, x, 11, 13 and 14 is 8 Find the value of X	
	ii. The following line graph shows the amount of rainfall recorded at a certain weather station from Tuesday to Friday 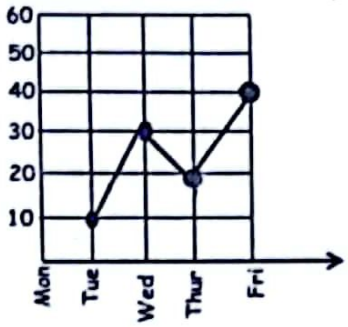 Calculate the average rainfall per day	
8.	i. Find the area of the following figure 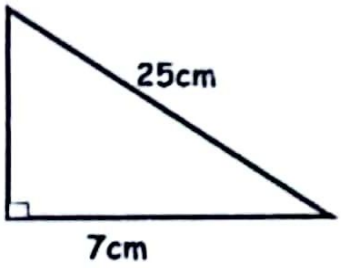 	
	ii. Find the volume of y 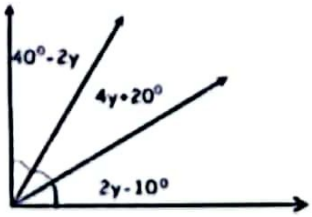 	
	iii. A cylindrical pipe is open on one side. If its height is 500cm and diameter is 70cm. find its surface area	

Scanned with CamScanner