PRIME MINISTER'S OFFICE – RALG
DODOMA CITY COUNCIL
STANDARD SEVEN DISTRICT MOCK EXAMINATION – APRIL 2026
MATHEMATICS TIME: 2:00 HOURS

NAME: _____ SCHOOL: _____

No	QUESTION	WORKSHEET AND ANSWER
1. I	SECTION A: (10 MARKS) – BASIC MATHEMATICS 380–420 + 200=	
II	900000–19987=	
III	4521×324 =	
IV	147320÷58=	
V	$100 - 71\frac{5}{11}$	
VI	7.9–(-16.25)=	
VII	110.2–11.983=	
VIII	0.144÷3.6 =	
IX	$11\frac{1}{2} \div 9\frac{1}{3} =$	
X	$8\frac{1}{9} \times 3\frac{1}{5} =$	

	SECTION B: (30 MARKS	
2. I	Three drums were beaten at school. The first drum is beaten after 3 minutes, the second after 6 minutes, and the third after 4 minutes. After how many minutes will all the drums be beaten together?	
II	Find the LCM and HCF of 18, 24, and 30.	
III	Jeri has 208 workers in his factory. If each worker is paid 55,460 shillings per day, how much money is used to pay all Workers per day?	
IV	Mzee Samweli distributed money among his children Mage, Eli, and Imani in the ratio 3:5:7. If the total money was 1,950,000 shillings, how much did Eli receive?	
V	Kazimoto bought mangoes for 5,000 shillings and sold them for 6,000 shillings. What was the percentage profit?	
VI	The sum of ages of a father and his child is 80 years. If the father's age is three times the age of the child, how old is the child?	
3. I	Daudi recorded a total weight of 57.8563 kg. Write this weight correct to two decimal places.	
II	The password of a laptop is the largest number formed using the digits 0, 8, 5, 4, 7, and 9. What is the password?	

CamScanner

III	Find the square root of $20\frac{1}{4}$.	
4.I	. Simplify the algebraic expression: (As given in the question) $\frac{3P^2T^4 - 4P^2T^4 + 2P^2T^4}{2P^2T^4}$	
II	A train left Tabora station at 12:45 PM. Write this time in the 24-hour format.	
III	12 people can cultivate a farm in 3 days. If 6 more people of equal ability are added, how many days will it take to cultivate the farm?	
5.I	The average of six numbers is 139. If five of the numbers are 88, 90, 142, 106, and 181, find the sixth number	
II	Multiply 6 km 350 m by 25. Give your answer in meters.	
III	The sum of three consecutive numbers is 78. Find the largest number	
6.I	Five standard six students were asked to List all the prime numbers between 60 and 70. How many are they?	
II	Standard five students were instructed to simplify $8\frac{3}{8}\%$ Into its simplest fraction form. If they got the correct answer, what was their answer?	
III	Find the simple interest earned after 4 years on 80,000 shillings at a rate of 10½% per year	

CamScanner

	SECTION C: GEOMETRY	
7.I	Find the value of angle CBD in the diagram provided. 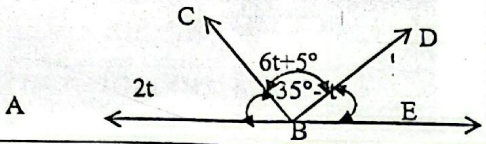	
II	Find the area of the rectangle shown, closed both side. 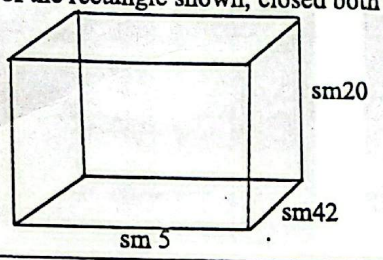	
III	Find the perimeter of the given shape, where SO and OP are semicircles. (Use $\pi = 3\ 1/7$) 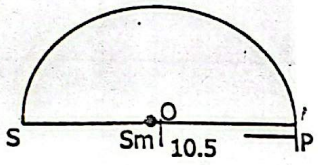	
8.I	The diagram shows how Mzee Mbwiga spent his monthly salary of 720,000 shillings. How much money was spent on food? 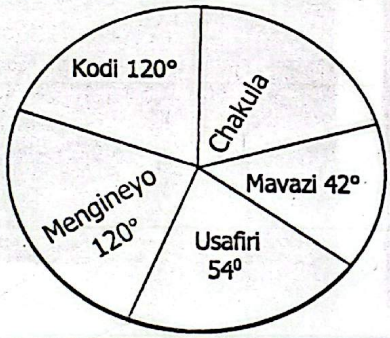	
II	The sixth-grade students were given four coordinates: **A(0,4)**, **B(3,4)**, **C(0,1)**, and **D(3,1)**. If they plotted and connected them correctly, what a shape they would get ?.	



PRIME MINISTERS OFFICE REGIONAL ADMINISTRATION AND LOCAL GOVERNMENT

DODOMA CITY COUNCIL

STANDARD SEVEN MOCK EXAMINATION -APRIL 2026

ENGLISH LANGUAGE

TIME: 1: 40 HOURS APRIL, 2026.

Name: School:

INSTRUCTIONS:

1. This paper consists seven questions with sections **A, B** and **C.**
2. Answer all questions in all sections.
3. Write your answer in the space provided in each question.
4. All your writings should be in **blue** or **black** ink.
5. Sections A and B carry **twenty (20)** marks each and section **C** carries **ten (10)** marks.

SECTION A: (20 MARKS).

Answer all the questions in this section.

1. **Listen carefully to the passage read by the invigilator and then answer item I – V correctly by choosing letters.**

I. Who were best friend in the story?

(a) Anna and David (b) Anna and Grace (c) Anna, Grace and David (d) Anna and classmates (e) Grace and David [ ]

II. What did Anna find on the ground?

(a) A book (b) A coin (c) A shiny pen (d) A pencil (e) A bag[ ]

III. What did Grace remind Anna about?

(a) To keep the pen safely (b) To return home early (c) To share the pen with David (d) That it was wrong to take what was not hers (e) That is was right to take what was not hers [ ]

IV. How did David feel when he got his pen back?

(a) Happy and angry (b) Happy (c) Surprised (d) Sad (e) Angry [ ]

V. What lesson do we learn from the story you have listened?

(a) Honest and guidance strengthen friendship (b) Honest and guidance strengthen enemity (c) Helping friends means keeping secrets (d) Keeping found items is acceptable (e) Friendship is all about playing together [ ]

CamScanner

2. **For each of the item I – V, choose the most correct answer and write its letter in the brackets provided.**

I. He didn't play well, _____ he was sick.
(a) So (b) since (c) but (d) yet (e) and [ ]

II. That house which is white in colour is ours. It is belonging to _____
(a) Us (b) our (c) we (d) its (e) ours [ ]

III. As pupils we must study hard in order to perform well in our exams. How would be the question tag of the statement? _____ [ ]
(a) we must? (b) Must we? (c) Mustn't we? (d) We must? (e) Mustn't we?

IV. The sun always rises in the East and _____ in the West.
(a) Setting (b) Set (c) Is setting (d) Sets (e) Was setting [ ]

V. They have been _____ football for 45 minutes.
(a) Playing (b) Played (c) Plays (d) Play (e) Has played [ ]

3. **For the items I – V, complete the sentences by choosing the correct words given in the box.**

So that, not only..... But also, such.....that, too.....to, so.... that, in order to.

I. I am _____ hungry _____ I can eat 100 kilos of rice.

II. They were late, but not _____ late _____ catch the SGR Train.

III. The athlete ran fast _____ he could win the race.

IV. It was _____ a beautiful movie _____ we watched it all the night.

V. Kibaraka is _____powerful _____ brave.

4. **Match the items in column A with those from column B by writing the letter of the correct answer in the space provided.**

S/N	COLUMN A	ANSWER	COLUMN B
I	A person who catches fish	[ ]	A. Pedestrian
II	A person who rides a bicycle	[ ]	B. Release
III	A person who fixes pipes	[ ]	C. Fisher man
IV	A person who walks on foot	[ ]	D. Fish monger
V	The antonym of the word grab	[ ]	E. Cyclist
			F. Driver
			G. Plumber

CamScanner

SECTION B: (20 MARKS).

5. Answer all questions (I –V) according to the instructions given under each item.

I. Juma said "My father is playing tennis with me". Write the sentence in an **indirect speech/ reported speech.**

_____

II. Add a question tag: **I am not satisfied,** _____?

III. The plural form of the word **ship** is **ships.** The plural form of the word **furniture** is

_____

IV. Write the following sentence into negative - question form: **Is she playing football?** _____

V. He was studying hard, _____ he failed the National Examination **(for, because, yet)**

6. Read the following poem carefully then answer the questions that follow.

It was my birthday I remember,
My first day to be surprised I remember,
Sitting on the couch I remember,
Watching Ubongo kids I remember.

She entered the sitting room I remember,
With a bunch of flowers I remember,
Her hug and kiss I remember,
Wishing me a long life I remember.

Tears rolled down my face I remember,
Tears of joy and love I remember,
Oh my mother oh my mother,
I will always remember you.

CamScanner

Questions:

I. What can be a suitable title of the poem?

_____

_____

II. What is the poem about?

_____

_____

III. Why do you think the speaker shed tears?

_____

_____

IV. Write the reiteration found in the poem.

_____

_____

V. What lesson have you learnt from the poem?

_____

_____

SECTION C: (10 MARKS).

7. Arrange the following sentences to get a logical flow of order by giving them letters A – E.

I. He asked me to go to his office to collect our exercise books. [ ]

II. Yesterday, I went to school early in the morning. [ ]

III. So, I went into his office and collected our exercise books. [ ]

IV. I cleaned our classroom as I was on duty. [ ]

V. When I was taking rubbish to the dump, I saw our English language teacher heading towards his office. [ ]

CamScanner

LISTENING SKILLS

THE PASSAGE

Anna and Grace were the best friends. One day, while walking home from school, Anna found a shiny pen on the ground. She picked it up and showed it to Grace. Immediately Grace recognized the pen. It belonged to their classmate, David. At first, Anna thought of keeping it, but Grace reminded her that it was not right to take what did not belong to her. The next day, Anna returned the pen to David. David was very happy and thanked Anna for being honest. Anna also thanked Grace for guiding her to do the right thing. Their friendship grew stronger because they supported each other in making good choices.

THE PASSAGE

Anna and Grace were the best friends. One day, while walking home from school, Anna found a shiny pen on the ground. She picked it up and showed it to Grace. Immediately Grace recognized the pen. It belonged to their classmate, David. At first, Anna thought of keeping it, but Grace reminded her that it was not right to take what did not belong to her. The next day, Anna returned the pen to David. David was very happy and thanked Anna for being honest. Anna also thanked Grace for guiding her to do the right thing. Their friendship grew stronger because they supported each other in making good choices.

CamScanner

KIFUNGU CHA HABARI

Familia ya bibi Bugonola na mzee Kaliua ina jumla ya watu watano. Pamoja na mtoto wa jirani yao wanayeishi naye. Pia wanaishi na kijana mmoja waliyemtoa kwenyekituo cha Watoto yatima. Mtoto huyo jina lake ni Joan.

Siku moja, Joan alitumwa mtoni pamoja na kitinda mimba wa familia hiyo ambaye ni Kokushubila. Musa na Melisa walienda kuchanja kuni msituni. Wakiwa njiani walimuo na bibi mmoja akiwa na mzigo wa kuni. Melisa alimwambia Musa kuwa hanabudi kurudi nyumbani ili amsaidie ule mzigo wa kuni bibi yule. Melisa alimsaidia bibi yule naye Musa akaendelea na safari ya kwenda kuchanja kuni.

Bibi yule na Melisa walifika nyumbani nakumkuta binamu yake na yule bibi akiwaameandaa chai hivyo walikunywa na kupumzika.

Bibi yule alichukua nusu ya kuni alizokuwanazo na kumpa Melisa pamoja na zawadi ya zabibu.

Bibi huyu pia alimsihi Melisa na kumwambia "nakuombea kwa Allah akupe Maisha memadaima"

CamScanner

OFISI YA WAZIRI MKUU-TAMISEMI

HALMASHAURI YA JIJI LA DODOMA

MTIHANI WA UTIMILIFU -APRIL 2026

SOMO: KISWAHILI

JINA: _____ SHULE: _____

SEHEMU A: (Alama 20)

1. Sikiliza kwa makini **hadithi utakayosomewa** na **msimamizi kisha jibu kipengele cha (i-v)kwa kuchagua herufi ya jibu sahihi na kuandika katika kisanduku .**

(i) Familia ya mzee Kaliua na bibi Bugonola ni ajumla ya watu wangapi? (a) sita (b) nane (c)watatu (d)saba (e) watano { }

(ii) Mtu asiye na wazazi huitwa (a) Binamu (b) Yatima (c) mjukuu (d) anayeishi kwenye kituo cha watoto yatima (e) jirani { }

(iii) Neno "Allah" kama lilivyotumika kwenye habari hii lina maana gani? (a) Bibi (b) Shetani (c) Malaika (d) Sheikh (e) Mungu { }

(iv) Kitendo cha Melisa kumpokea bibi mzigo kinaonesha tendo gani? (a) kujiheshimu (b) kuwapenda na kuwajali wengine (c) kudumisha usiri (d) kutumia lugha ya matusi (e) kuwa mtiifu { }

(v) Melisa alipewa zawadi gani na yule bibi? (a) Zabibu (b) Mkate na chai (c) Kuni (d) Adhabu (e) Mtihani { }

2. **Katika kipengele cha (i-x) chagua jibu sahihi kisha andika herufi yake katika kisanduku**

i. Kitendawili kipi kati ya vifuatavyo kinateguliwa na picha ifuatayo?



(a) Mjomba hataki tuonane
(b) Mwanangu akichanganyika na wenzake simtambui
(c) Nyumba yangu ina nguzo moja
(d) Hausimiki hausimami
(e) Kila mtu humwabudu apitapo { }

ii. Huwezi kula zaidi ___utavimbiwa (a) sivyo (b) lakini (c) kwakweli (d) pasi na (e) lasivyo { }

3.

CamScanner

iii. Tembela haraka " alitushauri. Sentensi hii iko katika kauli (a) mshangao (b) taarifa (c)halisi (d) uzio (e) utata { }

iv. Onesha kiambishi awali cha kitenzi "wananisumbua" (a) -wa- (b) -na- (c) -sumb- (d) -ni-(e) -a- { }

v. Biashara ya yule mama Ntilie imeanza kuzaa matunda siku hizi Nahau " kuzaa matunda" ina maana gani? (a) kupata faida (b) kupata hasara (c) kuacha kazi (d) kufirisika (e) kutumia mali vibaya { }

vi. Anakula wali kwa kijiko. Neno "kwa" katika sentensi hii ni aina gani ya neno? (a) kivumishi (b) kitenzi kisaidizi (c) kiunganishi (d) kihisishi (e)kielezi { }

vii. Neno lipi ni jumuishi kwa maneno yafuatayo: samaki, nyama, maharage na dagaa ? (a) vitoweo (b)vitomeo (c)mboga (d) vitafunwa (e)vyakula { }

viii. Japhari aliondoka hivi punde. Sentensi hii ina maana japhari ameondoka _____ (a) kwa pupa (b) haraka (c) polepole (d) karibuni (e) taratibu { }

ix. Lipi kati ya maneno haya ni tofauti na lingine (a) kuku (b) mwewe (c) bata (d) kunguru (e) panya { }

x. _____ ndiye aliyetuonesha njia sahihi ya kukokotoa swali hilo.Neno lipi kati ya haya linakamilisha sentensi hii kwa usahihi (a) wao (b) yupo (c) huyu (d) yeye (e) sisi { }

3. Oanisha maneno ya sehemu A na maana zake zilizopo katika sehemu B kwa kuandika herufi ya jibu sahihi katika kolamu ya majibu

SEHEMU A	MAJIBU	SEHEMU B
i. Sonara	{ }	A. Neno lenye maana zaidi ya moja
ii. Kapera	{ }	B. Mtu anayetengeneza vito vya tahamani kama pete, hereni na mikufu
iii. Shaibu	{ }	
iv. Muongo	{ }	C. Mtu ambaye hajaoa
v. Mgane	{ }	D. Mtu anayetengeneza vitu vya samani kama
		E. kabati, meza na viti
		F. Mwanamke aliyefiwa na mume wake
		G. Mwanaume mzee sana
		H. Mwanaume aliyefiwa na mke wake

CamScanner

SEHEMU B (Alama 20)

4. Kamilisha sentensi zifuatazo kwa kuweka alama za uandishi katika nafasi zilizoachwa wazi

i) Alaa _____ mambo gani haya _____

ii) Je _____ huyu ni mtoto wako _____

iii) Hekoo _____ timu yetu imepata ushindi _____

iv) Wanafunzi waliandaa nyimbo _____ mashairi na ngonjera

v) Haaa _____ kumbe _____

5. Soma shairi lifuatalo kisha jibu maswali yanayofuata

Tusidharau wazazi, heshima kuwafanyia,
Wanafanya kubwa kazi, kutunzaa kutulea,
Wanatupa na mavazi, siis tunachekelea,
Wazazi wetu ni nguzo, kwetu sisi wana wao,

Wanatutunza vizuri, kwa chakula na mavazi,
Wananunua sukari, chai pia na maandazi,
Wanapika na achari, wanatupa na malazi,
Wazazi wetu ni nguzo , kwetu sisi wana wao,

Vilevile zahanati, tunakwenda kutibiwa
Twaenda kila wakati, Ugonjwa tukizidiwa
Hutupepea kwa dhati, kwa joto tukizidiwa
Wazazi wetu ni nguzo, kwetu sisi wana wao

MASWALI

i) Shairi hili linahusu nini?_____

ii) Vina vya kati na mwisho katika ubeti wa tatu ni _____ na _____

iii) Je mashairi anahitaji watoto wawafanyie nini wazazi wao?

_____

iv) Neno "malazi" lina maana gani kama lilivyotumika katika ubeti wa pili

_____

v) Shairi hili linatoa funzo gani?_____

CamScanner

SEHEMU C Alama (10)

6. Soma barua ifuatayo kisha taja vipengele vinavyokosekana

Kijiji cha songambele

S.L.P 203

Iringa

(i) _____

(ii) _____

Mwenyekiti wa kijiji cha Songambele,

kata ya Tosamaganga

S.L.P 40

Iringa

Ndugu

(iii) _____

Tafadhali husika na somo tajwa hapo juu

Kutokana na maazimio ya mkutano mkuu wa kijiji wa kujenga darasa, mimi

Kazimoto Maendeleo ofisa matendaji wa kijiji cha songambele, ninakubali

kushirikiana na wanakijiji wenzangu katika ujenzi wa chumba kimoja cha darasa hadi

kufanikisha

Nashukuru kwa ushirikiano

Wako katika maendeleo ya kijiji chetu

(iv) _____

(v) _____

Ofisa mtendaji wa kijiji

CamScanner

THE CITY COUNCIL OF DODOMA
STADARD SEVEN DISTRICT MOCK EXAMINATION APRIL 2026
SUBJECT: CIVIC AND MORAL EDUCATION

NAME: _____ SCHOOL: _____

1. **SECTION A: (20 marks) Choose the correct answer from the given alternatives and write its letter in the space provided (10 marks)**

i. How is it risky to accept car lifts from strangers, especially for girls _____ (a) failing exams (b) sexual abuse (c) hate by school boys (d) intolerance (e) early puberty [ ]

ii. The name Tanzania was formed after _____ (a) 9th December 1961 (b) 26th April 1964 (c) 29th October 1964 (d) 10th December 1964 (e) 26th April 1 [ ]

iii. Amina and Zainabu are friends who started school together. Anna is from the Mtwara region and Zainabu is from the Mwanza region. What is their country? __
(a) Mbeya (b) Arusha (c) Kenya (d) Tanzania (e) Zambia [ ]

iv. A leader who is democratically elected has the following qualities, **except**: A. Practices the rule of law B. Is ready to be criticized C. Respect the ideas of others D. Serves people E. Segregate others [ ]

v. Political tolerance is one of the principles of democracy, since ___ A. It gives people an electoral victory without their campaigning. B. It helps silence those who have been defeated, C. It brings harmony among opposing groups. D. It makes donors happy E. It makes Classes among the political parties [ ]

vi. Which institution investigates the crime and eventually arrests and takes the criminal to court after the investigation? ___(a) Fire forces (b) prison force (c) The army (d) Police force (e) immigration [ ]

vii. Joshua and Triza are a married couple, and they have two children, Sharon and William. William attended school while Sharon was forced to drop out of school to get married. How do we call this act? __ (a) Gender equality (b) Gender inequality (c) sexual abuse (d) Separation of power (e) truancy [ ]

viii. Which of the following is not an act that shows respect? __(a) Being drunk (b) Greeting elders (c) dressing properly (d) Loving anyone (e) Helping others [ ]

ix. When do the citizens of Tanzania officially join together to celebrate Labors' Day? (a) 7 April (b) 8 August (c) 7 July (d) 26 April (e) 1st May [ ]

x. One of the following acts is not common to Tanzanian's traditions and customs__
(a) Children respecting elders (b) children rebuking elders (c) children helping elders (d) Children greeting elders (e) Children cooperating with each other [ ]

2. **Match the items below from List A to those of List B by writing the letter of the correct answer in the spaces provided (5 Marks)**

List A		Answer	List B
i.	A branch of the state that is responsible for enacting laws	[ ]	A. Member of parliament
ii.	Appointed by the president and approved by parliament	[ ]	B. The Government
iii.	Interprets laws and provides equal rights to all people	[ ]	C. The judiciary
iv.	Citizens' representatives	[ ]	D. Parliament
v.	Provide education, health services, and water to citizens	[ ]	E. Prime Minister
			F. Democracy

CamScanner

3. **Choose the correct answer from the box (5 Marks)**

Parliament,	**Chairperson,**	**Chief Justice,**	**Somalia,**
DR. Congo,	**Resources,**	**Corruption, bribe**	

(i) A sum of money or other inducement offered to someone to dishonestly persuade him or her to act in one's favor, known as _____

(ii) According to the constitution of the United Republic of Tanzania, the President of the United Republic of Tanzania is sworn in by _____

(iii) Important and valuable things owned by the country are known as _____

(iv) The head of the village council, who is elected by the villagers is _____

(v) The East African Community (EAC) is made up of eight members. Which country was the last to join the EAC? _____

SECTION B: (20 Marks) Completing the charts and short answer questions

4. By using the diagram below, answer the following questions in the space provided.



i. Government pillar which is marked by letter **A** is known as _____

ii. Explain one role of the pillar marked by letter **A** _____

_____

iii. What is the difference between **JUDICIARY** and the pillar which is marked by letter **A**?

_____

_____

iv. The one who leads the organ marked A is appointed by? _____

v. Explain the function of the Judiciary? _____

_____

5. Use the short answers to answer the following question from this part (10 marks)

i. Mr Kamunde is the ward executive officer of Mbokomwa ward. How do we get the ward executive officer _____?

ii. Tanzania expects to conduct the general election this year of 2025. Which organ will be responsible for supervising the General election? _____

iii. One of the bad practices that can lead to death for a woman or a girl is _____

_____

iv. Careen always pretends to have a certain belief, attitude, or feeling, but in fact, she does not have them. Sometimes she lies while she knows the truth and makes fake promises. What do we call that behavior? _____

v. What was the working slogan of the fifth president of the United Republic of Tanzania _____

_____?

6. SECTION C: (10 marks) Answer the following question in the space provided.

i. What is culture _____

_____

ii. Define manifesto _____

_____

iii. What is counseling? _____

_____

iv. What are the differences between gender and sex _____

_____

v. What is integrity _____

CamScanner

THE CITY COUNCIL OF DODOMA

STANDARD SEVEN DISTRICT MOCK EXAMINATION APRIL – 2026

SUBJECT: SCIENCE

NAME: _____ **SCHOOL:** _____

SECTION A (20 MARKS)

1. Choose the correct answer and write the letter in the brackets

i. Oxygen gas is produced during photosynthesis. What percentage of oxygen is found in the atmosphere? (a) 20 (b) 20.9 (c) 25 (d) 0.33 (e) 0.19 { }

ii. Severe lack of blood caused by deficiency of iron is called: (a) Alvedi (b) Weakness (c) Weak cells (d) Anemia (e) Blood-deficiency { }

iii. A balanced diet contains all nutrients needed by the body. What problem occurs if the body lacks these nutrients? (a) Scurvy (b) Malnutrition (c) Beriberi (d) Hemophilia (e) AIDS { }

iv. There are _____ main types of bone fractures:(a) Three (b) Five (c) One (d) Four (e) Two { }

v. An old man was seen staggering after drinking too much alcohol. Which part of the ear was affected? (a) Pinna (b) Cochlea (c) Eardrum (d) Cerebellum (e) Semicircular canals { }

vi. Which of the following contains acidic substances? (a) Orange and ash (b) Lemon and ash (c) Ash and soda ash (d) Orange and lemon (e) Orange and soda ash { }

vii. Pupils cleaned the school environment to destroy mosquito breeding sites. Which activities did they do? (a) Slashing grass and filling stagnant water, (b) Sweeping and planting trees, (c) Gardening and slashing (d) Removing cobwebs and mopping, (e) Watering flowers { }

viii. The density of wood is 20 kg/m³. If the volume is 90 m³, find the mass: (a) 4.5 kg (b) 0.22 kg (c) 180 kg (d) 1800 kg (e) 110 kg { }

ix. What does the diagram represent? (a) Dry cell (b) Resistor (c) Battery (d) Earth wire (e) Fuse { }

x. The potential difference is 48 V. Calculate the current if resistance is 12 Ω: (a) 4 A (b) 6 A (c) 2 A (d) 8 A (e) 24 A { }

MATCHING (10 MARKS)

2. Match Column A with Column B

Column A	ANSWERS	Column B
i. Converting waste into re-usable materials	{ }	A. Auditory
ii. Inability to see near objects	{ }	B. Class A fire
iii. Carrying sound impulses to the brain	{ }	C. Olfactory
iv. Waste products removed by lungs	{ }	D. Carbon dioxide and water vapour
v. Burning of solid materials	{ }	E. Urine
		F. Hypermetropia
		G. Recycling
		H. Myopia

CamScanner

3. FILL IN THE BLANKS (5 MARKS)

H2O+O2, penis, Email, dicotyiedon, haemoglobin, scurvy, aorta, worksheet, cell, water and oxygen, metamorphosis.

i. A message prepared using a computer and sent via the internet _____

ii. Performs two different functions in two different systems _____

iii. The compound that gives blood its red colour _____

iv. Causes of rust _____

v. Stages of insect development _____

SECTION B (20 MARKS)

4. FILL IN THE BLANKS BY WRITING THE CORRECT ANSWER.

i. Name the two types of computer programs:

a) _____ b) _____

ii. The nerve that carries information from the nose to the brain: _____

iii. The pigment that protects the skin from strong sunlight: _____

5. i. Which part of the brain helps you during exams? _____

ii. A blender converts electrical energy into _____ energy

iii. The force that pushes objects upward in water is called _____

6. i. The point where light rays meet after reflection is called _____

ii. Physical parts of a computer are called _____

iii. The organ that reduces alcohol in the body is _____

SECTION C (10 MARKS)

7. ANSWER ALL QUESTION

i. Blood carries digested food to the liver through the _____ vein

ii. A chemical substance with a sour taste is called _____

iii. The tongue detects taste due to _____

8.

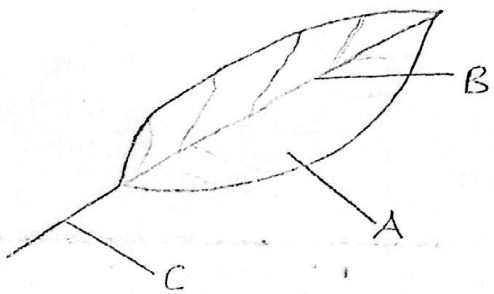

i. Name the part labeled A _____

ii. Which letter shows the part connecting leaf to stem? _____

CamScanner

PRIME MINISTER'S OFFICE – RALG
DODOMA CITY COUNCIL
STANDARD SEVEN MOCK EXAMINATION APRIL 2026
SOCIAL STUDIES — GRADE VII

NAME: _____ SCHOOL: _____

SECTION A

1. Choose the correct answer and write the letter in the box. (20 marks)

i. Joan was asked by her teacher to mention ways of preserving historical records. Which of the following was NOT mentioned? A. Oral traditions B. Museums C. Historical sites D. Television E. Written records [ ]

ii. A historical site important for having remains of buildings, mosques, and slave trade during the Arab period is: A. Bagamoyo B. Isimila C. Kaole D. Kilwa E. Engaruka [ ]

iii. The following are ways of conserving the environment **EXCEPT:** A. Terrace farming B. Planting trees C. Keeping many animals in a small area D. Using alternative energy E. Avoiding cutting trees carelessly [ ]

iv. In which Stone Age period did humans discover fire? A. Iron Age B. Early Stone Age C. Middle Stone Age D. Late Stone Age E. First Stone Age [ ]

v. The skull of early humans was discovered at _____ in Arusha by archaeologists Dr. Louis Leakey and Mary Leakey. A. Olduvai Gorge B. Kondoa C. Isimila D. Bagamoyo E. Laetoli [ ]

vi. Customs and traditions form a large part of culture. Why? A. They strengthen the economy B. They identify society only in economic matters C. They carry the entire system of a society D. They bring international development E. They strengthen traditional medicine [ ]

vii. A forest is an area with many trees, shrubs, and grasses. How many types of forests are there? A. Six B. Five C. Two D. Four E. Three [ ]

viii. Ceremonies for training boys to become full men are called: A. Customs B. Traditions C. Unyago D. Jando E. Culture [ ]

ix. The situation where one country controls another for political, economic, and social purposes is called: A. Patriotism B. Neo-colonialism C. Community D. Unity E. Colonialism [ ]

x. The first President of Tanzania was: A. Benjamin Mkapa B. Ali Hassan Mwinyi C. John Pombe Magufuli D. Julius Kambarage Nyerere E. Samia Suluhu Hassan [ ]

xi. When the Earth is covered by a shadow during the day, it is called: A. Solar eclipse B. Cold season C. Umbra D. Seasons E. Penumbra [ ]

xii. How many seasons are there in a year? A. Five B. Four C. Three D. Two E. Seven [ ]

xiii. At Isimila in Iringa, remains of ancient tools were made using: A. Iron B. Wood C. Stone D. Cement and stone E. Trees and stone [ ]

xiv. The special paths that planets follow as they move around the Sun are called: A. Axis B. Orbit C. Generation D. Sphere E. Tropic lines [ ]

xv. Types of settlements depend on economic activities. How many types of settlements are there? A. Two B. Many C. Three D. Four E. Five [ ]

CamScanner

2. **MATCH ITEMS IN SECTION A WITH SECTION B CORRECTLY.**

SECTION A	ANSWER	SECTION B
i. Olduvai Gorge	[ ]	A. Footprints of early humans
ii. Amboni – Tanga	[ ]	B. Remains of iron tools
iii. Isimila – Iringa	[ ]	C. Skull remains of early humans
iv. Kondoa Irangi	[ ]	D. Large caves with different shapes
v. Laetoli – Arusha	[ ]	E. Cave paintings
		F. match with Remains of stone tools

SECTION B (FILL IN THE BLANKS) (20 MARKS)

3. i. In a weather station, the instrument used to measure humidity in the air is called _____

ii. The ratio between real distance and map distance is called _____

iii. Settlement pattern built along roads, railways, rivers, or lakes is called _____

4. i. Which map scale is used when drawing a map of Dodoma? _____

ii. Southern African Development Community (SADC)

a) It was established in the year _____

b) Its main aim is _____

iii. In Tanzania, a population census is conducted every _____ years

5. i. Mention two advantages of entrepreneurship:

a) _____

b) _____

ii. Between North and West, what is the direction called? _____

6. i. How long does the Earth take to rotate one longitude? _____

ii. Clothes worn by performers during shows are called _____

SECTION C (Picture Interpretation) (10 marks)

7. **Examine this picture and answer the questions that follow. (10 Marks)**

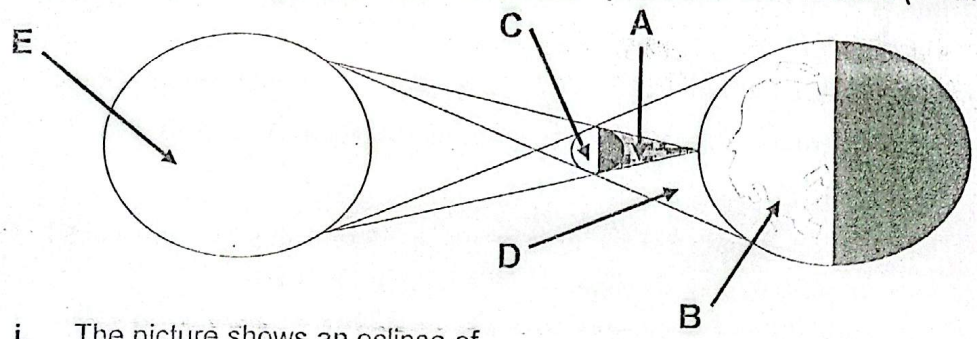

i. The picture shows an eclipse of _____

ii. Which letter shows a partial solar eclipse? _____

iii. Which letter represents the Moon? _____

iv. Which letter shows a total solar eclipse? _____

v. Which letter represents the Earth? _____

CamScanner