Candidate's Index Number: _____

STANDARD SEVEN JOINT EXAMINATION AMONG CARMEL, ST. MONICA, ST. AUGUSTINE, ST. ARNOLD JANSEN, MARY IMMACULATE, NEJOLA AND SHEPHERD SCHOOLS CONDUCTED ON 25TH APRIL 2026

SUBJECT: SOCIAL STUDIES AND VOCATIONAL SKILLS.

SECTION A (20 Marks)

Answer all questions in this section.

1. For each of the items (i) – (xv), choose the correct answer and write its letter in the box provided.

i. Human beings play a major role in causing global warming. Which of the following is not the effect of global warming?
   A. Frequent occurrence of storms and winds
   B. Frequent occurrence of weather and climate related hazards
   C. Decrease of sea level
   D. Melting of snow [ ]
   E. Occurrence of heavy rainfall in a short period causing floods

ii. Which water sources need international cooperation in order to preserve them?
   A. Lake Tanganyika and River Pangani
   B. Lake Eyasi and River Ruvuma
   C. Lake Victoria and Indian Ocean [ ]
   D. Lake Eyasi and River Rufiji
   E. Lake Nyasa and River Malagarasi

iii. How many minutes does the earth take to rotate one degree on its axis?
   A. 5 B. 10 C. 15 D. 8 E. 4 [ ]

iv. Which technique should a farmer use to avoid overcrowding of the crop plants in the filed?
   A. Weeding B. Mulching C. Stacking D. Pruning E. Thinning [ ]

v. Tanzania's economy largely depends on _____
   A. Manufacturing and mining
   B. Fishing and livestock keeping
   C. Agriculture and livestock keeping [ ]
   D. Trade and agriculture
   E. Manufacturing and agriculture

vi. Which among the following groups is not compromised of biotic environment?
   A. Insects, birds, animals and forest
   B. Buildings, roads, industries and land
   C. Soil, land, animals and insects
   D. People, forests, birds and animals [ ]
   E. The sky, land, living and non – living organisms

vii. How do we call a huge ocean wave caused by earthquake below the sea?
   A. Volcanic eruption B. Lands C. Tsunami D. Floods E. hazard [ ]

viii. Which of the following is the characteristic of early stone age?
   A. Human beings used very advanced tools B. Human beings ate roasted meat
   C. Human beings domesticated animals and plants D. Human beings lived in a solitude
   E. Human beings discovered fire [ ]

CamScanner

ix. What was the major technological development of man during Middle Stone Age?
A. Hunting and gathering B. Discovery of digital services C. Discovery of fire
D. Discovery of iron E. Walking on four limbs [ ]

x. Who was the last British governor in Tanganyika?
A. William Mackinnon B. Richard Turnbull C. Karl Peters
D. Edward Twining E. Horace Byatt [ ]

xi. Where was Maumau war fought?
Uganda B. Tanzania C. Kenya D. Burundi E. Congo [ ]

xii. Which od the following features differentiate Mercury from Venus?
A. Being flat shape B. Having 100 moons C. Being a natural satellite [ ]
D. Different size E. Revolving around the sun

xiii. Which among of the following can be the main cause of earth quake? [ ]
A. Natural fire B. Melting of snow C. Volcanic eruption D. Overgrazing E. Heavy raifall

xiv. Which example of disease can affect girls during menstruation due to failure in maintain body hygiene?
A. Syphilis B. Fungus C. Anemia D. Gonorrhea E. Malaria [ ]

xv. What is the main activity of the Laiboni among the Maasai?
A. To guide the society and livestock
B. To steal animals and provide security to the society
C. To advise the council of elders
D. To coordinate marriages [ ]
E. Hunting animals

2. Answer items (i) -(v) by matching the name of layer of the atmosphere in List A and its description in list B by writing the letter of the correct answer in brackets.

Group A	letter	Group B
(i) Thermosphere	[ ]	A. A layer where all human activities takes place. B. A layer which prevents X-rays and ultraviolent from reaching the earth surface. C. It prevents the earth to be hit by heavenly bodies D. It contains carbon dioxide E. It reflects radio waves F. It contains ozone layer. G. It is the only layer with water bodies
(ii) Troposphere	[ ]	
(iii) Ozone Layer	[ ]	
(iv) Stratosphere	[ ]	
(v) Mesosphere	[ ]	

CamScanner

SECTION B (20 Marks)

Answer all questions in this section.

3. Answer items (i) – (iii) by providing brief explanations.

i. Who led the Nyamwezi society in fighting against German colonial invasion at Unyanyembe in in 1884? _____

ii. When does the sun become overhead at the tropic of cancer? _____

iii. What was the main objectives of missionaries in Africa?

_____

4. Answer items (i) – (iii) by providing brief explanations

i. Suggest two ways which many be used in conserving the forests resource in Tanzania.

a)_____

b) _____

ii. Mention two countries that used armed struggle for demanding independence from their colonial masters.

a) _____

b) _____

iii. Write the political party in full that demanded Tanganyika independence.

_____

5. Answer the following questions by writing correct answer.

a. Write two objectives for the reestablishment of East African Community in 2000.

i) _____

ii) _____

b. Describe two methods used to find population data in Tanzania.

i)_____

ii) _____

6. a. What is the best method for preparing foods which are packed in containers and can be preserved during travelling _____

b. Outline two methods that can be used to remove stain on iron box

i) _____

ii) _____

CamScanner

SECTION C (10 Marks)

7. Below is a sketch map of Tanzania. Study it and answer items (a) – (e) that follow.

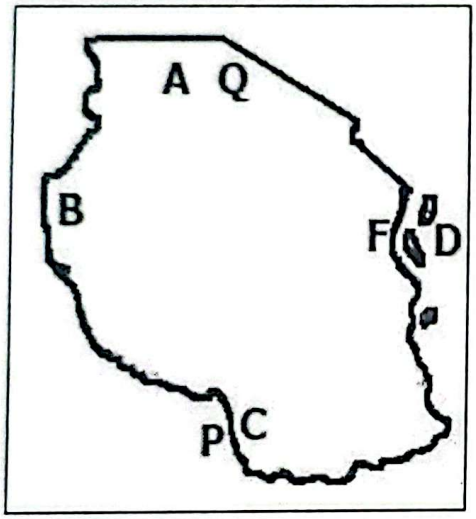

Questions;

(a) Which mode of production was practiced in area marked letter D?

_____

(b) Identify the National Park found around the place marked by letter Q.

_____

(c) Name the country bordering Tanzania found around place P _____

(d) Mention two economic activities practiced in or around the area labeled by letter A.

i) _____

ii) _____

(e) Name two out of the four climatic zones found in Tanzania.

i) _____

ii) _____

CamScanner

Candidate's Index Number _____

STANDARD SEVEN JOINT EXAMINATION AMONG CARMEL, ST. MONICA, ST. AUGUSTINE, ST. ARNOLD JANSEN, MARY IMMACULATE, NEJOLA AND SHEPHERD SCHOOLS CONDUCTED ON 25TH APRIL 2026.

SUBJECT: SCIENCE AND TECHNOLOGY

. SECTION A: ANSWER OPTION [20 Marks]
Answer all questions

1. Answer the following questions by writing the letter of the correct answer.

i. A pupil witnessed the school building collapsing after being hit by lightning. What do you recommend to be done to buildings so that such incidences do not occur in other buildings?
A. They should be constructed using stones
B. They should be constructed using thick walls
C. They must have walls to protect lightning [ ]
D. They must be installed with earth wire
E. They must be installed with lightning rod

ii. Small particles of iron have entered into the eyes of a steel rod factory worker and he needs help. What would you do to help him?
A. Wash his face using clean water and soap
B. Use a magnet that will attract those particles [ ]
C. Use cotton buds to remove the particles
D. Use clean cloth to wipe inside the eye
E. Make the person bend for the particles to fall down

iii. John looked at the surface of stagnant water and saw his image. Which characteristic of light is displayed by this action?
A. Travelling B. Bending C. Passing D. Reflection E. Absorption [ ]

iv. Which reason makes biogas to be better than firewood as a source of energy?
A. It does not produce smoke when used
B. it gives out oxygen gas
C. it gives out carbon dioxide gas
D. it is costless in production [ ]
E. it is used in small quantity

v. A plant absorbs water molecules from the soil through roots to different parts. Which way does the plant use to absorb water?
a. Osmosis B. Diffusion c. Distribution D. Propagation E. Sucking [ ]

vi. Which action results into the formation of a new matter?
A. Dissolving sugar in water
B. souring of milk [ ]
C. the change of water to vapour
D. adding to salt in food E. building a mixture of wax and water

vii. Your friend asked you for assistance to open Microsoft Excel. Which steps would you follow?
A. Click start menu → Microsoft office → Microsoft Excel
B. Click start menu → Microsoft word → Microsoft Excel
C. Click start menu → Microsoft Excel → Microsoft office
D. Click start menu → Microsoft Excel → Microsoft word
E. Click start menu → Microsoft office → Microsoft word
[ ]

CamScanner

viii. The head teacher at Shalom Primary School wants to change the system of keeping pupils attendance records from the manual attendance book to the electronic system. Which electronic machine would you advise to be used?

A. Television B. Computer C. Decoder D. System unit E. Router [ ]

ix. The Science and Technology teacher has requested you to have a Gmail account. What first step would you follow to get the account?

A. To visit the www.gmail.com website
B. To fill the information needed in the Gmail form [ ]
C. To fill the phone number and birthdate in the Gmail form
D. To choose the type of address you want in the Gmail form
E. To visit the website www.yahoo.com and write the password correctly

x. The news broadcast reported that most of the radios in Magunga village use the small loop type antenna. What disadvantage do they experience due to the use of that type of antennae?

A. They cause defect of radio B. they cause loss of electrical energy [ ]
C. they destruct speakers D. they have high maintenance cost E. They have electromagnetic interference

2. Match the following items to answer the questions

LIST A		ANS	LIST B
(i)	Final products of photosynthesis	[ ]	A. Stem
(ii)	Storage of food for maize, rice, beans, and wheat	[ ]	B. Leaves
(iii)	Storage of food for carrot, ginger and sugar cane	[ ]	C. Oxygen and starch
(iv)	Storage of food for sisal and onions	[ ]	D. Osmosis
(v)	Process used to absorb water and mineral sats from the soil	[ ]	E. Seed

3. Complete the items (i) - (v) by choosing the correct word given in the box and write it beside the item in the space provided.

Brain, Spinal cord, Vertebral column, Sensory nerve, Iris, Myopia, Cornea

a. Part of central nervous system protected within the vertebral column _____

b. The part that controls the amount of light passing through the eye _____

c. The organ in the human body that coordinates all body actions _____

d. A nerve that carries information from the central nervous system and transmits it to other parts of the body _____

e. Bone joints that are connected from the neck to waist _____

CamScanner

SECTION B: SHORT ANSWERS [20 Marks]

4. Fill in the blanks to answer the following questions.

i. In one way, explain why a mobile phone is more advantageous compared to other communication devices.

_____

ii. Write the functions of the following parts of a mobile phone;

a) Dial pad_____

b) Sim card _____

iii. What computer applications is the best for recording results for pupils? _____

5. Fill in the blanks to answer the following questions

i. Where do plants such as sisals or aloe vera store their water in order to be used when there is shortage of water? _____

ii. Usher has established a vegetable garden. Advise him on the best time to water plants.

_____

iii. Waziri is studying the behaviour of animals about Camouflage, migration, hibernation, estivation and development of body coverings. How can you call these behaviours in relation to adaptation? _____

iv. Majige is teaching the topic of Air. Help the kids get an idea of what is air?

_____

6. Write the correct answers of the below items

i. Safety signs are used in different places and on items available in our environment. Explain **two precautions** that you will take when using drugs or chemicals having a toxic sign.

a) _____

b) _____

ii. (a) After a long illness Pierre was taken to hospital and the doctor told him that his pancreas has failed to produce enough insulin. Which disease is Pierre likely to suffer from?

_____

(b) A person bitten a snake is not allowed to lift up the bitten body part. Why?

_____

iii. Write down two applications of the law of floatation in water transport

_____

CamScanner

SECTION C: CALCULATIONS AND DIAGRAMS (10 Marks)

7. The figure below shows relationship between two forces that act in opposite direction on an object immersed in water. Use it to answer items (a) – (c).

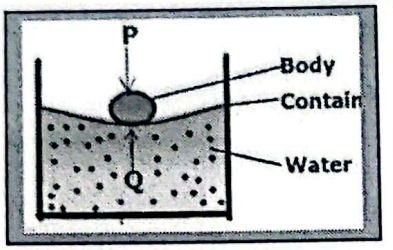

(a) Identity the force represented by each letter;

i. P: _____

ii. Q: _____

(b) What happens to the body if the force P is greater than the force represented by letter Q? _____

(c) Upthrust is associated to mass of water displaced by a floating or sinking object. Suppose an object displaces 1.2kg of water, find the upthrust exerted by water on the object in Newton. ($g=10m/s^2$)

8. **Study the diagram below and answer items (a) and (b) that follow;**

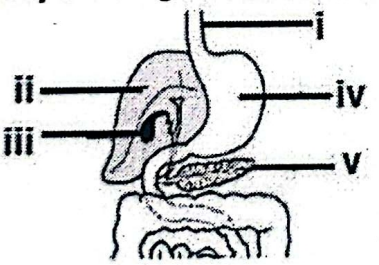

(a) Which number labelled represents a part where chemical digestion of fish and meat begin? ____

(b) Mention the major role of part marked **ii** in body system. _____

CamScanner

Namba ya mtahiniwa: _____

MTIHANI WA UJIRANI MWEMA KATI YA SHULE ZA CARMEL, MT. MONICA, MT. AUGUSTINE, MT. ARNOLD JANSEEN, MARY IMMACULATE, NEJOLA NA SHEPHERD ULIOFANYIKA TAREHE 25 APRILI, 2025.

SOMO: KISWAHILI DARASA LA SABA.

1. Sikiliza kwa makini hadithi utakayosomewa na msimamizi kisha jibu swali la 1 – 5 kwa kuandika herufi ya jibu sahihi.

i. Maktaba ya shule ilianzishwa na nani?
A. Watu wazima B. Mhudumu wa maktaba C. Mwalimu wa zamu
D. Wanafunzi wa Kilimahewa E. Mwalimu mkuu [ ]

ii. Kifaa kilichotumika kuhifadhia vitabu vya shule ndani ya maktaba kinaitwaje?
A. Kabati B. Rafu C. Begi D. Kabati E. Maktaba [ ]

iii. Mwalimu aliwatia shime wanafunzi wakajisomee. Nahau 'tia shime' kama ilivyotumika kwenye habari hii ina maana gani?
A. Alionya B. Aliwapenda C. Aliwahimiza D. Aliwalazimisha E. Aliwakataza [ ]

iv. Mwalimu aliyeanzisha mpango wa maktaba alijulikana kwa jina gani?
A. Mhudumu wa maktaba B. Kilimahewa C. Mkutubi D. Mchapishaji E. Majige [ ]

v. Chumba maalumu kinachotumika katika kuhifadhia na kuazimisha vitabu na kujisomea huitwaje?
A. Maktaba B. Mkutubi C. Rafu D. Maabara E. Darasa [ ]

2. Katika kipengele cha (i) – (x), chagua jibu sahihi kisha andika herufi yake katika kisanduku ulichopewa.

i. Kipi ni kiambishi cha wakati katika neno 'wanapika'?
A. A- B. -li C. Tu- D. -ma E. -na- [ ]

ii. Watoro wameadhibiwa. Neno 'watoro' limetumika kama aina gani ya maneno?
A. Kiunganishi B. Kielezi C. Kiwakilishi D. Kivumishi E. Nomino [ ]

iii. Mkono mtupu haulambwi. Sentensi hii iko katika kauli gani?
A. Kutenda B. Kutendeka C. Kutendewa D. Kutendwa E. Kutenda [ ]

iv. Ni sehemu ipi ya sentensi inabeba mtenda?
A. Kiambishi B. Kishazi C. Kitenzi D. Kiarifu E. Kiima [ ]

v. Wakazi wa Mafisa walilipwa _____ baada ya nyumba zao kubomolewa ili kupisha upanuzi wa barabara. Neno lipi linakamilisha sentensi hii?
A. Fidia B. Faida C. Posho D. Mafao E. Ujira [ ]

vi. Soma mazungumzo yafuatayo kisha jibu swali linalofuata:
A. Kijiji cha Kibaoni kina kimezungukwa na ardhi yenye rutuba. Hata hivyo wanakijiji wa Kibaoni wameshindwa kulima mazoa na wanasumbuka na baa la njaa miaka nenda miaka rudi
B. Wameshindwa kutumia rasilimali lukuki walizonazo kutatua changamoto walizonazo
Methali ipi kati ya zifuatazo inahusiana na kauli iliyotolewa na B?
A. *Mtaka cha uvunguni* sharti ainame B. Leo ni leo msema kesho muongo [ ]
C. *Ukiona vyelea* vimeundwa D. Penye miti hakuna wajenzi
E. *Ajizi nyuma ya njaa*

vii. *Mwizi alikamatwa alipokuwa anajaribu* _____ viatu vilivyokuwa vimerundikwa ukutani. Neno lipi *linakamilisha sentensi hii?*
A. Kuchora B. Kuzogoa C. Kuchoropoa D. Kuropoa E. Kupurura [ ]

viii. *Majige anapenda kukaa bure* _____ ana nguvu za kufanya kazi. Neno lipi linakamilisha *sentensi hii?*

CamScanner

A. Angalau B. Pamoja C. Iwapo D. Ijapokuwa E. Isipokuwa [ ]

ix. Kipi ni kisawe sahihi cha Kelbu
A. kiti B. Mbwa C. Mori D. refa E. Fito [ ]

x. Ninyi ni vijana shupavu sana. Sentensi hii ipo katika nafsi ipi?
A. Ya kwanza Umoja B. Ya kwanza wingi C. Ya tatu wingi
D. Ya pili wingi E. Ya pili Umoja [ ]

3. Oanisha misamiati iliyopo Orodha A na maana zake kutoka Orodha B kwa kuandika *jibu* sahihi kwenye mabano.

ORODHA A		JIBU	ORODHA B
i.	Ngariba	[ ]	A. Mtu anayepanga, kuratibu na kusahihisha nyenzo za kuchapishwa katika vitabu, magazeti, majarada au kwenye tovuti.
ii.	Tarishi	[ ]	B. Mtu anayehudumu kwenye chombo cha usafirimajini hasa baharini.
iii.	Mhariri	[ ]	C. Mhudumu wa ofisini amabaye hutumwa kupeleka barua.
iv.	Mhenga	[ ]	D. Mtu mwenye uwezo na ujuzi wa kutahiri kimila.
v.	Baharia	[ ]	E. Mtu wa kale na mwenye busara katika jamii
			F. Mtu wa kisasa mwenye maarifa na ujuzi mwingi katika jamii.

4. Andika kinyume cha maneno yafuatayo kwa kuandika jibu sahihi nafasi iliyoachwa wazi.

i. Duwaaa _____
ii. Ghali _____
iii. Kiangazi _____
iv. Bembeleza _____
v. Chali _____

5. Soma kwa makini shairi lifuatalo kisha jibu swali la kipengele cha (i) – (v)

Mtihani umefika, tumekaa darasani,
Kiswahili twaandika, lugha yetu ya thamani,
Vijana hebu amka, na kalamu mkononi,
Msome bila pumbao, msikalie maneno.

MASWALI

i. Nani mtunzi wa shairi hili? _____
ii. Mwandishi aliposema 'vijana hebu amka, na kalamu mkononi' anawataka vijana wafanye nini?
_____
iii. Andika vina vya mwisho katika shairi hili _____
iv. Andika muundo wa shairi ulilolisoma _____
v. Shairi hili linaundwa na aya ngapi? _____

6. Wewe ni Anna Wambura wa S.L.P 200 Usagara, andika simu ya maandishi kwa shangazi yako aitwaye Tatu Mazengo mwenye anwani S.L.P 45 Ushetu ukimjulisha kuwa kaka yako anaumwa na hivyo unamtaarifu aje kumuona Hospitalini Bugando.

a) _____
b) _____
c) _____
d) _____
e) _____

CamScanner

UFAHAMU WA KUSIKILIZA

Shule ya msingi Kilimahewa ina chumba maalumu cha maktaba ya kujisomea. Katika chumba hicho kuna rafu mbili kubwa. Rafu hizo hutumika kuhifadhia vitabu vya kiada vya masomo mbalimbali. Vile vile kuna vitabu vya kujisomea kwa ajili ya elimu ya watu wazima. Kila somo lina vitabu vya kiada na rejea. Maktaba hii ilianzishwa na Mwalimu mkuu Majige. Mwalimu Mkuu huyo alianza kwa kuwatembelea wachapishaji wa vitabu nchini. Mwalimu Majige aliwapa moja na kuwatia shime wanafunzi wakajisomee maktaba kwa ruhusa ya mhudumu wa maktaba

CamScanner

Candidate's Index Number: _____

STANDARD SEVEN JOINT EXAMINATION AMONG CARMEL, ST. MONICA, ST. AUGUSTINE, ST. ARNOLD JANSEN, MARY IMMACULATE, NEJOLA AND SHEPHERD SCHOOLS CONDUCTED ON 25TH APRIL 2025

SUBJECT: CIVIC AND MORAL EDUCATION

SECTION A (20 Marks)

Answer all questions in this section.

1. **For each of the items (i) – (x), choose the correct answer and write its letter in the box provided.**

i. The implementation of democracy in any country has its indicators. The following indicate the broadening of democracy in Tanzania except _____
A. Presence of integrity to the leaders B. Presence of free and fair election
C. Presence of freedom of expression D. Presence of rule of law [ ]
E. The implementation of human rights

ii. Which of the following acts implies caring for other people?
A. Rescuing them from danger B. Greeting teachers respectfully C. Sweeping the classroom daily D. Ironing school uniform E. Carrying friends' exercise books [ ]

iii. Who is responsible to discuss and make decisions on the development issues in the leadership structure of the district government?
A. District administrative secretary B. Executive director C. Division officer
D. District commissioner E. Advisory committee [ ]

iv. People with special needs feel good and confident when they are loved and valued in the community. Which acts should be avoided when serving this group of people?
A. Giving them appropriate health services B. Electing them in political posts C. Segregating them in leadership positions D. Assisting them in legal matters E. Choosing proper words when communicating with them [ ]

v. Which of the following is not a child's responsibility in a family?
A. Caring for the young ones B. Participating in cleanliness C. Caring for their livestock
D. Preparing food E. Digging a garbage pit [ ]

vi. The following are important school rules which need to be followed by pupils except _____
A. Not to fight at school B. Coming late to school C. To attend class lessons
D. To wear appropriate school uniform E. To respect school leaders [ ]

vii. The responsibility of the school leadership is to ensure discipline and good performance in academic. What is the responsibility of the academic teacher at school? [ ]
A. To monitor the health of pupils B. To supervise the classroom activities C. To supervise school cleanliness D. To promote sports in the school E. To link teachers and parents

viii. Why does the national flag sometimes fly at half – mast?
A. To mourn the death of the national leader B. To commemorate the death of a national leader
C. To celebrate the birthday of the national leader D. To mark the country's national festivals
E. To celebrate the Independence Day [ ]

CamScanner

ix. Environmental degradation is caused by different human activities such as burning the forest. What should be done in order to solve this problem? [ ]

A. To collect and burn wastes B. To cook by using charcoal C. To apply industrial fertilizers in agriculture D. To dispose the wastes in pits E. To provide environmental conservation education

x. Which one is not a challenge facing the community in conserving the environment?

A. Unplanned settlements B. High cost of renewable energy C. The use of solar energy
D. Poverty E. Poor infrastructure [ ]

2. Match items of List A against their corresponding ones in List B

LIST A		ANS	LIST B
(i)	Sex	[ ]	A. Dressing, behaving and speaking modestly B. Irresponsible sex, drinking alcohol, drug abuse and fighting C. Biological make of being a man or woman D. Collection of several people who are genetically related E. Studying hard F. Duties of man or woman as decided by the society or culture
(ii)	Gender	[ ]	
(iii)	Extended family	[ ]	
(iv)	Risky behaviours	[ ]	
(v)	Respect	[ ]	

3. Choose answers from the box to answer the questions (i) – (v)

District Commissioner, Village chairperson, Division officer, District Administrative Secretary, District A dvisory Committee, ward councilor, Regional Commissioner

i. Is a marriage counselor in the district and helps local government to fulfill their legal duties _____

ii. He/she advises the member og parliament on development issues about his/her ward _____

iii. Advises the district commissioner on peace and security issues and prepares national festivals _____

iv. Is responsible for decisions made for the development of the district _____

v. Monitors performance of ward, village and street executive officers in his division _____

CamScanner

SECTION B (20 Marks)

Answer all questions in this section

4. **The following are the procedures for electing a member of parliament which are not arranged in a chronological order. Arrange them in the logical sequence from the first to the last by using A, B, C, D, E.**

(i) Each candidate appoints one person to be his or her agent in each polling station

(ii) Each candidate fills in the forms collected from Independent National Electoral Commission after being nominated by a registered political party.

(iii) The winner of parliamentary election declares his or her commitment to serving the people and takes an oath of allegiance before the Speaker of the Parliament of the United Republic of Tanzania before starting to discharge his or responsibilities.

(iv) Each candidate campaigns in his or her constituency and talks to the people about the ideology and election manifesto of his or her party.

(v) The result of each candidate are announced after votes have been counted and verified.

Answers for question number 4.

Question	(i)	(ii)	(iii)	(iv)	(v)
Answer					

5. **Write the correct answers in the spaces provided**

i. Differentiate analytical learning from rote learning.

_____

_____

_____

ii. Outline two responsibilities of the parliament in promoting and protecting human rights.

a) _____

b) _____

iii. Outline two acts that promote peace and security in the country

a) _____

b) _____

iv. What are the two uses of national currency?

a) _____

b) _____

v. Outline two children's responsibilities at home.

a) _____

b) _____

CamScanner

SECTION C (10 Marks)
Answer all the questions

6. Study the following picture and answer items (a) – (e) by writing the correct answer in the blanks.



Questions

a) Name the risky behaviour shown in the above picture _____

b) How can the behaviour shown affect you as a child if you try it or your friends do so?

_____

c) What should be done in your capacity as a good child to avoid such behaviours?

_____

d) What can you do to help fellow pupils found in such acts?

_____

e) Outline two other risky behaviours a part from the one shown above.

i. _____

ii. _____

CamScanner

Candidate's Index Number: _____

STANDARD SEVEN JOINT EXAMINATION AMONG CARMEL, ST. MONICA, ST. AUGUSTINE, ST. ARNOLD JANSEN, MARY IMMACULATE, NEJOLA AND SHEPHERD SCHOOLS CONDUCTED ON 25TH APRIL 2026.

SUBJECT: ENGLISH LANGUAGE

SECTION A (20 MARKS)

Answer all questions in this section.

1. Listen carefully to the passage read by the invigilator and then answer item (i) – (v) by choosing the letter of the correct answer and write it in the box provided.

i. What does Sheila do when she has a problem?
A. She goes out B. She asks permission C. She thanks her teacher
D. She asks for help from her teachers E. She borrows a pen [ ]

ii. What makes Sheila a good example?
A. She respects everyone B. She borrows things C. She likes playing
D. She has a problem E. She asks for help [ ]

iii. According to the story, who should children respect in the society?
A. All the pupils B. Only the teachers C. All the people
D. Only the friends E. All the neighbours [ ]

iv. In which class was Sheila studying?
A. Class three B. Class four C. Class five D. Class six E. Class seven [ ]

v. According to the story, how should a good child do after being helped?
A. Should be happy B. Should be jealousy C. should be helpful
D. Should be thankful E. Should be strong [ ]

2. For each of the items (i) - (v), choose the correct answer and write its letter in the box provided.

i. The teacher told us to open the book _____ page five.
A. On B. In C. Into D. At E. Onto [ ]

ii. The seldom washes her face after waking up in the morning. Which is the correct antonym of the underlined words.
A. Sometimes B. Rarely C. Never D. Hardly E. Often [ ]

iii. No sooner had the trains arrived than she had _____
A. Runs B. Run C. Rans D. Running E. Ran [ ]

iv. Our desks can accommodate three pupils only. Therefore, I sit in the middle _____ Anna and Jane.
A. Among B. Between C. Besides D. Beside E. Within [ ]

v. There were seven men in the room. One of _____ wore broken sunglasses.
A. They B. The man C. them D. Their E. Within [ ]

3. For items (i) – (v), complete the sentences by choosing the correct words given in the box.

In, distance, meteorologist, inherited, discussed, activities, affecting, on

i. The pupils _____ on the imaginary lines that run from the North to the South which meet at the earth's poles.

ii. A _____ asked pupils to measure the amount of atmospheric pressure for that day

iii. Culture is a way of life, an identity and national value that is _____ from one generation to another

iv. TANU was formed _____ 1954.

CamScanner

v. Pupils measured the _____ in a village map from the water well to the dispensary

4. Match each of the following words with their correct meaning.

LIST A	ANS	LIST B
(i) Celebration		A. Forecast or say something will happen in future
(ii) Predicting		B. Normal weather condition in a particular place
(iii) Meteorologist		C. Letting loose or allow something to be free
(iv) Climate		D. A person who studies weather
(v) Release		E. Special events that people organize to mark an occasion

SECTION B (20 Marks)

Answer all questions in this section

5. Complete the following sentences by changing the verbs in brackets into appropriate form.

i. Does the chief clerk _____ whether his uniform is torn? (know)
ii. When I reached home, the dog had already _____ my food. (eat)
iii. If he _____ we shall join them for dinner. (come)
iv. She was hurt _____ by a knife. (hurt)
v. The girl _____ in the rain for five minutes yesterday. (stand)

6. Read the following poem carefully and then answer the questions.

Oh AIDS! You are too fast and too greedy
Have you no heart? Have you no mercy?
You strike all, the young and the old
You don't choose.

What did the unborn babies do to you?
AIDS Scientists have gone to moon
Make computers and other inventions
Your cure is still a question they're yet to solve
Oh AIDS You're sweeping across our continent
Just to kill, kill, kill and kill

QUESTIONS

i. What is the poem about? _____
ii. How many stanzas are in the poem? _____
iii. What is still a question to scientists? _____
iv. What figure of speech is indicated in the first verse of stanza two _____
v. What is the part of speech of the word greedy as used in the poem above? _____

SECTION C (10 Marks)

7. This section has five mixed sentences (i) – (v). Arrange these sentences so as to make a good composition by giving them letters A – E.

i. In his speech, he promised to buy the products produced by the pupils. [ ]
ii. Standard seven pupils had a cooking project. [ ]
iii. The head teacher talked to the pupils. [ ]
iv. The pupils thanked him and invited him again. [ ]
v. They invited the head teacher to see the project. [ ]

CamScanner

PASSAGE

Everybody is supposed to behave well in any given circumstances. The act of conducting and presenting yourself with respect and honour is what is called manners. Let us talk about Sheila, a class six girl from Mwenge Primary School. She is a good example of a girl with good manners. When she has a problem, she seeks help from her teachers. If it happens that she wants to go to the washroom or borrow something she will say "Please sir may I go out"? or "Please madam, may I borrow a pen from Ashura?" when she borrows something from a fellow pupil, she uses it and carefully returns it and says "Thank you very much for your kindness". By behaving this way, she is liked by her teachers, her fellow pupils and everyone at home including her neighbours.

CamScanner

Candidate's Index Number _____

STANDARD SEVEN JOINT EXAMINATION AMONG CARMEL, ST. MONICA, ST. AUGUSTINE, ST. ARNOLD JANSEN, MARY IMMACULATE, NEJOLA AND SHEPHERD SCHOOLS DONE ON 25TH APRIL 2026.

SUBJECT: MATHEMATICS

SECTION A: MATHEMATICAL OPERATION [10 MARKS]

Answer all questions

NO	Question	Working space	Answers
1.			
i.	23 784 + 768 + 10 016 =		
ii.	1.999 + 8.001 =		
iii.	46.25 – 8.06 =		
iv.	3.056 x 0.25 =		
v.	0.81 ÷ 0.27 =		
vi.	2 337 ÷ 123 =		
vii.	-23 + (-15)=		
viii.	$3^1/_3 + 5^5/_3$ =		
ix.	9681 + 319 =		
x.	$4\ ^2/_5 \div \frac{11}{15}$ =		

CamScanner

	SECTION B: WORD PROBLEM [30 Marks] **Answer all questions**		
2.			
i.	Find the sum of all even numbers between 900 and 906.		
ii.	Maryam has sh 550,000. She bought 1 television set for sh 162,000, 1 camera for sh 45,700 one sofa set for sh 87,900 one ring for sh 68,500 and 3 pairs of shoes for sh 20,000 each. How much money did she remain with in shillings?		
iii.	NBC bank divided the profit to its three customers John, Anna and Susan. John got 30,000; Anna got sh 60,000 and Susan got sh 90,000. If each customer gave $1/3$ of the profit to the hospital, how much money was sent to the hospital shillings?		
iv.	Write the place value of 5 in 353.34		
v.	The volume of a cubic water well is $64m^3$. What is the length of one side of water well?		
vi.	Jane arrived at school at 8:30 in the morning being late for 30 minutes. At what time was she supposed to arrive at school?		
3.			
i.	If a=5, b=3 and c=2, find the value of of (abc) ÷ b		
ii.	What is the short form of the expanded number 90000 + 60 + 3000 + 7?		

CamScanner

iii.	Write in digit the number with the following place values: 8 million 4 hundred thousand 3 ten thousand 4 tens 2 ones 3 hundreds		
4.			
i.	If your average score in exams is 93.239%, how do you express it to the nearest tenth?		
ii.	A class has 16 boys and 28 girls. What is the ratio of boys to the number of girls?		
iii.	A train reached Kigoma station at 1848 hours. At what time in 12-hour system did the train reach Kigoma station?		
5.			
i.	Kibaoni primary school has 690 pupils. If $^2/_3$ of the pupils are girls, how many pupils are boys?		
ii.	What is the biggest number formed by the digits 7, 9, 6, 0, 8 and 3?		
iii.	Which simple fraction is equivalent to $^3/_5$%?		
6.			
i.	If Upendo is thrice as old as Junior and Junior is 12 years old, what is their total age?		
ii.	A worker arrived at work station around 8:20 pm. If was late for 45 minutes, at what time was supposed to arrive at work station?		
iii.	Jerome posses a journal having 290 pages. If each page has 140 words, how many words does the journal contain?		

CamScanner

SECTION C: FIGURES AND STATISTICS

7.

i. The following table shows the number of tourists who visited Ngorongoro national park in a certain month. Study it and then answer the questions.

Days	Mon	Tue	Wed	Thurs
Number of tourists	697	2,115	3,346	465

How many more tourists visited the national park on Wednesday than on Monday?

ii. Mgeta harvested 4500kg of vegetables as shown below. Find the quantity of onions he harvested in kilograms.

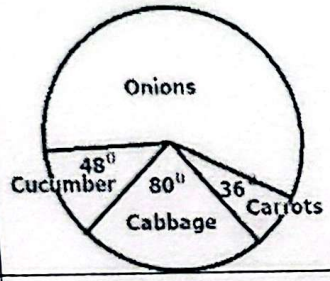

8.

i. Find the area of the shaded part in the figure below. $\Pi = {}^{22}/_{7}$

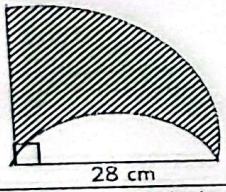

ii. Figure ABCD below is a square. Find its perimeter in centimeters.

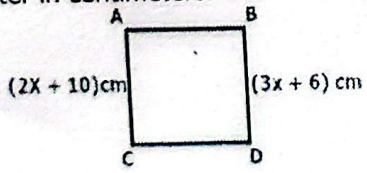

iii. Find the size of angle k in the figure below;

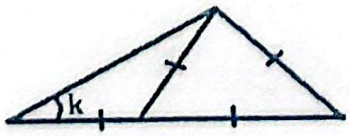

CamScanner