*Jina la Shule*_____

*Jina la Mwanafunzi*_____

*Namba ya Upimaji*_____

*Mkoa*_____

Halmashauri _____

KEYS EDUCATIONAL AND STATIONERY SERVICES (KESS)

REGISTRATION NUMBER: 473801

Barua pepe: keyseducationalservices@gmail.com

SIMU NA: 0758587618/0679587618

KIFURU-KINYEREZI, DAR ES SALAAM

UPIMAJI WA KWANZA WA UTAMILIFU DARASA LA NNE

A07 HISTORIA YA TANZANIA NA MAADILI

Muda: Saa 1:30 **Ijumaa 24 Aprili, 2026**

Maelekezo

1. Karatasi hii ina sehemu A, B na C zenye jumla ya maswali **sita** (6)
2. Jibu maswali **yote** katika kila sehemu.
3. Andika majibu katika nafasi zilizotolewa katika kila swali.
4. Majibu yote yaandikwe kwa kutumia kalamu ya wino wa **bluu** au **mweusi**.
5. Vifaa vya mawasiliano na vitu vyote visivyoruhusiwa **havitakiwi** katika chumba cha upimaji
6. Andika **Jina lako, Namba ya Upimaji, Mkoa** na **Halmashauri** katika sehemu ya juu ya kila ukurasa.

KWA MATUMIZI YA MPIMAJI TU		
NAMBA YA SWALI	ALAMA	SAINI YA MTAHINI
1.		
2.		
3.		
4.		
5.		
6.		
JUMLA		
SAINI YA MHAKIKI		

CamScanner

SEHEMU A (Alama 20)

Jibu maswali **yote** katika sehemu hii

1. Jibu vipengele (i) - (x) kwa kuchagua jibu sahihi na kuandika **herufi yake** katika kisanduku ulichopewa.

(i) Nyumba za asili zenye umbo la duara juu na chini huitwaje?
A. Msonge
B. Tembe
C. Banda
D. Manyata

(ii) Mambo ya lazima ambayo mtu hupaswa kuyatenda ili kukabili mazingira yanayomzunguka huitwaje?
A. Maadili
B. Haki
C. Wajibu
D. Vitendo

(iii) Ili mtoto apate maarifa na ujuzi utakaomwezesha kuchangia katika maendeleo yake binafsi, ya jamii na taifa kwa ujumla anapaswa kupatiwa haki ipi?
A. Haki ya kutobaguliwa
B. Haki ya kupata elimu na kujielimisha
C. Haki ya kusikilizwa
D. Haki ya kuabudu

(iv) Vyombo vya habari vinavyoweza kusaidia kutoa elimu ya namna ya kuzuia na kupambana na rushwa na madhara ya rushwa ni pamoja na:
A. Matamasha ya kitaifa
B. Nyimbo na ngonjera
C. Hadithi na mashairi
D. Redio na runinga

(v) Jengo lililopo Bagamoyo ambalo lilikuwa hoteli ya wafanyabiashara ya watumwa waliotoka nchi za Uarabuni linaitwaje?
A. Azania Front
B. Husuni kubwa
C. Caravan Serai
D. Ngome ya Yesu

(vi) Jamii zipi za Kitanzania zilikuwa na sayansi na teknolojia asilia ya kilimo cha umwagiliaji kwa kuhifadhi maji kwenye mabwawa yaliyojengewa kingo kwa mawe wakati wa mvua za msimu ili yatumike kipindi cha ukame?
A. Wamasai na wagogo
B. Wairaqw na wasonjo
C. Wahehe na wakinga
D. Wachaga na wapare

(vii) Sayansi na teknolojia ya asili ya kutengeneza moto iligundulika katika kipindi kipi cha zama za mawe?
A. Zama za mawe za kale
B. Zama za mawe za mwisho
C. Zama za mawe za kati
D. Zama za chuma

(viii) Kitendo cha kijana au mtoto kumsaidia mizigo na kazi mbalimbali mzee na mtu aliyemzidi umri huonesha nini?
A. Kukosa maadili
B. Upendo na ukatili
C. Chuki na maringo
D. Upendo na heshima

(ix) Maarifa na ujuzi wa asili wa mazingira katika jamii za kale ulikuwa na umuhimu gani?
A. Kutambua majira ya mwaka
B. Kutengeneza mvua
C. Kuharibu vyanzo vya maji
D. Kuepuka baridi

(x) Dawa za asili katika jamii za Kitanzania zilitengenezwa kwa kutumia nini?
A. Mizizi, majani na magome ya miti
B. Ngozi za wanyama, vidonge na maji
C. Vidonge, sindano na asali
D. Asali, vidonge na maziwa

CamScanner

2. Oanisha maelezo kuhusu urithi wa kihistoria katika **Orodha A** na maeneo urithi huo unapopatikana kutoka katika **Orodha B** kwa kuandika herufi ya jibu sahihi kwenye mabano.

Na.	Orodha A	Majibu	Orodha B
(i)	Eneo ambalo lina nyayo za binadamu anayeaminika kuishi kwa miaka mingi zaidi duniani	( )	A. Bagamoyo
(ii)	Mahali ambako kuligunduliwa masalia ya fuvu la binadamu wa kale	( )	B. Engaruka
(iii)	Eneo ambalo kuna kumbukumbu za michoro ya mapangoni yenye urithi wa kihistoria unaoonesha shughuli za jamii za kale	( )	C. Bonde la Olduvai
(iv)	Eneo ambalo kuna urithi wenye historia unaohusu Zana za Mawe zilizotumiwa na binadamu wa kale	( )	D. Bonde la Isimila
(v)	Eneo lililokuwa maarufu kwa kilimo cha umwagiliaji	( )	E. Laetoli
			F. Kondoa Irangi
			G. Kaole

3. Jibu maswali katika vipengele (i)- (v), kwa kuchagua dhana sahihi zinazohusu maarifa na ujuzi wa asili katika dawa zilizoorodheshwa katika kisanduku na kuandika katika nafasi uliyopewa.

Kusugua	Kutwanga	Kusaga	Kuoga
Kupaka	Kuchua	Kufukiza	

(i)Kusugua juu ya ngozi kwa kutumia mikono yenye dawa kwa ajili ya kuondoa maumivu
_____

(ii)Kumfanyia mgonjwa dawa kwa kumgubika kwenye mvuke_____

(iii)Kumwagia kitu mwilini, mfano maji au dawa, kwa lengo la kusafisha au kuondoa uchafu
_____

(iv)Kusugua taratibu kitu kama mafuta au unga juu ya kitu kingine_____

(v)Kupigapiga ndani ya kinu kwa kutumia mchi kwa lengo la kutoa maganda, kupata unga au kulainisha_____

SEHEMU B (Alama 18)

Jibu maswali **yote** katika sehemu hii

4. Chunguza kielelezo kifuatacho cha mti wa familia kisha jibu maswali katika vipengele (i) - (iv)

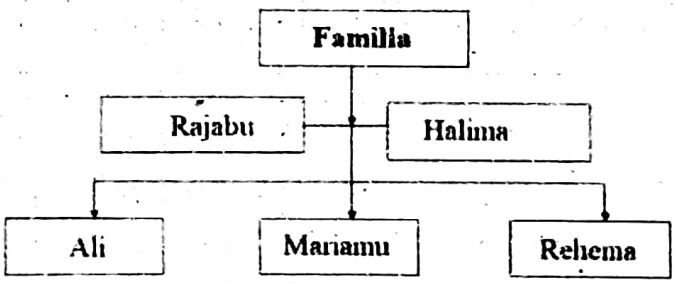

(i) Familia inayoonekana katika mchoro huu inaundwa na jumla ya watu wangapi?_____

(ii) Baba wa familia hii ni nani?_____

(iii) Halima anamuita jina gani Rajabu linalowakilisha uhusiano wao kama wanafamilia?
_____

(iv) Mariamu na Rehema wanamuita jina gani Ali linalowakilisha uhusiano wao kama wanafamilia? _____

CamScanner

5. Chunguza picha ifuatayo kisha jibu kipengele (a)- (e) kwa **kuandika majibu sahihi** katika nafasi zilizoachwa wazi.



(a) Ni shughuli gani ya kiuchumi inawakilishwa katika picha? _____

(b) Kifaa gani kinachotumika katika shughuli inayooneshwa katika picha hapo juu?_____

(c) Shughuli inayooneshwa katika picha hufanyika katika maeneo gani?_____

(d) Bidhaa gani inapatikana kupitia shughuli ya kiuchumi inayowakilishwa na picha hii?_____

(e) Njia ipi ya asili ilitumika katika uhifadhi wa bidhaa iliyopatikana kutokana na shughuli ya kiuchumi inayowakilishwa na picha hii kwa matumizi ya baadaye na biashara?_____

SEHEMU C (Alama 12)

6. Soma kwa makini kifungu cha habari kifuatacho, kisha jibu maswali katika vipengele (a) – (f)

Jamii za kale zilitumia zaidi mfumo wa imani za jadi zilizoambatana na miiko katika kujenga maadili ya kulinda na kutunza mazingira. Kwa mfano, miiko ya kimaadili ilitumika kulinda rasilimali adimu kama vile aina ya miti, wanyama na ndege. Kulikuwa na miiko ya kuzuia kufua, kuoga na kujisaidia haja kubwa au ndogo katika mabwawa, mito au maziwa yaliyotumika kwa matumizi ya maji ya nyumbani. Mabwawa mengine yalitengwa kama mahali "patakatifu." Haikuruhusiwa kuvua samaki au kuchafua bwawa "takatifu". Watu waliamini kuvunja maadili yale ni kuhatarisha mazingira.

Imani zilitumika kulinda mazingira. Misitu, milima, mapori, mapango, mabwawa na chemchemi zilitengwa kama maeneo ya "miungu." Maeneo haya yalitengwa kwa ajilli ya kufanyia ibada za asili. Hivyo, maeneo haya yaliheshimiwa na kulindwa na watu wote. Waliamini kuharibu maeneo haya kungesababisha kifo na majanga kama magonjwa kwenye familia na ukoo. Jamii za kale ziliamini kuwa miungu inaishi katika mazingira. Jamii iliamini kuwa uharibifu wa mazingira kama kukata miti ovyo, kuua wanyama ovyo na kuchafua vyanzo vya maji ni chukizo kwa miungu. Waliamini miungu ikikasirika jamii itapata laana na majanga kama ukame, njaa na magonjwa ya mlipuko. Pia, watu waliamini kwamba iwapo mtu ataenda kinyume na kuharibu mazingira, atakufa kwa kuvunja miiko.

Maswali

(a) Jamii za kale zilitumia nini kulinda rasilimali adimu kama vile aina ya miti, wanyama na ndege?
_____

(b) Vitu gani havikupaswa kufanyika katika mabwawa yaliyotengwa kama mahali 'patakatifu'?_____

(c) Maeneo gani yalitengwa kama maeneo ya 'miungu'. Taja maeneo ya mawili
(i)_____ (ii)_____

(d) Maeneo yaliyotengwa kama maeneo ya miungu yalitumika kwa ajili gani?
_____

(e) Nini kingetokea ikiwa maeneo ya miungu yangeharibiwa?_____

(f) Jamii za kale ziliamini kwamba iwapo mtu ataenda kinyume na kuharibu mazingira nini kitamtokea?_____

CamScanner

*Name of the Pupil*_____
*Assessment Number*_____
*Region*_____
*Council*_____

KEYS EDUCATIONAL AND STATIONERY SERVICES (KESS)
REGISTRATION NUMBER: 473801

E- mail: keyseducationalservices@gmail.com
Phone No: 0758587618/0658396694
KIFURU-KINYEREZI, DAR ES SALAAM

STANDARD FOUR FIRST JOINT ASSESSMENT
SCIENCE

S09E

Time: 1:30 Hour **Thursday, 23rd April 2026**

Instructions

1. This paper consists of sections A and B with a total of **six (6)** questions.
2. Answer **all** questions in each section.
3. All answers must be written in the space provided in each question.
4. All answers must be written in **blue** or **black** ink.
5. Communication devices and any unauthorized materials are **not** allowed in the assessment room.
6. Write your **Name**, **Assessment Number**, **Region** and **Council** in the space provided at the right top of every page.

FOR ASSESSORS USE ONLY		
QUESTION NUMBER	**SCORE**	**ASSESSOR'S INITIALS**
1.		
2		
3.		
4.		
5.		
6.		
TOTAL		
CHECKER'S INITIALS		

CamScanner

SECTION A (22 Marks)

Answer **all** questions in this section.

1. Answer the items (i) _ (v) **by choosing the correct answer** and write its letter in the box provided:

(i) Which branch of science deals with composition and properties of matter?

A. Biology
B. Physics
C. Chemistry
D. Geography

(ii) Which of the following scientific devices is used for viewing very small things which cannot be seen by naked eyes?

A. Television
B. Telescope
C. Telephone
D. Microscope

(iii) A pupil was asked to identify five sense organs. Which of the following organs were identified by the pupil?

A. Eye, ear, nose, skin and tongue
B. Brain, skin, nose, mouth and eye
C. Skin, brain, mouse, hand and finger
D. Leg, head, nose, eye and ear

(iv) Which part of the tongue is responsible to detect the sweet taste of honey?

A. The tip of the tongue
B. The front side of the tongue
C. The middle part of the tongue
D. The back side of the tongue

(v) Which one of the following represents a set of external parts of the eye?

A. Iris, pupil and lens
B. Eyebrows, eyelashes and eyelids
C. Retina, iris and pupil
D. Lens, retina and eyebrows

2. Answer the items (i)-(v) by matching the items in **List A** with those in **List B.** Write the letter of the correct answer in the bracket provided

List A	Answers	List B
(i)A device used to play simple ICT games and communication through conversation and texts	( ).	A. Desktop computer
(ii)A software used to play simple ICT games	( )	B. Laptop computer
(iii)A type of computer used in playing simple games that does not have the capacity to store electric charge	( )	C. Telephone
(iv)A type of computer used in playing simple games that is small and potable and can store electric charge	( )	D. Program
(v)A set of instructions that a computer follows to perform a particular function or task	( )	E. Internet
		F. GCompris
		G. Google

CamScanner

3. Answer item (i)- (vi) by choosing the correct answer from the box and write it in the spaces provided

Ingredients of the product, Instruction of using the product, Expiration date Balanced diet, Manufacturing date, Storage information, Nutrients , Carbohydrates, Proteins

(i) A meal containing the right proportions of nutrients is called _____

(ii) The substances in foods that help our bodies work properly are called _____

(iii) Which food nutrients give the body energy? _____

(iv) A top of milk box is written "EXP: 9/2027". What does this mean? _____

(v) A bottle of soda is written "carbonated water, sugar and mango flavor". What do these words represent? _____

(vi) A box of medicine is written " Drink one table spoon, twice a day". What does this statement show? _____

SECTION B: (28 Marks)

Answer **all** questions in this section

4. You have been provided with the six (i) – (vi) jumbled procedures of investigating the importance of oxygen in animals. Arrange the steps in the correct sequence by giving them letter B, C, D, E, F and G in the spaces provided. Item (i) has been as an example

(i) Take two alive grasshoppers, two jars, lid, net and fresh leaves. (**A**)

(ii) Put one grashopper in jar X, then cover it with a net. ( )

(iii) Observe the two grashoppers in the jars after two days ( )

(iv) Put the fresh leaves in each jar. ( )

(v) Write the results of your observation and conclusion of your experiment ( )

(vi) Put the second grashopper in jar Y, and cover it with an air tight lid. ( )

(vii) Label one jar as X and another jar as Y. ( )

CamScanner

5. Carefully observe the following picture then answer the items (a)-(f) by writing the correct answers in the spaces provided

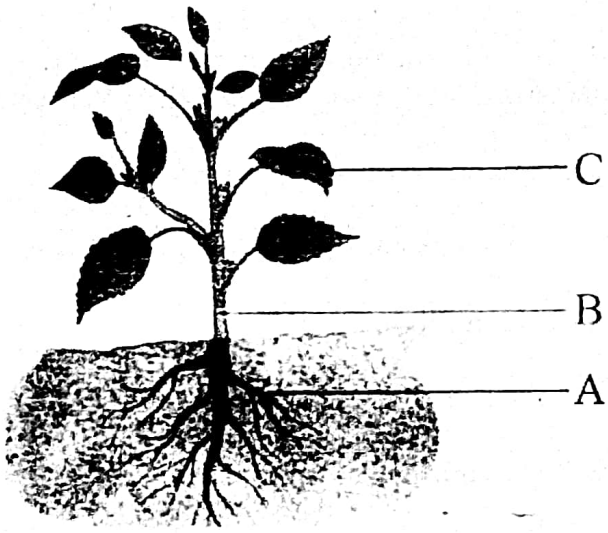

Questions

(a) What is the name of the part of the plant marked A?

_____

(b) What is the name of the part marked B?

_____

(c) Name the part of the plant marked C

_____

(d) What is the function of the part of the plant labeled C?

_____

(e) Mention one example of the plant that stores food in the part labeled B

_____

(f) Mention one example of the plant that stores food in the part indicated by letter A

_____

6. (a) Mention two main types of diseases

(i) _____

(ii) _____

(b) Why is it important to sleep under mosquito nets?

_____

_____

CamScanner

*Name of the School*_____

*Name of the Pupil*_____

*Pupil's Assessment Number*_____

*Region*_____

*Council*_____

KEYS EDUCATIONAL AND STATIONERY SERVICES (KESS)
REGISTRATION NUMBER: 473801

E- mail: keyseducationalservices@gmail.com
Phone No: 0758587618/0679587618
KIFURU-KINYEREZI, DAR ES SALAAM

STANDARD FOUR FIRST JOINT ASSESSMENT

S09E **ENGLISH LANGUAGE**

Time: 1:30 Hour **Thursday 23rd April 2026**

Instructions

1. This paper consists of sections **A**, **B** and **C** with a total of **six (6)** questions.
2. Answer **all** questions.
3. All answers must be written in the spaces provided in each question.
4. All answers must be written in **blue** or **black** ink.
5. Communication devices and any unauthorized materials are **not** allowed in the assessment room.
6. Write your **Name, Assessment Number, Region** and **Council** in the spaces provided at the top right corner of every page.

FOR ASSESSORS USE ONLY		
QUESTION NUMBER	**SCORE**	**ASSESSOR'S INITIALS**
1.		
2.		
3.		
4.		
5.		
6.		
TOTAL		
ENTERER'S INITIALS		
CHECKER'S INITIALS		

CamScanner

SECTION A (30 Marks)

Answer **all** questions in this section.

1. Listen carefully to the sentences read in item (i) - (v) and then write them in the spaces provided.

(i) _____

(ii) _____

(iii) _____

(iv) _____

(v) _____

2. Choose the correct answer in item (i) – (x) and write its letter in the box provided.

(i) James and his sister _____ their parents to do some house chores now.
A. helps
B. are helping
C. helped
D. help

(ii) Mr. Majukumu _____ milk to the villagers every day.
A. supply
B. supplying
C. supplies
D. supplyes

(iii) Standard Four pupils are in the class. _____ are learning English language.
A. She
B. You
C. They
D. Them

(iv) Observe the picture below then answer the questions that follows:



The girl is _____ the door
A. on
B. at
C. over
D. in

(v) The cows will be taken back to the cowshed later _____ they should be given some treatment by the veterinarian.
A. So
B. but
C. because
D. and

(vi) Mr. Limo _____ two cars and one house.
A. have
B. has
C. are
D. was

(vii) Anna takes care of the sick people at Mwanzo mzuri dispensary. Who is Anna?
A. Laboratory technician
B. Doctor
C. Receptionist
D. Nurse

CamScanner

(viii) She usually goes to the _____to buy medicine when she is sick.
A. laboratory
B. clinic
C. library
D. pharmacy

(ix) The goods in the supermarket are attached with _____ to help customers know the price.
A. bill
B. menu
C. price lists
D. price tags

(x) I don't have _____time to stay here.
A. much
B. many
C. little
D. a lot

2. Fill in the item (i) (v) with the correct word provided in the brackets to make the sentences meaningful.

(i) The Geography and Environment subject teacher told his pupils that the _____(sea/see) is among the water bodies.

(ii) He bought two _____ (pairs/pears) of shoes for his trip to Dodoma.

(iii) The conductor asked the passengers to pay_____(fair/fare) before getting into the bus.

(iv) All the pupils in the class _____(were/where) very happy with the results.

(v) Last _____(weak/week)Standard Four Pupils visited Serengeti National Park

SECTION B (10 Marks)

Answer **all** questions in this section.

3. Write the correct word for the jumbled letters in the brackets of the following sentences in the spaces provided.

(i) I was told to wash all the _____ (slatep)and cups before lunch

(ii) Mabala is weeding the flowers by using a _____(eho) in the garden

(iii) The pupils were cleaning their classroom using_____(smboor)

4. Read the following text carefully then write the correct form of the verb in the brackets in the spaces provided.

Lisa and Lucas were (i)_____(live) with their parents in Korogwe town. One day, they (ii)_____(travel) to Mombo village. They (iii)_____(go) there to visit their grandparents. That day, Lisa and Lucas (iv) _____(wake) up very early in the morning. They were supposed to board a bus. They reported at the bus stand at 6:30 in the morning.

CamScanner

SECTION C (10 Marks)

Answer question **six (6)**

5. Read the following passage carefully and answer questions (i) - (v) by writing the answers in the spaces provided.

Last month, Standard Four pupils at Mabo Primary School had a class meeting. The meeting took place in the Mkulima hall near the school library. There were no enough chairs and tables inside the hall. Some pupils went outside the hall to get more chairs and tables. Hall attendants were busy supplying mineral water to the pupils. They put two bottles of water on each table. They also put small waste bins under each table. The meeting started a bit late at around 3 p.m. some pupils had started jumping over the desks. The Standard Four class teacher had another meeting in the head teacher's office. When she arrived, she greeted the pupils and apologised for coming late. She then declared the meeting open.

Questions

(i) When was the meeting held?

_____

(ii) Why did some pupils go outside the hall to get more chairs and tables?

_____

(iii) Who declared the meeting open?

_____

(iv) Who supplied the mineral water and small waste bins in the hall?

_____

(v) At what time did the meeting start?

_____

CamScanner

KESS DICTATION-2026

(i) Today I am busy.

(ii) He knows to sing.

(iii) The bell is ringing.

(iv) What happened to you?

(v) She likes playing netball.

KESS DICTATION-2026

(i) Today I am busy.

(ii) He knows to sing.

(iii) The bell is ringing.

(iv) What happened to you?

(v) She likes playing netball.

CamScanner

*Name of the School*_____
*Name of the Pupil*_____
*Pupil's Assessment Number*_____
*Region*_____
*Council*_____

KEYS EDUCATIONAL AND STATIONERY SERVICES (KESS)
REGISTRATION NUMBER: 473801

E- mail: keyseducationalservices@gmail.com
Website: www.kess.co.tz
Phone No: 0758587618/0679587618
KIFURU-KINYEREZI, DAR ES SALAAM

STANDARD FOUR FIRST JOINT ASSESSMENT
A06E GEOGRAPHY AND ENVIRONMENT: ARTS AND SPORTS

Time: 1:30 Hour **Friday 24th April 2026**

Instructions

1. This paper consists of sections A and B with a total of **eight (8)** questions.
2. Answer **all** questions in each section.
3. All answers must be written in the spaces provided in each question.
4. All answers must be written in **blue** or **black** ink.
5. Communication devices and any unauthorized materials are **not** allowed in the assessment room.
6. Write your **Name, Assessment Number, Region** and **Council** in the spaces provided at the top right corner of every page.

FOR ASSESSORS USE ONLY		
QUESTION NUMBER	SCORE	ASSESSOR'S INITIALS
1.		
2.		
3.		
4.		
5.		
6.		
7.		
8.		
TOTAL		
ENTERER'S INITIALS		
CHECKER'S INITIALS		

CamScanner

SECTION A: GEOGRAPHY AND ENVIRONMENT (26 Marks)

Answer **all** questions in this section.

1. Answer items (i) – (vi) by choosing the **correct answer** and write its letter in the box provided.

(i) The following factors can cause changes of political maps, **except:**

A. Boundaries conflicts
B. Political agreements
C. Wars
D. Physical features

(ii) What is the source of air pollution?

A. Fishing by using seine nets
B. Cultivating crops water bodies
C. Smoke from industries
D. Defecating along the river

(iii) When you are locating or reading the intercardinal directions, which direction should you start with?

A. East or West
B. North or South
C. North or West
D. South or East

(iv) Which of the following characteristics distinguish a mountain from a hill?

A. Height and slopes
B. Shortness and abundance of snow
C. Rocks and soil
D. Height and soil fertility

(v) Kibona was reading the map of Tanzania but he failed to know where the information present in the map was obtained from. Which essential was that map missing?

A. Scale
B. Grid lines
C. Source
D. Key

(vi) Mr. Soboko is a person who measures land to help in deciding where things like buildings and roads should be placed. Who is Mr. Soboko?

A. Surveyor
B. Cartographer
C. Engineer
D. Tourist

2. Answer item (a) – (d) by choosing the correct answer from the box and write it in the space provided.

North,	South,	East,	West,	Southeast,	Eastsouth

(a) In which direction does the sun rise?

_____

(b) When you are facing the side where the sun rises, which cardinal direction will be to your right side? _____

(c) Which direction does a compass arrow usually point?

_____

(d) What direction is between is between South and East?

_____

3. (a). Mention two regions in Tanzania which are found in the Southern highlands plateau

(i) _____

(ii) _____

(b). Write one advantage of valleys

_____

CamScanner

4. Study the following picture and then answer the questions (a) – (d) by writing the correct answer in the space provided.



(a) What are the pupils seen in this picture doing?

_____

(b) Name the tools used by the pupils in the picture above to the dig holes

_____

(c) Which practice done by the pupils in the picture above shows caring for the seedlings?

_____

(d) What would you advise the pupils to do in order to improve fertility of the soil?

_____

SECTION B: ARTS AND SPORTS (24 Marks)

Answer all questions in this section

5. Answer items (i) – (iv) by choosing a letter of the correct answer and write in the box provided.

(i). How can singing help a person to earn income?

A. By selling a song
B. By using musical instruments
C. By comforting people
D. By listening to a music

(ii). What is the best method for modeling water jars?

A. Coiling method
B. Slab method
C. Pinching method
D. Mixed method

(iii). In order to make a stick figure seen as meaningful, you should consider some steps. What is the first step in drawing stick figure?

A. To prepare a piece of paper and a sharp pencil
B. To select or imagine the shape you want to draw
C. To start drawing stick figure by making faint lines
D. To remove unwanted lines by using an eraser

CamScanner

(iv) Which emotions are expressed by an actor or actress who stands upright with his or her chest forward?

A. Courage, confidence and authority
B. Fear, anger and anxiety
C. Shame, guilt and weakness
D. Surprise, disbelief and fear

6. Answer items (i) – (v) by choosing the correct answer from the box and write it in the space provided.

Rede,	Tower building,	Netball,	Gestures,	Balance,	Acrobatics,	Bao

(i) The ability to keep the body steady with an equal amount of weight on each side

_____

(ii) What is the name of the traditional ball game played using hands?

_____

(iii) What is the name of a dice game played by two people on dug holes in compliance with its rules and regulations?_____

(iv) What is the name of a type of game or activity that involves displaying physical skills, bravery, and various exercises performed in front of an audience?

_____

(v) What is the name of a physical exercise in which players work together to create different shapes using their bodies?_____

7. (a). Standard Three Pupils sang the National Anthem in the first voice only. What is this type of singing called? . _____

(b). Why is it important to dry the clay modeled objects?

_____

8. Study the following picture carefully then answer items (a) , (b) and (c) by writing the correct answer in the space provided.



(a) What is the name of the traditional game shown by this picture?

_____

(b) What is the importance of playing this traditional game?

_____

(c) Name the materials used in playing the game shown by the picture above_____

CamScanner

*Jina la Shule*_____

*Jina la Mwanafunzi*_____

*Namba ya Upimaji*_____

*Mkoa*_____

*Halmashauri*_____

KEYS EDUCATIONAL AND STATIONERY SERVICES (KESS)

NAMBA YA USAJILI: 473801

Barua pepe: keyseducationalservices@gmail.com

Simu: 0758587618/0679587618

KIFURU-KINYEREZI, DAR ES SALAAM

UPIMAJI WA KWANZA WA UTAMILIFU DARASA LA NNE

01: KISWAHILI

Muda: Saa 1:00 **Ijumaa 24 Aprili, 2026**

Maelekezo

1. Mtihani huu una sehemu **A, B,** na **C,** zenye jumla ya maswali **matano (5)**
2. Jibu maswali **yote** katika kila sehemu
3. Andika majibu **yote** kwenye nafasi zilizoachwa wazi au katika kisanduku.
4. Andika majibu **yote** kwa kutumia kalamu ya wino wa **buluu** au **mweusi.**
5. Vifaa vya mawasiliano na vitu vingine visivyoruhusiwa **havitakiwi** katika chumba cha upimaji.
6. Andika kwa usahihi **Jina lako, namba ya upimaji, mkoa** na **Halmashauri** sehemu ya juu kulia katika kila ukurasa

KWA MATUMIZI YA MPIMAJI TU		
NAMBA YA SWALI	**ALAMA**	**JINA LA MPIMAJI**
1.		
2.		
3.		
4.		
5.		
JUMLA		
SAINI YA MHAKIKI		

CamScanner

SEHEMU A (Alama 20)

Jibu maswali **yote** katika sehemu hii

1. Sikiliza kwa makini sentensi utakazosomewa kisha uziandike kwa usahihi katika nafasi zilizoachwa wazi.

   (i)_____

   (ii)_____

   (iii)_____

   (iv)_____

   (v)_____

2. Katika kipengele cha (i) – (x) chagua jibu sahihi, kisha andika herufi ya jibu hilo katika kisanduku ulichopewa.

   (i)Kabla Majuto hajafariki aliwaita watoto wake wote na kuwaambia maneno ya mwisho. Nahau ipi ina maana sawa na kitendo kilichofanywa na Majuto?

   A. Aga dunia
   B. Toa wosia
   C. Asi ukapera
   D. Mwaga unga

   (ii)Baba yangu hujenga nyumba kwa kutumia matofali na mawe. Je, baba yangu ni nani?

   A. Mhunzi
   B. Mwashi
   C. Fundi
   D. Mjenzi

   (iii)'Kiseki huendesha gari kwa umakini'. Sentensi hii ikibadilishwa kuwa katika hali ya ukanushi itakuwaje?

   A. Kiseki haendeshi gari kwa umakini
   B. Kiseki haendeshagi gari kwa umakini
   C. Kiseki hataendesha gari kwa umakini
   D. Kiseki huwa haendeshi gari kwa umakini

   (iv)Sehemu ya ardhi iliyo katikati ya vilima au milima miwili au sehemu iliyo chini na inayopitiwa na mto huitwaje?

   A. Bwawa
   B. Ng'ambo
   C. Bonde
   D. Konde

   (v)Mwalimu Kato aliwaambia wanafunzi wote darasani watabasamu. Kinyume cha neno 'tabasamu' ni kipi?

   A. Cheka
   B. Nuna
   C. Lia
   D. Furahi

   (vi)Kamilisha methali ifuatayo: "Mla nawe hafi nawe ila _____"

   A. Mcheza nawe
   B. Mzaliwa nawe
   C. Mtumia nawe
   D. Marafiki zako

CamScanner

(vii)Kitendawili kipi huteguliwa na picha ifuatayo?



A. Ana miguu ya msumeno
B. Anabeba mishale kila anapokwenda
C. Anajua kuchora ingawa hajui anachokichora
D. Hunipa chakula kizuri lakini akichokozwa hutawanya watu

(viii)Nilikula chakula mgahawani. Wingi wa sentensi hii ni upi?

A. Tulikula chakula mgahawani
B. Tulikula vyakula migahawani
C. Tulikula vyakula mgahawani
D. Tulikula chakula migahawani

(ix)Kitendawili 'Wakikua mama yao huwatupa mbali kwa kishindo' huteguliwa kwa jibu lipi kati ya haya yafuatayo?

A. Mnyonyo
B. Mbegu
C. Mbaazi
D. Vifaranga

(x)Nilipofaulu mtihani nilipewa zawadi ya baiskeli na wazazi wangu. Sentensi hii ipo katika wakati gani?

A. Uliopo
B. Mtimilifu
C. Ujao
D. Uliopita

SEHEMU B (Alama 20)

Jibu maswali **yote** katika sehemu hii.

3. Andika maneno yenye maana sawa na maneno yafuatayo.

(i) Subiri = _____

(ii)Hifadhi = _____

(iii)Tamati = _____

(iv)Nyati = _____

(v)Dagaa = _____

CamScanner

4. Umepewa sentensi sita zilizochanganywa. Zipange katika mtiririko unaoleta maana ili kuunda kifungu cha habari kwa kuzipa herufi A, B, C, D, na E katika nafasi zilizoachwa wazi. Sentensi ya (vi) imetumika kama mfano.

(i)Nilitoka chumbani haraka na kwenda kuipokea. ( )

(ii)Ghafla nikasikia simu ya mezani iliyokuwa sebuleni ikiita. ( )

(iii)Alinieleza kwamba alihitaji kuzungumza na mama yangu. ( )

(iv)Baada ya kuipokea nikaongea na shangazi yangu Mwanaidi ( )

(v)Siku moja nilikuwa chumbani kwangu nikijisomea ( )

(vi)Nikatoka nje na kumpelekea mama simu ili aweze kuzungumza na shangazi. (F)

SEHEMU C: (Alama 10)

Jibu swali la **tano (5)**

5. Soma kwa makini habari ifuatayo, kisha jibu maswali yanayofuata kwa **kuandika jibu lililo sahihi** katika nafasi iliyoachwa wazi.

Konile anaishi na mama yake katika Kijiji cha Kiuna. Anasoma katika Shule ya Msingi Temao iliyopo Wilaya ya Kasulu, Mkoani Kigoma. Wakati wa likizo Konile alimsaidia mama yake kufanya shughuli mbali mbali. Alimsaidia kazi za shambani pamoja na za nyumbani. Muda wa likizo ulipokaribia kuisha, mama yake aliugua na kulazwa hospitalini. Kwa kuwa hali yake ilikuwa mbaya, aliwekwa chini ya uangalizi maalumu wa daktari. Daktari alishauri awepo mtu wa kukaa na mgonjwa. Konile na mama yake walikuwa peke yao. Hivyo, Konile alimwambia daktari kuwa yuko tayari kumwangalia mgonjwa. Konile alianza kumuuguza mama yake mpaka alipopona.

Maswali

(i) Konile ni mwanafunzi wa shule gani?

_____

(ii) Wilaya ya Kasulu ipo katika mkoa gani?

_____

(iii) Ni nani alitoa ushauri wa uwepo wa mtu wa kukaa na mgonjwa?

_____

(iv) Unadhani ni kazi gani moja ya shambani Konile aliyokuwa akimsaidia mama yake?

_____

(v) Neno ugua kama lilivyotumika katika habari uliyosoma lina maana sawa na neno lipi jingine?_____

CamScanner

*Name of the Pupil*_____
*Pupil's Assessment Number*_____
*Region*_____
*Council*_____

KEYS EDUCATIONAL AND STATIONERY SERVICES (KESS)
REGISTRATION NUMBER: 473801

E- mail: keyseducationalservices@gmail.com
Phone No: 0758587618/0679587618
KIFURU-KINYEREZI, DAR ES SALAAM

STANDARD FOUR FIRST JOINT ASSESSMENT

M08E **MATHEMATICS**

Time: 1:30 Hour **Friday 24th April 2025**

Instructions

1. This paper consists of sections A and B with a total of **six (6)** questions.
2. Answer all questions in each section.
3. All answers must be written in the working space provided for each question.
4. All answers must be written with **black** or **blue** ink pen.
5. Communication devices, calculators and any unauthorized materials are **not** allowed in the assessment room.
6. Write your **Name, Assessment Number, Region** and **Council** at the top right hand corner of every page.

FOR ASSESSORS USE ONLY		
QUESTION NUMBER	SCORE	ASSESSOR'S INITIALS
1.		
2.		
3.		
4.		
5.		
6.		
TOTAL		
ENTERER'S INITIALS		
CHECKER'S INITIALS		

CamScanner

SECTION A (36 Marks)
MATHEMATICAL OPERATIONS

For question 1 – 4, work out the answer in the working space provided.

No	Question	Working and Answer space
1. a).	602 + 286 =	
(b).	Write the number represented by the following abacus 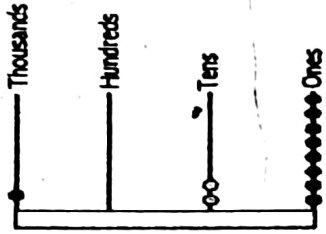	
(c).	Write 5000 + 0 + 20 + 3 in short form	
(d).	Fill the missing number in the following sequence: 45, 41, 37, 33, _____	
(e).	In the baskets there are 321 mangoes and 312 oranges. Use the symbol <,> or = to compare the number of mangoes with the number of oranges in the basket.	
(f).	Muungano primary school has 1022 pupils and Mapinduzi primary school has 1008 pupils. How many pupils are there in both schools?	
2. (a)	Write the fraction of the shaded part in the figure below 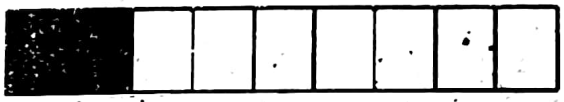	
(b).	$\frac{5}{12} + \frac{4}{12} =$	
(c).	$\frac{25}{30} - \frac{15}{30} =$	

CamScanner

(d).	Use the symbols <, > or = to compare $\frac{2}{4}$ and $\frac{4}{8}$	
(e).	Musa has twenty bananas. He wants to distribute the bananas to his four children equally. What fraction of all the bananas will each child get?	
3. (a)	Write 320 shillings in words	
(b)	Shs 4480 - Shs 2120 _____	
(c)	Lilian had 550 shillings. She was given 150 shillings by her mother. How much shillings does she have in total?	
4. (a)	How many days are there in two weeks?	
(b)	Add, Hours minutes 4 25 + 2 30 _____	
(c)	Write 0245hours in the 12-hour format	
(d)	Write the time shown by the following clock face 	

CamScanner

SECTION B (14 Marks)
MEASUREMENTS AND FIGURES

For question 5 and 6, work out the answer in the working space provided.

5. (a)	A cow produces 20 litres of milk everyday. How many litres of milk will it produce in two days?	
(b)	Eliza walked a distance of 3200 metres and Selina walked a distance of 2 kilometres and 800 metres. Who walked longer distance?	
(c)	Thadei bought 5 kilograms of rice. How many grams of rice did he buy?	
6. (a)	Write the name of the following figure: 	
(b)	Write the number of line segments in the following straight line 	
(c)	Find the area of the following triangle 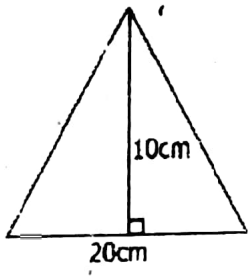	
(d)	A rectangle has a length of 15cm and a width of 10cm. Find its perimeter	

CamScanner