Candidate's Number: _____

School's Name: _____

THE UNITED REPUBLIC OF TANZANIA

PRIME MINISTER'S OFFICE

REGIONAL ADMINISTRATION AND LOCAL GOVERNMENT

KIBAHA MUNICIPAL COUNCIL

MOCK EXAMINATION FOR STANDARD VII

03E SOCIAL STUDIES AND VOCATIONAL SKILLS

Time: 1:30 Hours **April, 2026**

INSTRUCTIONS

1. This paper consists of section **A, B** and **C** with a total of **seven (7)** questions.
2. Answer **all** questions in the space provided in this paper.
3. Section A and B carry **twenty (20)** marks each and section C carries **ten (10)** marks.
4. All writings must be in **blue** or **black** ink pen, except drawings which must be in pencil.
5. Communication devices and any unauthorized material **are not allowed** in the examination room.
6. Write **your Examination Number and Name of your School** at the top right corner of every page.

FOR EXAMINER'S USE ONLY		
QUESTION NUMBER	**SCORES**	**EXAMINER'S INITIALS**
1		
2		
3		
4		
5		
6		
7		
TOTAL		
CHECKER'S INITIALS		

Candidate's Number: _____

School's Name: _____

SECTION A: (20 Marks)

Answer **all** question in this section.

1. For each items (i) – (xv) **choose the letter of the correct answer** and write it in space provided.

i). In Tanzania there are more than 120 ethnic groups and each ethnic group has its own traditional dance that identifies and differentiate it from other tribes. What is the traditional dance of Haya tribe? _____ [ ]
(a) Mbeta (b) Lizombe (c) Akasimbo (d) Sindimba (e) Mdumange.

ii). Every community in Tanzania has its own traditional games depending on the place, time and tradition. Which of the following are examples of such games? [ ]
(a) Football, boxing and jogging (b) Football, netball and swimming
(c) Jogging, swimming and football (d) Basketball, football and netball
(e) Spear throwing, rope skipping and jogging.

iii). Khairu-deen loves his nation, he has spirit of working for the nation and protects the natural resources of his country. Which character does he possess for his nation?
(a) Protector of national resources [ ]
(b) Protector of the society safety (c) Supervisor of citizen's safety
(d) Patriotic to his nation (e) Preservationist of society's taboos.

iv). There are various methods which African countries used during struggling for the independence. Which method was used by Egypt and Zanzibar? _____ [ ]
(a) Constitution (b) Negotiation (c) Revolution (d) Cooperation (e) War fare.

v). Climate is an average weather condition of a place observed and recorded over a long period of time, normally 30years or more. Which among of the following is not a factor that affect the climate of Tanzania? _____ [ ]
(a) Latitudes (b) Agriculture (c) Altitude (d) Natural vegetation (e) Wind.

vi). Madam Naina taught her grade six pupils about the management of international relation between countries by using diplomats or representatives abroad. What does this statement refer to _____ [ ]
(a) Diplomacy (b) Policy (c) Economic diplomacy (d) Political (e) Law.

vii). Mozambique fought for independence from Portugal for a long period of time. What was the main reason for this struggle? _____ [ ]
(a) To end colonial rule and gain independence (b) To get new Portuguese leaders
(c) To increase Portugal's business activities (d) To build railways and roads
(e) To strengthen the colonists' religion

viii). What is the decrease of temperature for every 100metres above the sea level?
(a) 0.08^0C (b) 0.6^0C (c) 37^0C (d) -0.16^0C (e) 27^0C [ ]

ix). In which Stone Age did man discover fire? _____ [ ]
(a) Middle Stone Age (b) Late Stone Age
(c) Early Stone Age (d) Primitive Communalism (e) Iron Age.

x). Which among the following is not a challenge facing entrepreneurs in Tanzania?
(a) Lack of raw materials (b) Unreliable markets (c) Shortage of capital
(d) Absence of bureaucracy (e) Less demand of goods. [ ]

xi). A clan is a group of people who come from the same ancestor or are related by blood. A family made up of a mother, father and their children is known as: [ ]
(a) Adoptive family (b) Nuclear family
(c) Single parent family (d) Couple family (e) Orphan family.

Candidate's Number: _____

School's Name: _____

xii). Singing is an artistic skill in which the singer depicts life of a human being in his or her environment. How many types of singing are there? _____ [ ]
(a) Four (b) Two (c) Three (d) Five (e) Six.

xiii). An entrepreneur is someone who starts a new business or arranges business in order to generate income often in a way that involves financial risk. The following are characteristics of an entrepreneur except._____ [ ]
(a) He or she can set big target (b) He or she does not despair
(c) He or she is creative and innovative (d) He or she has daring mind
(e) He or she is not faithful.

xiv). During menstruation period girls need to consider personal hygiene by using clean and appropriate tools to avoid getting infections such as _____ [ ]
(a) Syphillis (b) Gonorhoea (c) Fungus (d) Tuberclosis (e) Malaria.

xv). Which among the following method is not the best for preparing packed meals?
(a) Grilling (b) Roasting (c) Frying (d) Boiling (e) Baking. [ ]

2. Match the items in List A with those in List B by writing the letter of the correct answer in the spaces provided.

LIST A	ANSWERS	LIST B
i). Permanent Settlements and animal husbandry	[ ]	A. Bipedalism B. Neolithic Age C. Homo erectus D. Middle Stone Age E. Dog F. Darwinism theory
ii). The scientific stage that a man discovered fire	[ ]	
iii). Walked upright	[ ]	
iv). The first animal to be domesticated	[ ]	
v). Walking with limbs	[ ]	

SECTION B: (20 Marks)

Answer **all** question in this section.

3. Fill in the blanks with correct answer
   i). Rashid with his wife and his biological children and other relatives. What type of family is that? _____
   ii). Ashfaina was told to find the ground distance, if the distance from the Manyoni to Engaruka is 20cm and the map scale is 1:150,000. How did she respond to that question? _____
   _____
   iii). The temperature of Tanga region is 37^0C which is located at the seal level. What will be the altitude of Arusha town whose temperature is 25^0C.?
   _____
   _____

4. i). Identify two criteria used to classify entrepreneurs into various group
   a) _____
   b) _____

Candidate's Number: _____

School's Name: _____

ii). Which geographical phenomena occurs when the moon passes between the sun and the moon _____

iii). In which year did the Germans built the central railway from Dar es Salaam to Kigoma _____

5. i). Explain two natural causes of Tsunami

a) _____

b) _____

ii). When did the following countries join the East Africa Community (EAC)

a) Rwanda: _____

b) Burundi: _____

6. i). Nelson Mandela was sentenced to life imprisonment for almost twenty seven years in South Africa from 1964 to 1990. Why was he imprisoned for those year?

_____

_____

ii). What are the key functions of the following essential element of a map

a) Key _____

b) Scale _____

SECTION C: (10 MARKS)

Answer **all** question in this section.

7. Observe and study the following picture (diagram) and then answer the questions that follow:



i). In which era did the above activity take place? _____

ii). How do we call the people who engage in that activities?

_____

iii). That era took place between _____ years BCE and continues to this day

iv). Mention two uses of the tools made during that era

a) _____

b) _____

v). Outline two tools made during that era or period

a) _____

b) _____

Candidate's Number: _____

School's Name: _____

THE UNITED REPUBLIC OF TANZANIA

PRIME MINISTER'S OFFICE

REGIONAL ADMINISTRATION AND LOCAL GOVERNMENT

KIBAHA MUNICIPAL COUNCIL

MOCK EXAMINATION FOR STANDARD VII

05E

SCIENCE AND TECHNOLOGY

Time: 1:30 Hours **April, 2026**

INSTRUCTIONS

1. This paper consists of section **A, B** and **C** with a total of **eight (8)** questions.
2. Answer **all** questions in the space provided in this paper.
3. Section A and B carry **twenty (20)** marks each and section C carries **ten (10)** marks.
4. All writings must be in **blue** or **black** ink pen, except drawings which must be in pencil.
5. Communication devices and any unauthorized material **are not allowed** in the examination room.
6. Write **your Examination Number and Name of your School** at the top right corner of every page.

FOR EXAMINER'S USE ONLY		
QUESTION NUMBER	**SCORES**	**EXAMINER'S INITIALS**
1		
2		
3		
4		
5		
6		
7		
8		
TOTAL		
CHECKER'S INITIALS		

Candidate's Number: _____

School's Name: _____

SECTION A: (20 Marks)

Answer **all** question in this section.

1. Answer item (i) – (x) by **choosing the letter of the correct answer** and write it in bracket

i) Safety signs provide instructions for protection of living organisms in the environment. Which of the following colours does mandatory sign has? [ ]
(a) Blue (b) Green (c) Black (d) Yellow (e) Red

ii) Before medical professional take over. What is the importance of the help given to a patient? _____ [ ]
(a) Facilitate bleeding (b) Increase wound
(c) Reduce pain (d) Increase consciousness (e) It leads to loss of life

iii) The type of soil which is suitable for agriculture on growing crops in the environment is known as _____ [ ]
(a) Clay soil (b) Loan soil
(c) Sandy soil (d) Salt soil (e) Clay and Salt soil

iv) Class five B is extinguished by using Carbon dioxide gas and dry powder, which material are easily to be burnt with class B fire? _____ [ ]
(a) Diesel and kerosene (b) Paper and plastics
(c) Petrol and wood (d) Butane and propane (e) Iron and Oil

v) Air is a mixture of different gases. Which gas has a low contribution among the following in the atmosphere? _____ [ ]
(a) Nitrogen (b) Carbon dioxide (c) Oxygen (d) Argon (e) Hydrogen

vi) The disorder caused by prolonged fasting, stress and eating contaminated food is known as _____ [ ]
(a) Indigestion (b) Heartburn
(c) Stomach ulcers (d) Constipation (e) Schistomiasis

vii) Which the following is not the function of a magnet? _____ [ ]
(a) To produce electricity (b) To make speakers (c) To show direction
(d) To make magnetic field (e) To detect the movement of object

viii) The process by which plants absorbs water through their roots from the soil is known as _____ [ ]
(a) Evaporation (b) Osmosis (c) Diffusion (d) Photosynthesis (e) Transpiration

ix) Which of the following things are needs for the maize seed to germinate? [ ]
(a) Oxygen, Warmth and Water
(b) Oxygen, Light and Water (c) Soil, Oxygen and Water
(d) Air, Carbon dioxide and Water (e) Soil, Water and Manure

x) Which of the following electrical symbol represents socket _____ [ ]

(a)  (b) 

(c)  (d) 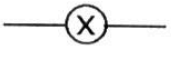 (e) 

2. Match the items in **LIST A** to that of **LIST B** to give correct meaning and write its letter in the brackets.

LIST A	ANSWERS	LIST B
i) Pulmonary artery	[ ]	A. Collect waste products from cells and maintains body temperature
ii) Veins	[ ]	

Candidate's Number: _____

School's Name: _____

iii) Plasma	[ ]	B. Connected to arteries in one side and veins in the other side
iv) Platelets	[ ]	C. Transports deoxygenated blood from the right ventricle to the lungs
v) Capillaries	[ ]	D. Carries blood to the heart E. Disorder of the blood circulatory system F. Prevent blood doting

3. Choose the most correct answer from the box given below then answer the questions below to the space provided

Effect of AIDS, Tuberculosis, Gonorrhea, Abstain from sex, symptom of syphilis, to increase body immunity, opportunistic, disease symptoms of AIDS

i) The importance of balance diet to people living with HIV and AIDS _____

ii) Family members spend a lot of time taking are of the patients _____

iii) The painless sore on the penis, vagina, tongue and anus _____

iv) The tactic of preventing sexually transmitted diseases _____

v) The diseases affecting the AIDS patients _____

SECTION B: (20 Marks)

Answer **all** question in this section.

4. For the items (i) — (iii), answer all question in the space provided.

i) Why is bicycles a complex Machine _____

ii) List down any two simple machines found in bicycle out of lever.

(a)_____ (b) _____

5. Answer the following questions

i) Explain how the low of flotation is used to construct a ship _____

_____

ii) If the density of an object is less than that of water. What will happen if you drop the object into water? _____

iii) If the object has the mass of 20g and volume of $10cm^3$, what will happen to it is dropped into water_____

6. Observe the diagram below then answer the questions

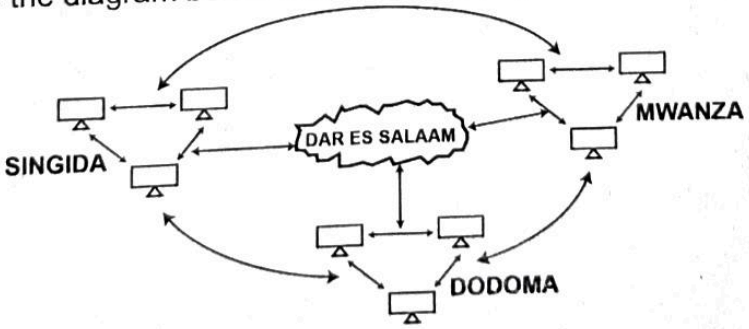

Candidate's Number: _____

School's Name: _____

i) What is the type of the computer network shown by the diagram above?

_____

ii) Write down the advantage of using the mentioned type of computer network

a) _____

b) _____

iii) Explain how the internet can be useful to students _____

iv) Write the effect of internet

a) _____

b) _____

SECTION C: (10 Marks)

Answer **all** question in this section

7. Observe the picture shown below then answer the questions (i) – (iii)

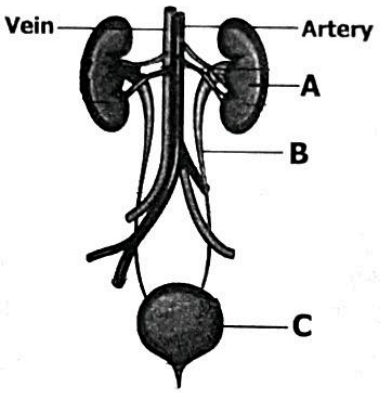

i). Which body system is represented by the diagram above?

_____

ii). What is the name of the part marked A? _____

iii). Write the function of the part mentioned in (ii) above

_____

8. i). State ohm's law

_____

ii). Find the current flowing through the wire if the resistance is 20hms and the voltage is 12 volts _____

_____

Candidate's Number: _____

School's Name: _____

THE UNITED REPUBLIC OF TANZANIA

PRIME MINISTER'S OFFICE

REGIONAL ADMINISTRATION AND LOCAL GOVERNMENT

KIBAHA MUNICIPAL COUNCIL

MOCK EXAMINATION FOR STANDARD VII

02

ENGLISH LANGUAGE

Time: 1:40 Hours **April, 2026**

INSTRUCTIONS

1. This paper consists of section **A, B** and **C** with a total of **seven (7)** questions.
2. Answer **all** questions in the space provided in this paper.
3. Section A and B carry **twenty (20)** marks each and section C carries **ten (10)** marks.
4. All writings must be in **blue** or **black** ink pen, except drawings which must be in pencil.
5. Communication devices and any unauthorized material **are not allowed** in the examination room.
6. Write **your Examination Number and Name of your School** at the top right corner of every page.

FOR EXAMINER'S USE ONLY		
QUESTION NUMBER	**SCORES**	**EXAMINER'S INITIALS**
1		
2		
3		
4		
5		
6		
7		
TOTAL		
CHECKER'S INITIALS		

Candidate's Number: _____

School's Name: _____

SECTION A: (20 Marks)

Answer **all** question in this section.

1. Listen carefully to the passage read by the invigilator and then answer item (i) – (v) correctly by **choosing the letter of the correct answer** and write it in the space provided.

   i). Why did viola carry her umbrella? _____ [ ]
   (a) Because she wanted to show it to Allen
   (b) Because the sky was dark and rainy
   (c) Because she forgot her raincoat
   (d) Because she like the color blue
   (e) Because she wanted to carry

   ii). Where did Viola leave her umbrella? _____ [ ]
   (a) In the classroom
   (b) At home
   (c) On the bus
   (d) In the library
   (e) At the playground

   iii). How did Viola feel when she could not find her umbrella? _____ [ ]
   (a) Angry (b) Sad
   (c) Excited (d) Surprised (e) Happy

   iv). Who returned the umbrella to Viola? _____ [ ]
   (a) Her teacher (b) Her mother (c) Her friend Allen
   (d) The bus drive (e) Her father

   v). According to the passage, was the umbrella found? _____ [ ]
   (a) Yes it was (b) Not it wasn't
   (c) Probably so (d) Obviously (e) I don't know

2. **For each of the items (i) – (v) Choose the correct answer** and write its letter in the space provided.

   i). They _____ football even Saturday [ ]
   (a) play (b) played
   (c) plays (d) playing (e) are playing

   ii). Choose the correct sentence _____ [ ]
   (a) He is eat lunch now
   (b) He eating lunch now
   (c) He is eating lunch now
   (d) He eats lunch now
   (e) He eat lunch now

   iii). The student _____ the head teacher praised was very happy [ ]
   (a) who (b) where
   (c) whose (d) which (e) whom

   iv). Among all the pupils Eliah has the _____ handwriting [ ]
   (a) bad (b) worse
   (c) worst (d) baddest (e) badder

   v). Anna does not listen to his parent, _____ she obey her teacher [ ]
   (a) nor (b) for
   (c) yet (d) but (e) and

Candidate's Number: _____

School's Name: _____

3. Complete the sentences (i) – (v) by filling in the blanks with the correct words choosen from the box.

Suffixes,	So,	Yet,	Prefixes,	In order,	when,	Then

i). I prefer gas to charcoal _____ gas is environmentally friendly

ii). He was still feeling sleeply _____ he managed to wake up

iii). They saved money _____ to by a new house.

iv). My friend formed another word after adding letters at the begging of the word. What do we call the letters added at the bagging?

v). Tanganyika had already developed _____ Mwalimu Kambarage Nyerere liberated her from the colonialist reign

4. Match the items provided in **List A** with those of **List B** by writing the letter of the correct answer in the space provided.

LIST A	ANSWERS	LIST B
i). Have disagreement over something	[ ]	A. Miserable. B. Ghost C. Terrible D. Pesticide E. Quarrel F. Fog G. Torture
ii). The soul or sprit of a dead person or animal which believed to appear to people	[ ]	
iii). Droplets of water vapour suspended in the air near the ground	[ ]	
iv). Extremely dangerous or bad	[ ]	
v). Substance that are ment to control pets	[ ]	

SECTION B: (20 Marks)

Answer **all** question in this section.

5. Fill in the blanks with the most correct answer.

i). The antonym of blunt is_____

ii). She works up early. (Write a question tag) _____

iii). We have (little) _____ water than yesterday

iv). The mangos are very sweet. I ate five of them (Join the sentences using so.....that)

_____

v). We will not fear. We will not cry. (Join the sentences using neither.....nor)

_____

Candidate's Number: _____

School's Name: _____

6. Read the following poem carefully and answer question (i – v)

Laziness begin in the mind
Hopelessness and regret are the signs
Being poor is sometimes a choice
Poverty and laziness are identical twins

Know who you want to be
Then work hard
To achieve the life you desire
Determination and hardwork are identical twins

Question

i). What is the poem about? _____

ii). Where does the laziness begin? _____

iii). What should you do to have the kind of life you desire_____

iv). How many verse does the poem have? _____

v). How many stanza does the poem have? _____

SECTION C: (10 Marks)

7. The following sentences are jumbled. Rearrange them in an iconological order to make a good composition by giving them letter A, B, C, D and E.

i). Farmer were happy because the rain watered their crops in the field [ ]

ii). Soon the rain stopped and the sun appeared brightly in the sky [ ]

iii). After the rain, the air was fresh and the sun appeared brightly in the sky [ ]

iv). The dark clouds gathered in the sky and the wind began to blow strongly. [ ]

v). Children ran quickly to their homes to avoid getting wet in the heaven rain [ ]

Namba ya Mtahiniwa: _____

Jina la Shule: _____

JAMHURI YA MUUNGANO WA TANZANIA

OFISI YA WAZIRI MKUU

TAWALA ZA MIKOA NA SERIKALI ZA MITAA

HALMASHAURI YA MANISPAA YA KIBAHA

MTIHANI WA UTAMILIFU (MOCK) DARASA LA SABA

01 KISWAHILI

Muda: Saa 1:40 **Aprili, 2026**

MAELEKEZO

1. Karatasi hii ina sehemu **A, B** na **C** zenye jumla ya maswali **sita** (**6**).
2. Jibu maswali **yote** kwenye nafasi ulizopewa.
3. Sehemu A na B zina alama **ishirini (20)** kila moja na sehemu C ina alama **kumi (10)**.
4. Majibu yote yaandikwe kwa kalamu yenye wino wa **bluu** au **mweusi, isipokuwa** katika michoro ni lazima kutumia penseli.
5. Vifaa vya mawasiliano visivyoruhusiwa **havitakiwi** katika chumba cha mtihani.
6. Andika **Namba yako ya Mtihani na Jina la Shule yako** katika kila ukurasa sehemu ya juu upande wa kulia.

KWA MATUMIZI YA MTAHINI TU		
NAMBA YA SWALI	**ALAMA**	**SAHIHI YA MTAHINI**
1		
2		
3		
4		
5		
6		
JUMLA		
SAHIHI YA MHAKIKI		

Namba ya Mtahiniwa: _____

Jina la Shule: _____

SEHEMU A: (Alama 20)
UMAHIRI WA KUSIKILIZA SARUFI NA LUGHA YA KIFASIHI

1. Sikiliza kwa makini habari utakayosomewa kisha jibu maswali ya kipengele cha i–v kwa kuchagua herufi ya jibu sahihi na ujaze kwenye mabano uliyopewa.
   i. Ni kundi lipi la watu linatoka vijijini kwenda mjini? _____ [ ]
      (a) Wazee (b) Watoto
      (c) Kinamama (d) Kinababa (e) Vijana
   ii. Kitu gani kinawafanya watu kukimbilia mjini? _____ [ ]
      (a) kulima (b) kuona bahari
      (c) kusalimia ndugu (d) kufuata huduma bora (e) kukimbia askari
   iii. Tatizo kubwa lililoko vijijini ni _____ [ ]
      (a) Mashamba (b) Vyakula vingi
      (c) Usafiri mzuri (d) kukosekana kwa huduma bora (e) Wizi
   iv. Vijana wanaohama kutoka vijijini kwenda mijini huishi kwenye nini? _____ [ ]
      (a) kupata kazi (b) kuishi maisha ya kifahari
      (c) kujenga nyumba (d) kutalii (e) kutumia madawa ya kulevya
   v. Kwa nini vijana wengi wanaohamia mijini kutoka vijijini huishia maisha magumu? _____
      (a) kwa sababu huwa wanakosa ajira [ ]
      (b) kwa sababu huwa wanapata ajira (c) kwa sababu wanajenga nyumba
      (d) kwa sababu hawaagi (e) kwa sababu si wasikivu

2. Chagua herufi ya jibu sahihi kisha uandike herufi ya jibu hilo kwenye mabano uliyopewa.
   i. Maneno matamu yaliwafanya watu washawishike haraka. Neno matamu limetumika kama aina gani ya maneno? _____ [ ]
      (a) Kielezi (b) Kihisishi
      (c) Nomino (d) Kivumishi (e) Kiwakilishi
   ii. Tungeliwahi kuamka_____ usafiri kwa urahisi [ ]
      (a) tungelipata (b) tungepata (c) tukipata (d) tungalipata (e) tungepata
   iii. Magari mawili yamegongana juzi usiku. Sentensi hii iko katika hali gani? [ ]
      (a) Kutendewa (b) Kutendeana
      (c) Kutenda (d) Kutendeka (e) Kutendwa
   iv. Baada ya mwajuma kufiwa na mume wake, alipokea fedha kutoka kwa marafiki zake. Fedha alizopokea hujulikana kama _____ [ ]
      (a) Maombolezo (b) Tanzia
      (c) Msiba (d) Rambirambi (e) Pongezi
   v. Kiti kimepotea. Sentensi hii ipo katika ngeli ipi? _____ [ ]
      (a) LI – WA (b) A – WA (c) KI – VI (d) U – I (e) U – ZI
   vi. Subira anapika ugali jikoni. Hii ni aina gani ya sentensi _____ [ ]
      (a) Sahili (b) Ambatano
      (c) Shurutia (d) Changamano (e) Huria
   vii. Ninasoma darasa la saba. Katika kitenzi ninasoma kiambishi tamati ni ____ [ ]
      (a) -a (b) a- (c) Som- (d) nin- (e) ma-
   viii. Mgonjwa anakunywa dawa, Muundo sahihi wa sentensi hii ni _____ [ ]
      (a) N + T + N + V (b) N + T + V + N
      (c) N + T + N (d) N + V + N (e) W + N + N
   ix. Machota hakucheza na watu wa rika lake. Sentensi hii ipo katika hali gani? [ ]
      (a) Masharti (b) Mazoea
      (c) Uyakinifu (d) Ukanushi (e) Uliopo

Namba ya Mtahiniwa: _____

Jina la Shule: _____

x. Hatupaswi kuwaonea wenzetu gere au wivu kutokana na majaaliwa yao. Kila mtu amejaaliwa jaala yake. Maelezo haya yana maana sawa na methali ipi kati ya hizi?
(a) Baniani mbaya kiatu chake dawa [ ]
(b) mambo ni kangaja huenda yakaja
(c) Jumbe ni watu si kilemba
(d) Mjaaliwa ni mmoja kila mtu ana lake (e) mvuvi ndiye ajuaye pweza alipo

3. Oanisha maneno ya **Kifungu A** na **Kifungu B** ili kuleta mantiki kwa kuandika herufi ya jibu sahihi kwenye mabano uliyopewa.

Kifungu A	Jibu	Kifungu B
i. Maneno yenye maumbo sawa lakini maana tofauti	[ ]	A. Jini
ii. Mtima	[ ]	B. Kihisishi
iii. Hutumika kuonesha hisia	[ ]	C. Tembelea
iv. Zuru	[ ]	D. Visawe
v. Nomino	[ ]	E. Vitawe
		F. Dhahania
		G. Moyo

SEHEMU B: (Alama 20)

Jibu maswali **yote** katika sehemu hii

4. Jaza nafasi zilizoachwa wazi.
i. Kitendawili, "Tajiri wa rangi_____
ii. Kisawe cha neno "Tembo" _____
iii. Kaka amepata jiko, nini maana ya kupata jiko. _____
iv. Kaka wa mama yako huitwa _____
v. Mchanganyiko wa mboga unaoliwa bila kupikwa huitwa _____

5. Sentensi zifuatazo hazipo kwenye mpangilio sahihi, zipange ili kuleta mtiririko wenye mantiki kwa kuzipa herufi A, B, C, D, E kwenye nafasi uliyopewa
i. Moja ya kanuni hizo ni nidhamu [ ]
ii. Hawa watakaoongezea uwezo wa mbinu za mafanikio [ ]
iii. Hatimaye utafurahia mafanikio katika shughuli zako [ ]
iv. Mwanangu, nidhamu itakuwezesha kuketi na wakuu [ ]
v. Maisha yenye furaha na mafanikio yana kanuni zake [ ]

Namba ya Mtahiniwa: _____

Jina la Shule: _____

SEHEMU C: (Alama 10)

Jibu maswali **yote** katika sehemu hii

6. Soma kwa makini shairi lifuatalo kisha jibu maswali ya kipengele (i – v) kwa kujaza nafasi zilizoachwa wazi

Maneno bile hesabu, bado watu huandika
Nami nadhani karibu, siku njema itafika
Yawe katika vitabu, na vinywa kuyatamka
Titi la mama ni tamu, jingine haliishi hamu.

Maneno ya uthabiti, yasiyo na ukakasi
Mengi pia tofauti, kwa fasaha na wepesi
Yenye ladha ya sauti, bado kuona kamusi
Titi la mama ni tamu, jingine haliishi hamu

i. Shahiri hili ni la aina gani? _____

ii. Andika umoja wa neno vinywa kama lilivyotumika katika shairi _____

_____

iii. Mleo wa ubeti wa pili ni _____

iv. Utao wa ubeti wa kwanza mshororo wa mtoto ni _____

v. Kwa kuzingatia muundo, je hili ni shairi lililotumia muundo wa _____

_____

Candidate's Number: _____

School's Name: _____

THE UNITED REPUBLIC OF TANZANIA

PRIME MINISTER'S OFFICE

REGIONAL ADMINISTRATION AND LOCAL GOVERNMENT

KIBAHA MUNICIPAL COUNCIL

MOCK EXAMINATION FOR STANDARD VII

06E CIVIC AND MORAL EDUCATION

Time: 1:30 Hours **April, 2026**

INSTRUCTIONS

1. This paper consists of section **A, B** and **C** with a total of **six (6)** questions.
2. Answer **all** questions in the space provided in this paper.
3. Section A and B carry **twenty (20)** marks each and section C carries **ten (10)** marks.
4. All writings must be in **blue** or **black** ink pen, except drawings which must be in pencil.
5. Communication devices and any unauthorized material **are not allowed** in the examination room.
6. Write **your Examination Number and Name of your School** at the top right corner of every page.

FOR EXAMINER'S USE ONLY		
QUESTION NUMBER	SCORES	EXAMINER'S INITIALS
1		
2		
3		
4		
5		
6		
TOTAL		
CHECKER'S INITIALS		

Candidate's Number: _____

School's Name: _____

SECTION A: (20 Marks)

Answer **all** question in this section.

1. Answer the questions (i) – (x) **by choosing the letter of the correct answer** and write it in bracket

i). The government of the United Republic of Tanzania is made up three Organs, which are, Executive, Parliament and Judiciary. These organs works together to promote and protect human rights in Tanzania. Which of the following is not the function of the parliament of the United Republic of Tanzania _____ [ ]
(a) Discussing and signing treaties (b) Discussing the country's budget
(c) Enacting laws of the country (d) Approving the prime minister
(e) Punishing the law breakers according to the law

ii). The president of the united. Republic of Tanzania is elected by following different producers. Which one among the following is a procedure observed when electing Tanzanian president? _____ [ ]
(a) By being nominated by the president of Zanzibar
(b) By being nominated by the registered political party
(c) Being proposed by his or her family
(d) Being appointed by people of his or her constituency
(e) Being nominated by registrar of political parties

iii). Every national has to make sure that freedom and unity are protected. The following are the roles played by the government and citizens of Tanzania to protect freedom and Unity EXCEPT _____ [ ]
(a) Building good relationship with terrorist groups (b) Respecting human rights
(c) Building good relationship with other countries
(d) Respecting and obeying the law (e) Protecting borders from illegal immigrants

iv). It is responsibility of every citizen to help and comfort the needy in our society. What is the importance of helping and comforting the needy groups in the society?
(a) To promote love and respect (b) To promote dependence [ ]
(c) To avoid conflicts (d) To protect political rights (e) To be known

v). Which of the following is the most risky act that many cause explosion in our areas
(a) Careful use of stoves (b) Use of modern charcoal [ ]
(c) Lightening of stoves (d) Careful use of the electric appliances at home
(e) The use of clean energy stove

vi). The kind of knowledge given to the youth concerning their reproductive system issues that helps them to copy with their body changes as they get matured is known as _____ [ ]
(a) Reproductive health care
(b) Reproductive health education (c) Asexual reproductive system
(d) Sexually transmitted diseases (e) Puberty age education

vii). A leader is a person who leads and guide others to achieve the intended goals. A good leader must have the following qualities EXCEPT_____ [ ]
(a) Commitment (b) Truthfulness
(c) Confidence (d) Nepotism (e) Resilience

viii). The Civic and Moral education teacher listed the ways of motivating and maintaining peace in the society. Which among the following was not included? ____ [ ]
(a) Performing arts (b) Sports and games (c) Social Media
(d) Religious sermons (e) Riots and demonstration

Candidate's Number: _____

School's Name: _____

ix). The history of the East African Community can be traced back to the colonial period, it passed through various transformation to the current Newly East African Community which has eight members state. Which one among the following was the last country to join the community? _____ [ ]

(a) South Sudan (b) Uganda

(c) Democratic Republic of Congo (d) Burundi (e) Somalia

x). Which of the following is the way of building solidarity in the society? [ ]

(a) Respecting every person regardless of their age, Ideology or religion

(b) Choosing the rich and sound-minded friend's only

(c) Being lazy and hate those who hates you

(d) loving your relatives by favouring them and mistreating the people you do not know (e) Building enmity among people

2. Match the chapter of the constitution from **LIST A** with the corresponding letter from **LIST B** by writing the letter of the correct answer to the space given.

LIST A	ANSWERS	LIST B
i). Describe the legislature of the United Republic of Tanzania, Parliament, Members of constituencies and election of members procedures	[ ]	A. Chapter one B. Chapter three C. Chapter five D. Chapter two E. Chapter six F. Chapter eight G. Chapter four
ii). Focuses on dispensation of justice in the united republic of Tanzania and court system or judicial system of the country	[ ]	
iii). Describes the revolutionary government of Zanzibar and the president of Zanzibar	[ ]	
iv). Covers the United Republic, Political parties, people and policy of socialism and self-reliance.	[ ]	
v). Describes the executive of the United Republic, Power of the president, vice president and the power of the prime minister	[ ]	

3. For each item (i) – (v) fill the blanks space by choosing the correct words provided in the box below

Scene, Female Genital Mutilation (FGM), Good governance, Hypocrisy, Legal Aid, Dictatorship

i). The act that is frequently carried out by tradition practioners called "Ngaribar" which cause severe pain, breeding and even death to girl is known as _____

ii). Refers to the place that we live and everything surrounding us including features like Mountains, Forest and water bodies _____

iii). A form of government that draws its legitimacy from the people and functions for the people is known as _____

iv). The kind helps or assistance provided to people whose rights are denied or violated _____

v). Is a place where an event happened _____

Candidate's Number: _____

School's Name: _____

SECTION B: (20 Marks)

Answer **all** question in this section.

4. Complete the following table by identifying the components of the voluntary action plan by writing it on the space provided.

Description	Word
i). At the beginning of march my fellow pupils and I are planning to score A in all examination	
ii). Borrowing textbooks, To do weekly test, to read textbooks, to work on examination paper of the past year	
iii). To enhance good academic performance of standard seven pupils	
iv). Textbook, Reference books, Extra study time, computers and classroom	
v). Which pass mark has been scored by my fellow pupil's and I	

5. Write the correct answer in the space provided for items
   i). Mention two traditions and customs which are accepted in our societies
      a) _____
      b) _____
   ii). Ramadhani is 15 years old, for how long will he be able to vote for leaders he wants.
      _____
   iii). Mention two effects of environmental degradation
      a) _____
      b) _____
   iv). Mention two ways that can be used to report the acts of corruption in a country
      a) _____
      b) _____
   v). State two indicators of poor governance in a country
      a) _____ b) _____

SECTION C: (10 Marks)

Answer **all** questions in this section.

6. Study the picture below and then answer the questions that follow for item (i) – (v)

i).
ii).
RESIDENT MAGISTRATE COURT
iii).
PRIMARY COURT

   iv). Which court level is responsible to hear and judge the murder cases in Tanzania
      _____
   v). Who is overall in charge or leader of the above judicial system _____
      _____

Candidate's Number: _____

School's Name: _____

THE UNITED REPUBLIC OF TANZANIA

PRIME MINISTER'S OFFICE

REGIONAL ADMINISTRATION AND LOCAL GOVERNMENT

KIBAHA MUNICIPAL COUNCIL

MOCK EXAMINATION FOR STANDARD VII

04E. MATHEMATICS

Time: 2:00 Hours **April, 2026**

INSTRUCTIONS

1. This paper consists of section **A, B** and **C** with a total of **eight (8)** questions.
2. Answer **all** questions.
3. Show all your working in the spaces provided in this paper and be neat.
4. All writings must be in **blue** or **black** ink pen, except drawings which must be in pencil.
5. Communication devices and any unauthorized material **are not allowed** in the examination room.
6. Write **your Examination Number and Name of your School** at the top right corner of every page.

FOR EXAMINER'S USE ONLY		
QUESTION NUMBER	SCORES	EXAMINER'S INITIALS
1		
2		
3		
4		
5		
6		
7		
8		
TOTAL		
CHECKER'S INITIALS		

Candidate's Number: _____

School's Name: _____

SECTION A: (10 Marks)

In each item, answer all question in this section.

Calculate the following questions clearly showing the method used to find the correct answer in the space provided

No.	Question	Working space and Answer
1.	a) 94, 204 + 9,334 =	
	b) 10,000 – 8,888	
	c) 879 x 427=	
	d) $\frac{1}{5} + \frac{3}{4} =$	
	e) $\frac{3}{5} - \frac{1}{2} =$	
	f) $\frac{2}{7} \times \frac{3}{5} =$	
	g) $\frac{3}{4} \div \frac{1}{2} =$	
	h) 39.7 – 15.9 =	
	i) $3.51 \times 0.5 =$	
	j) $4.58 \div 0.02 =$	

SECTION B: (30 Marks)

Answer all question in this section.

No.	Question	Working space and Answer
2.	a) Write MMX in Arabic numerals	
	b) Write 98,000,023 in words	

Candidate's Number: _____

School's Name: _____

	c) Which one is greatest $\frac{1}{8}$ or $\frac{1}{2}$	
	d) Which digit in the number has the smallest total value in 76109	
	e) Arrange the following number in ascending order 1112, 1012, 1120, 2101, 2110	
	f) Write the missing number in the following sequence 64, 27, 8, _____	
3.	a) John bough 28 cables, each measuring 18.7 meters long. What is the total length of the cables?	
	b) Last year in Arusha District 345,730 children were registered to join class one, but 2320 children were absent. How many children were present?	
	c) James was record the total weight of two children weight 57.863kg. Round off the number to the nearest two decimal places	
4.	a) The age of five children, Halima, Janet, Imani, Pili and Ali are 2, 3, 8, 9 and 21, years respectively. What children whose age is a prime number?	
	b) Given a = 10, b = 5, find the value of (ab) – b	
	c) Find the value of (+5) + (-3) =	
5.	a) On 2nd January 2026 an entrepreneur sold a variety of fruits as follows: 50 mangoes @ sh 500 10 watermelon @ sh 2,000 20 Pineapples for 20,000/= How much money did the entrepreneur get?	
	b) Amina bought 4500 grams of meat. How many kilograms did she buy?	
	c) Find the LCM and GCF of 12, 16 and 20	

Candidate's Number: _____

School's Name: _____

6.	a) The standard six pupils were asked to list all the odd numbers between 60 and 70. How many odd numbers did they list	
	b) Malaika bought a shirt for Tsh 63,000 after a discount of 10% what was the price of shirt before the discount?	
	c) The age of the father is three times the age of his son. If the age of the father is 60 years now. Find the age of the son five years ago?	

SECTION C: (10 Marks)

Answer all question in this section.

No.	Question	Working space and Answer
7.	a) Find the volume of the rectangular prism below 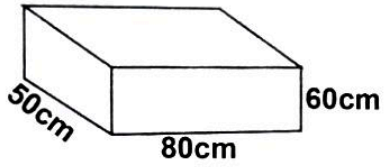	
	b) Find the area of the figure below 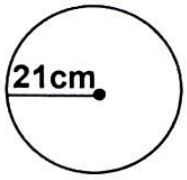	
	c) Find the value of angle shown by letter Y in the figure below 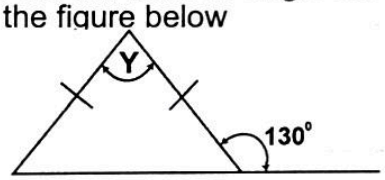	
8.	The salary of teacher Lucas is Tshs 420,000 per month use the pie-cart to:- 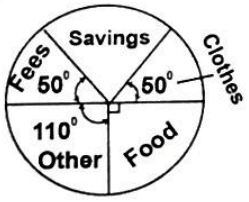	
	a) Find the amount he saves	
	b) What percentage of his salary does he spend on food?	

ENGLISH LANGUAGE

Listening skills

One rainy morning, Viola hurried to school, she carried her blue umbrella because the sky was dark. On the bus, she placed the umbrella beside her seat. When she reached school, she ran to class quickly.

Later, during break time, she looked for umbrella but it was gone!, Viola felt sad, After lunch, her friend Allen came smiling. He held the blue umbrella. "You forgot the on the bus", he said, Viola laughed with relief and thanked Allen

KISWAHILI

Ufahamu wa kusikiliza

Hivi karibuni kumetokea tatizo la vijana wengi kukimbilia mijini. Sababu kubwa ya vijana kukimbilia mijini ni kufuata huduma bora kwani vijijini maisha ni magumu, hakuna huduma nyingi za muhimu kukidhi mahitaji ya vijana. Hata hivyo vijana hawa wafikapo mijini hali huwa ngumu sana. Huwa hawapati ajira na matokeo yake huishia kuwa wezi, Malaya na kujihusisha na utumiaji wa dawa za kulevya.